Picture Graphs & Tally Charts · 1

How many votes did apples get?

Favorite	Votes
balls	8
balloons	2
apples	11
hearts	10

Picture Graphs & Tally Charts · 2

How many more balls than apples are in the graph?

Picture Graph: Our Favorites

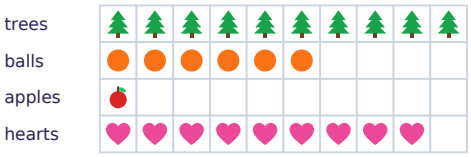

Picture Graphs & Tally Charts · 3

How many votes did balloons and hearts get in all?

Favorite	Votes
apples	3
balloons	9
balls	4
hearts	8

Picture Graphs & Tally Charts · 4

How many fewer gifts than apples are in the graph?

Picture Graph: Our Favorites



Picture Graphs & Tally Charts · 5

How many more votes did gifts get than trees?

Favorite	Votes
trees	3
gifts	5
balloons	7
stars	10

Picture Graphs & Tally Charts · 6

How many stars and balls are in the graph in all?

Picture Graph: Our Favorites



Picture Graphs & Tally Charts · 7

Which got the fewest votes: gifts, hearts, trees, or stars?

Favorite	Votes
gifts	2
stars	11
hearts	12
trees	8

Picture Graphs & Tally Charts · 8

How many fewer votes did balloons get than stars?

Favorite	Votes
balloons	3
hearts	11
balls	5
stars	4

Picture Graphs & Tally Charts · 2

ANSWER

5

Picture Graphs & Tally Charts · 1

ANSWER

11

Picture Graphs & Tally Charts · 4

ANSWER

3

Picture Graphs & Tally Charts · 3

ANSWER

17

Picture Graphs & Tally Charts · 6

ANSWER

16

Picture Graphs & Tally Charts · 5

ANSWER

2

Picture Graphs & Tally Charts · 8

ANSWER

1

Picture Graphs & Tally Charts · 7

ANSWER

gifts

How many more votes did gifts get than balls?

Favorite	Votes
apples	2
gifts	6
stars	4
balls	3

How many votes did apples and gifts get in all?

Favorite	Votes
trees	8
apples	9
hearts	4
gifts	6

How many fewer balloons than gifts are in the graph?

Picture Graph: Our Favorites

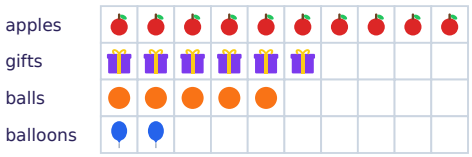

How many votes did stars get?

Favorite	Votes
gifts	12
trees	4
stars	8
balloons	7

How many hearts and apples are in the graph in all?

Picture Graph: Our Favorites



How many fewer votes did hearts get than balls?

Favorite	Votes
apples	2
stars	6
balls	9
hearts	3

Which got the most votes: apples, trees, gifts, or balloons?

Favorite	Votes
trees	8
balloons	9
gifts	7
apples	8

How many more balls than apples are in the graph?

Picture Graph: Our Favorites

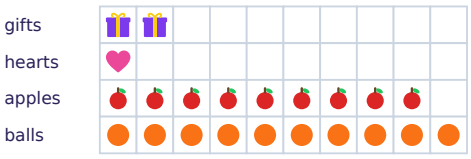

Picture Graphs & Tally Charts · 10

ANSWER

17

Picture Graphs & Tally Charts · 9

ANSWER

6

Picture Graphs & Tally Charts · 12

ANSWER

13

Picture Graphs & Tally Charts · 11

ANSWER

4

Picture Graphs & Tally Charts · 14

ANSWER

8

Picture Graphs & Tally Charts · 13

ANSWER

13

Picture Graphs & Tally Charts · 16

ANSWER

1

Picture Graphs & Tally Charts · 15

ANSWER

balloons

How many votes did gifts get?

Favorite	Votes
gifts	6
stars	11
balls	9
balloons	8

How many more balls than balloons are in the graph?

Picture Graph: Our Favorites



How many votes did apples and balls get in all?

Favorite	Votes
apples	12
gifts	5
balls	1
hearts	7

How many fewer stars than gifts are in the graph?

Picture Graph: Our Favorites



How many more votes did stars get than gifts?

Favorite	Votes
gifts	2
stars	9
balls	4
balloons	5

How many balls and hearts are in the graph in all?

Picture Graph: Our Favorites



Which got the fewest votes: gifts, balls, stars, or apples?

Favorite	Votes
gifts	13
stars	10
apples	3
balls	5

How many fewer votes did apples get than balls?

Favorite	Votes
apples	9
stars	2
balls	12
trees	5

Picture Graphs & Tally Charts · 18

ANSWER

2

Picture Graphs & Tally Charts · 17

ANSWER

6

Picture Graphs & Tally Charts · 20

ANSWER

3

Picture Graphs & Tally Charts · 19

ANSWER

13

Picture Graphs & Tally Charts · 22

ANSWER

10

Picture Graphs & Tally Charts · 21

ANSWER

8

Picture Graphs & Tally Charts · 24

ANSWER

3

Picture Graphs & Tally Charts · 23

ANSWER

apples