How many balls are in the graph?

Picture Graph: Our Favorites



Which has the most: apples, trees, or stars?

Picture Graph: Our Favorites

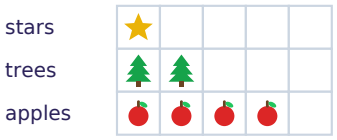

How many apples are in the graph?

Picture Graph: Our Favorites



Which has the fewest: gifts, trees, or balls?

Picture Graph: Our Favorites



How many balls are in the graph?

Picture Graph: Our Favorites

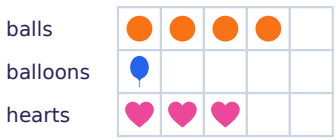

Which has the most: balls, hearts, or apples?

Picture Graph: Our Favorites

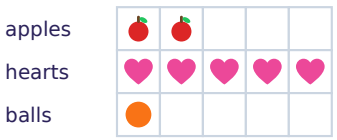

How many apples are in the graph?

Picture Graph: Our Favorites

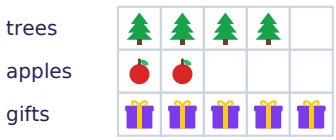

Which has the fewest: apples, hearts, or balloons?

Picture Graph: Our Favorites

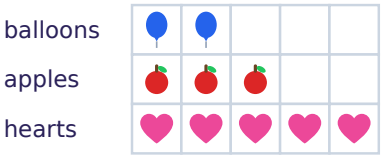

Picture Graphs & Tally Charts · 2

ANSWER

apples

Picture Graphs & Tally Charts · 1

ANSWER

4

Picture Graphs & Tally Charts · 4

ANSWER

balls

Picture Graphs & Tally Charts · 3

ANSWER

5

Picture Graphs & Tally Charts · 6

ANSWER

hearts

Picture Graphs & Tally Charts · 5

ANSWER

4

Picture Graphs & Tally Charts · 8

ANSWER

balloons

Picture Graphs & Tally Charts · 7

ANSWER

2

How many balloons are in the graph?

Picture Graph: Our Favorites

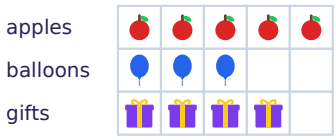

Which has the most: trees, apples, or hearts?

Picture Graph: Our Favorites



How many more balloons than trees are in the graph?

Picture Graph: Our Favorites

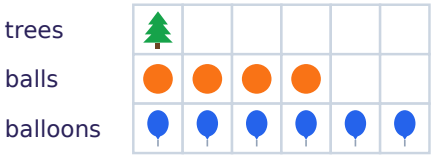

Which has the fewest: gifts, stars, or balls?

Picture Graph: Our Favorites



How many balls are in the graph?

Picture Graph: Our Favorites



How many more gifts than balls are in the graph?

Picture Graph: Our Favorites



Which has the most: apples, trees, or balloons?

Picture Graph: Our Favorites

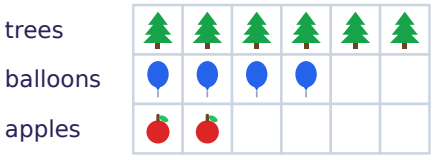

Which has the fewest: balls, balloons, or stars?

Picture Graph: Our Favorites



Picture Graphs & Tally Charts · 10

ANSWER

hearts

Picture Graphs & Tally Charts · 9

ANSWER

3

Picture Graphs & Tally Charts · 12

ANSWER

balls

Picture Graphs & Tally Charts · 11

ANSWER

5

Picture Graphs & Tally Charts · 14

ANSWER

2

Picture Graphs & Tally Charts · 13

ANSWER

1

Picture Graphs & Tally Charts · 16

ANSWER

balloons

Picture Graphs & Tally Charts · 15

ANSWER

trees

How many trees are in the graph?

Picture Graph: Our Favorites

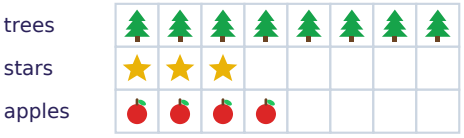

Which has the most: hearts, gifts, or apples?

Picture Graph: Our Favorites



How many more trees than gifts are in the graph?

Picture Graph: Our Favorites

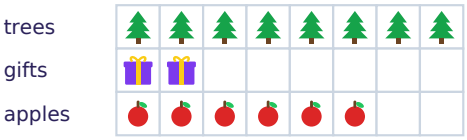

Which has the fewest: stars, gifts, or balls?

Picture Graph: Our Favorites



How many trees and hearts are in the graph in all?

Picture Graph: Our Favorites

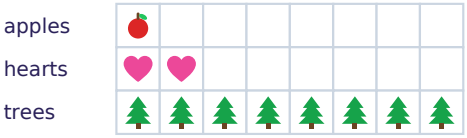

How many more trees than balls are in the graph?

Picture Graph: Our Favorites

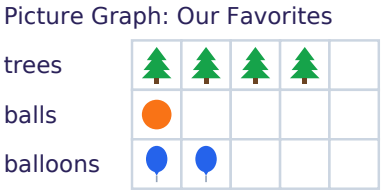

How many votes did trees get?

Favorite	Votes
stars	3
hearts	4
trees	2

Which got the most votes: gifts, apples, or hearts?

Favorite	Votes
apples	4
gifts	3
hearts	4

Picture Graphs & Tally Charts · 18

ANSWER

gifts

Picture Graphs & Tally Charts · 17

ANSWER

8

Picture Graphs & Tally Charts · 20

ANSWER

gifts

Picture Graphs & Tally Charts · 19

ANSWER

6

Picture Graphs & Tally Charts · 22

ANSWER

3

Picture Graphs & Tally Charts · 21

ANSWER

10

Picture Graphs & Tally Charts · 24

ANSWER

apples

Picture Graphs & Tally Charts · 23

ANSWER

2