## How many balls are in the graph?

Picture Graph: Our Favorites






## Which has the most: apples, trees, or stars?

Picture Graph: Our Favorites

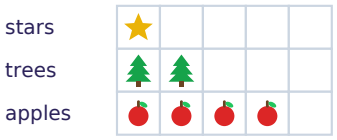




## How many apples are in the graph?

Picture Graph: Our Favorites






## Which has the fewest: gifts, trees, or balls?

Picture Graph: Our Favorites






## How many balls are in the graph?

Picture Graph: Our Favorites

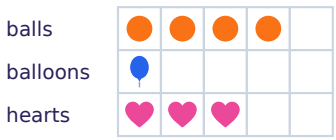




## Which has the most: balls, hearts, or apples?

Picture Graph: Our Favorites

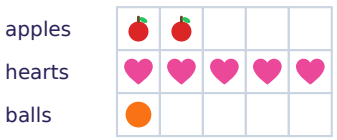




## How many apples are in the graph?

Picture Graph: Our Favorites

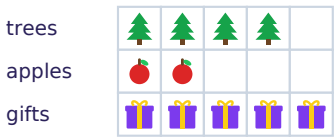




## Which has the fewest: apples, hearts, or balloons?

Picture Graph: Our Favorites

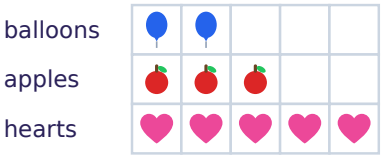

Picture Graphs & Tally Charts · 2

**ANSWER**

# apples

Picture Graphs & Tally Charts · 1

**ANSWER**

# 4

Picture Graphs & Tally Charts · 4

**ANSWER**

# balls

Picture Graphs & Tally Charts · 3

**ANSWER**

# 5

Picture Graphs & Tally Charts · 6

**ANSWER**

# hearts

Picture Graphs & Tally Charts · 5

**ANSWER**

# 4

Picture Graphs & Tally Charts · 8

**ANSWER**

# balloons

Picture Graphs & Tally Charts · 7

**ANSWER**

# 2

## How many balloons are in the graph?

Picture Graph: Our Favorites

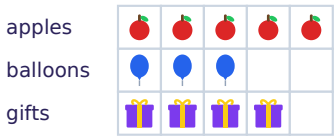




## Which has the most: trees, apples, or hearts?

Picture Graph: Our Favorites






## How many more balloons than trees are in the graph?

Picture Graph: Our Favorites

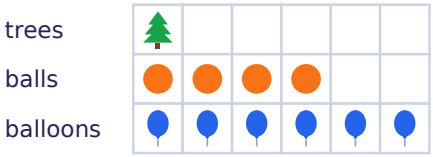




## Which has the fewest: gifts, stars, or balls?

Picture Graph: Our Favorites






## How many balls are in the graph?

Picture Graph: Our Favorites






## How many more gifts than balls are in the graph?

Picture Graph: Our Favorites






## Which has the most: apples, trees, or balloons?

Picture Graph: Our Favorites

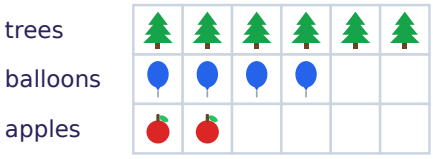




## Which has the fewest: balls, balloons, or stars?

Picture Graph: Our Favorites



Picture Graphs & Tally Charts · 10

**ANSWER**

# hearts

Picture Graphs & Tally Charts · 9

**ANSWER**

# 3

Picture Graphs & Tally Charts · 12

**ANSWER**

# balls

Picture Graphs & Tally Charts · 11

**ANSWER**

# 5

Picture Graphs & Tally Charts · 14

**ANSWER**

# 2

Picture Graphs & Tally Charts · 13

**ANSWER**

# 1

Picture Graphs & Tally Charts · 16

**ANSWER**

# balloons

Picture Graphs & Tally Charts · 15

**ANSWER**

# trees

## How many trees are in the graph?

Picture Graph: Our Favorites

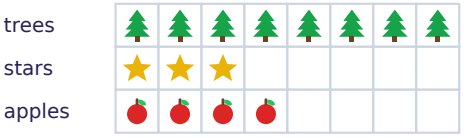




## Which has the most: hearts, gifts, or apples?

Picture Graph: Our Favorites






## How many more trees than gifts are in the graph?

Picture Graph: Our Favorites

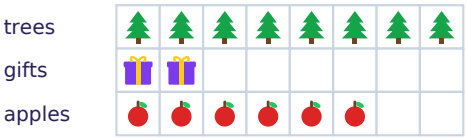




## Which has the fewest: stars, gifts, or balls?

Picture Graph: Our Favorites






## How many trees and hearts are in the graph in all?

Picture Graph: Our Favorites

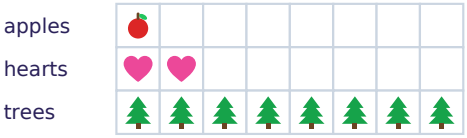




## How many more trees than balls are in the graph?

Picture Graph: Our Favorites

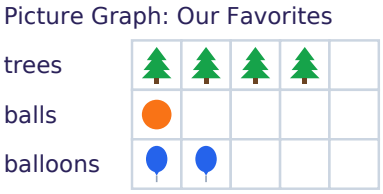




## How many votes did trees get?

| Favorite | Votes |
|---|---|
| stars | 3 |
| hearts | 4 |
| trees | 2 |



## Which got the most votes: gifts, apples, or hearts?

| Favorite | Votes |
|---|---|
| apples | 4 |
| gifts | 3 |
| hearts | 4 |

Picture Graphs & Tally Charts · 18

**ANSWER**

**gifts**

Picture Graphs & Tally Charts · 17

**ANSWER**

**8**

Picture Graphs & Tally Charts · 20

**ANSWER**

**gifts**

Picture Graphs & Tally Charts · 19

**ANSWER**

**6**

Picture Graphs & Tally Charts · 22

**ANSWER**

**3**

Picture Graphs & Tally Charts · 21

**ANSWER**

**10**

Picture Graphs & Tally Charts · 24

**ANSWER**

**apples**

Picture Graphs & Tally Charts · 23

**ANSWER**

**2**