Patterns: Pictures & Numbers · 1

The towers grow the same way each time. How many blocks will the next tower have?

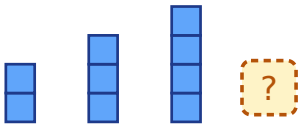


Patterns: Pictures & Numbers · 2

The towers grow the same way each time. How many blocks will the next tower have?

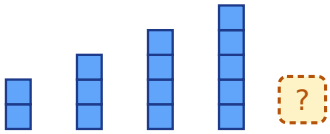


Patterns: Pictures & Numbers · 3

The towers grow the same way each time. How many blocks will the next tower have?

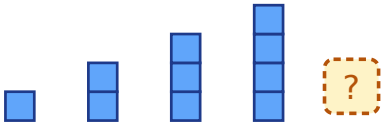


Patterns: Pictures & Numbers · 4

The core is the part of the pattern that repeats. How many balls are in the core?



Patterns: Pictures & Numbers · 5

The towers grow the same way each time. How many blocks will the next tower have?

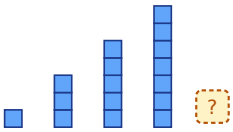


Patterns: Pictures & Numbers · 6

The core is the part of the pattern that repeats. How many balls are in the core?



Patterns: Pictures & Numbers · 7

The towers grow the same way each time. How many blocks will the next tower have?

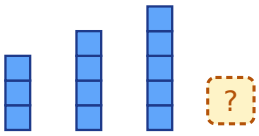


Patterns: Pictures & Numbers · 8

The towers grow the same way each time. How many blocks will the next tower have?

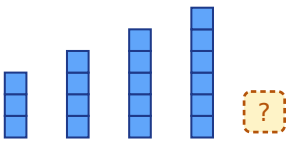

Patterns: Pictures & Numbers · 2

**ANSWER**

**6**

Patterns: Pictures & Numbers · 1

**ANSWER**

**5**

Patterns: Pictures & Numbers · 4

**ANSWER**

**4**

Patterns: Pictures & Numbers · 3

**ANSWER**

**5**

Patterns: Pictures & Numbers · 6

**ANSWER**

**4**

Patterns: Pictures & Numbers · 5

**ANSWER**

**9**

Patterns: Pictures & Numbers · 8

**ANSWER**

**7**

Patterns: Pictures & Numbers · 7

**ANSWER**

**6**

Patterns: Pictures & Numbers · 9

The core is the part of the pattern that repeats. How many balls are in the core?



Patterns: Pictures & Numbers · 10

The towers grow the same way each time. How many blocks will the next tower have?

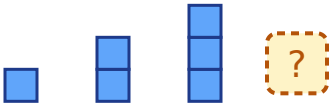


Patterns: Pictures & Numbers · 11

The core is the part of the pattern that repeats. How many balls are in the core?



Patterns: Pictures & Numbers · 12

The towers grow the same way each time. How many blocks will the next tower have?

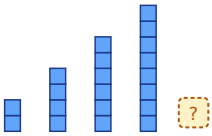


Patterns: Pictures & Numbers · 13

The core is the part of the pattern that repeats. How many balls are in the core?



Patterns: Pictures & Numbers · 14

The core is the part of the pattern that repeats. How many balls are in the core?



Patterns: Pictures & Numbers · 10

**ANSWER**

**4**

Patterns: Pictures & Numbers · 9

**ANSWER**

**3**

Patterns: Pictures & Numbers · 12

**ANSWER**

**10**

Patterns: Pictures & Numbers · 11

**ANSWER**

**4**

Patterns: Pictures & Numbers · 14

**ANSWER**

**3**

Patterns: Pictures & Numbers · 13

**ANSWER**

**4**