Task card 1 Naming Flat Shapes

What shape is this: circle, square, triangle, rectangle, or hexagon?



Task card 2 Naming Flat Shapes

What shape is this: circle, square, triangle, rectangle, or hexagon?



Task card 3 Naming Flat Shapes

How many straight sides does this shape have?



Task card 4 Naming Flat Shapes

How many triangles are in the picture?



Task card 5 Naming Flat Shapes

I have 6 sides and 6 corners. What shape am I?

Task card 6 Naming Flat Shapes

How many corners does this shape have?



Task card 7 Naming Flat Shapes

Think of a coin. What flat shape is it: circle, square, triangle, rectangle, or hexagon?

Task card 8 Naming Flat Shapes

Which has more sides: a hexagon or a triangle?

Task card 9 Naming Flat Shapes

What shape is this: circle, square, triangle, rectangle, or hexagon?



Task card 10 Naming Flat Shapes

What shape is this: circle, square, triangle, rectangle, or hexagon?

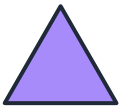

Task card 11 Naming Flat Shapes

How many straight sides does this shape have?



Task card 12 Naming Flat Shapes

How many rectangles are in the picture?



Task card 13 Naming Flat Shapes

I have 3 sides and 3 corners. What shape am I?

Task card 14 Naming Flat Shapes

How many corners does this shape have?



Task card 15 Naming Flat Shapes

Think of a chess board. What flat shape is it: circle, square, triangle, rectangle, or hexagon?

Task card 16 Naming Flat Shapes

Which has more sides: a hexagon or a circle?

Task card 17 Naming Flat Shapes

What shape is this: circle, square, triangle, rectangle, or hexagon?



Task card 18 Naming Flat Shapes

What shape is this: circle, square, triangle, rectangle, or hexagon?



Task card 19 Naming Flat Shapes

How many straight sides does this shape have?



Task card 20 Naming Flat Shapes

How many rectangles are in the picture?



Task card 21 Naming Flat Shapes

I have 4 sides that are all the same length. What shape am I?

Task card 22 Naming Flat Shapes

How many corners does this shape have?



Task card 23 Naming Flat Shapes

Think of a phone screen. What flat shape is it: circle, square, triangle, rectangle, or hexagon?

Task card 24 Naming Flat Shapes

Which has more sides: a hexagon or a rectangle?

Naming Flat Shapes Task Cards

Recording sheet · Kindergarten · Look at each shape. Write a shape name or a number.

Name: _____ Date: _____

Scan to check your answers

1	2	3	4
5	6	7	8
9	10	11	12
13	14	15	16
17	18	19	20
21	22	23	24

Naming Flat Shapes Task Cards: Answer Key

Kindergarten · Medium

The answers online

1. hexagon	**2.** triangle	**3.** 4
4. 2	**5.** hexagon	**6.** 0
7. circle	**8.** hexagon	**9.** circle
10. triangle	**11.** 4	**12.** 4
13. triangle	**14.** 6	**15.** square
16. hexagon	**17.** rectangle	**18.** hexagon
19. 4	**20.** 2	**21.** square
22. 0	**23.** rectangle	**24.** hexagon