**Task card 1** Naming Flat Shapes

What shape is this: circle, square, or triangle?



**Task card 2** Naming Flat Shapes

What shape is this: circle, square, or triangle?



**Task card 3** Naming Flat Shapes

How many straight sides does this shape have?

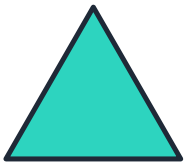

**Task card 4** Naming Flat Shapes

How many squares are in the picture?



**Task card 5** Naming Flat Shapes

I have 3 sides and 3 corners. What shape am I?

**Task card 6** Naming Flat Shapes

How many corners does this shape have?



**Task card 7** Naming Flat Shapes

Think of a sandwich cut corner to corner. What flat shape is it: circle, square, or triangle?

**Task card 8** Naming Flat Shapes

Which has more sides: a square or a triangle?

**Task card 9** Naming Flat Shapes

What shape is this: circle, square, or triangle?



**Task card 10** Naming Flat Shapes

How many straight sides does this shape have?

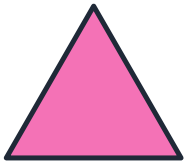

**Task card 11** Naming Flat Shapes

How many circles are in the picture?



**Task card 12** Naming Flat Shapes

How many corners does this shape have?



**Task card 13** Naming Flat Shapes

Think of a sticky note. What flat shape is it: circle, square, or triangle?

**Task card 14** Naming Flat Shapes

Which has more sides: a circle or a triangle?

**Task card 15** Naming Flat Shapes

What shape is this: circle, square, or triangle?



**Task card 16** Naming Flat Shapes

How many straight sides does this shape have?



**Task card 17** Naming Flat Shapes

How many triangles are in the picture?



**Task card 18** Naming Flat Shapes

I am round. I have no sides and no corners. What shape am I?

**Task card 19** Naming Flat Shapes

How many corners does this shape have?

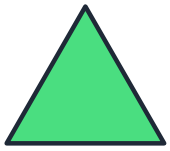

**Task card 20** Naming Flat Shapes

Think of a cookie. What flat shape is it: circle, square, or triangle?

**Task card 21** Naming Flat Shapes

Which has more sides: a square or a circle?

**Task card 22** Naming Flat Shapes

What shape is this: circle, square, or triangle?

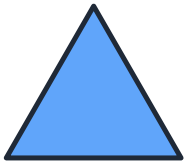

**Task card 23** Naming Flat Shapes

What shape is this: circle, square, or triangle?



**Task card 24** Naming Flat Shapes

How many straight sides does this shape have?

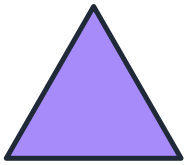

# Naming Flat Shapes Task Cards

Recording sheet · Kindergarten · Look at each shape. Write a shape name or a number.

Name: _____ Date: _____

Scan to check your answers

| | | | |
|---|---|---|---|
| 1 | 2 | 3 | 4 |
| 5 | 6 | 7 | 8 |
| 9 | 10 | 11 | 12 |
| 13 | 14 | 15 | 16 |
| 17 | 18 | 19 | 20 |
| 21 | 22 | 23 | 24 |

# Naming Flat Shapes Task Cards: Answer Key

Kindergarten · Easy

The answers online

| | | |
|---|---|---|
| **1.** triangle | **2.** circle | **3.** 3 |
| **4.** 4 | **5.** triangle | **6.** 0 |
| **7.** triangle | **8.** square | **9.** circle |
| **10.** 3 | **11.** 2 | **12.** 4 |
| **13.** square | **14.** triangle | **15.** square |
| **16.** 3 | **17.** 4 | **18.** circle |
| **19.** 3 | **20.** circle | **21.** square |
| **22.** triangle | **23.** square | **24.** 3 |