Naming Flat Shapes · 1

What shape is this: circle, square, or triangle?



Naming Flat Shapes · 2

What shape is this: circle, square, or triangle?



Naming Flat Shapes · 3

How many straight sides does this shape have?



Naming Flat Shapes · 4

How many squares are in the picture?



Naming Flat Shapes · 5

I have 3 sides and 3 corners. What shape am I?

Naming Flat Shapes · 6

How many corners does this shape have?



Naming Flat Shapes · 7

Think of a sandwich cut corner to corner. What flat shape is it: circle, square, or triangle?

Naming Flat Shapes · 8

Which has more sides: a square or a triangle?

Naming Flat Shapes · 2

ANSWER

circle

Naming Flat Shapes · 1

ANSWER

triangle

Naming Flat Shapes · 4

ANSWER

4

Naming Flat Shapes · 3

ANSWER

3

Naming Flat Shapes · 6

ANSWER

0

Naming Flat Shapes · 5

ANSWER

triangle

Naming Flat Shapes · 8

ANSWER

square

Naming Flat Shapes · 7

ANSWER

triangle

Naming Flat Shapes · 9

What shape is this: circle, square, or triangle?



Naming Flat Shapes · 10

How many straight sides does this shape have?



Naming Flat Shapes · 11

How many circles are in the picture?



Naming Flat Shapes · 12

How many corners does this shape have?



Naming Flat Shapes · 13

Think of a sticky note. What flat shape is it: circle, square, or triangle?

Naming Flat Shapes · 14

Which has more sides: a circle or a triangle?

Naming Flat Shapes · 15

What shape is this: circle, square, or triangle?



Naming Flat Shapes · 16

How many straight sides does this shape have?



Naming Flat Shapes · 10

ANSWER

3

Naming Flat Shapes · 9

ANSWER

circle

Naming Flat Shapes · 12

ANSWER

4

Naming Flat Shapes · 11

ANSWER

2

Naming Flat Shapes · 14

ANSWER

triangle

Naming Flat Shapes · 13

ANSWER

square

Naming Flat Shapes · 16

ANSWER

3

Naming Flat Shapes · 15

ANSWER

square

Naming Flat Shapes · 17

How many triangles are in the picture?



Naming Flat Shapes · 18

I am round. I have no sides and no corners. What shape am I?

Naming Flat Shapes · 19

How many corners does this shape have?



Naming Flat Shapes · 20

Think of a cookie. What flat shape is it: circle, square, or triangle?

Naming Flat Shapes · 21

Which has more sides: a square or a circle?

Naming Flat Shapes · 22

What shape is this: circle, square, or triangle?

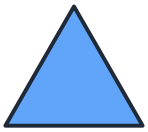

Naming Flat Shapes · 23

What shape is this: circle, square, or triangle?



Naming Flat Shapes · 24

How many straight sides does this shape have?

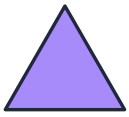

Naming Flat Shapes · 18

ANSWER

circle

Naming Flat Shapes · 17

ANSWER

4

Naming Flat Shapes · 20

ANSWER

circle

Naming Flat Shapes · 19

ANSWER

3

Naming Flat Shapes · 22

ANSWER

triangle

Naming Flat Shapes · 21

ANSWER

square

Naming Flat Shapes · 24

ANSWER

3

Naming Flat Shapes · 23

ANSWER

square