Task card 1 Halloween Math

Ava has 7 ghosts. Ava gives 4 to Mia. How many ghosts does Ava have left?



Task card 2 Halloween Math

Zoe has 4 ghosts. Sam brings 1 more. How many ghosts are there now?



Task card 3 Halloween Math

Noah has 6 pumpkins. Lily brings 1 more. How many pumpkins are there now?



Task card 4 Halloween Math

Lily has 3 ghosts. Sam brings 1 more. How many ghosts are there now?



Task card 5 Halloween Math

How many ghosts are there?



Task card 6 Halloween Math

How many candies are there?



Task card 7 Halloween Math

Omar has 3 candies. Omar gives 1 to Zoe. How many candies does Omar have left?



Task card 8 Halloween Math

How many candies are there?



Task card 9 Halloween Math

Mia has 7 candies. Mia gives 6 to Lily. How many candies does Mia have left?



Task card 10 Halloween Math

Leo has 3 pumpkins. Noah brings 6 more. How many pumpkins are there now?



Task card 11 Halloween Math

Ava has 2 ghosts. Mia brings 6 more. How many ghosts are there now?



Task card 12 Halloween Math

How many ghosts are there?



Task card 13 Halloween Math

Noah has 4 ghosts. Noah gives 2 to Ella. How many ghosts does Noah have left?



Task card 14 Halloween Math

Leo has 6 candies. Ava brings 2 more. How many candies are there now?



Task card 15 Halloween Math

Ava has 9 pumpkins. Ava gives 5 to Ben. How many pumpkins does Ava have left?



Task card 16 Halloween Math

Leo has 4 candies. Ava brings 1 more. How many candies are there now?



Task card 17 Halloween Math

Ella has 4 pumpkins. Ella gives 3 to Lily. How many pumpkins does Ella have left?



Task card 18 Halloween Math

Zoe has 1 pumpkin. Omar brings 2 more. How many pumpkins are there now?



Task card 19 Halloween Math

Sam has 6 ghosts. Ava brings 3 more. How many ghosts are there now?



Task card 20 Halloween Math

Noah has 7 ghosts. Noah gives 6 to Leo. How many ghosts does Noah have left?



Task card 21 Halloween Math

How many pumpkins are there?



Task card 22 Halloween Math

How many pumpkins are there?



Task card 23 Halloween Math

How many ghosts are there?



Task card 24 Halloween Math

Sam has 4 candies. Lily brings 4 more. How many candies are there now?



Halloween Math Task Cards

Recording sheet · Kindergarten · Count the pictures and solve each story.

Name: _____ Date: _____

Scan to check your answers

1	2	3	4
5	6	7	8
9	10	11	12
13	14	15	16
17	18	19	20
21	22	23	24

Halloween Math Task Cards: Answer Key

Kindergarten · Medium

The answers online

1. 3	**2.** 5	**3.** 7
4. 4	**5.** 7	**6.** 3
7. 2	**8.** 7	**9.** 1
10. 9	**11.** 8	**12.** 6
13. 2	**14.** 8	**15.** 4
16. 5	**17.** 1	**18.** 3
19. 9	**20.** 1	**21.** 3
22. 10	**23.** 9	**24.** 8