Task card 1 Halloween Math

Ben has 5 candies. Sam brings 1 more. How many candies are there now?



Task card 2 Halloween Math

Ella has 2 candies. Omar brings 7 more. How many candies are there now?



Task card 3 Halloween Math

Mia has 5 candies. Omar brings 4 more. How many candies are there now?



Task card 4 Halloween Math

How many candies are there?



Task card 5 Halloween Math

Mia has 7 candies. Mia gives 5 to Ella. How many candies does Mia have left?



Task card 6 Halloween Math

How many pumpkins are there?



Task card 7 Halloween Math

How many pumpkins are there?



Task card 8 Halloween Math

Ava has 10 ghosts. Ava gives 6 to Mia. How many ghosts does Ava have left?



Task card 9 Halloween Math

Ava has 1 ghost. Ben brings 8 more. How many ghosts are there now?



Task card 10 Halloween Math

How many ghosts are there?



Task card 11 Halloween Math

Omar has 4 pumpkins. Leo brings 4 more. How many pumpkins are there now?



Task card 12 Halloween Math

Lily has 3 candies. Lily gives 1 to Ella. How many candies does Lily have left?



Task card 13 Halloween Math

How many ghosts are there?



Task card 14 Halloween Math

How many ghosts are there?



Task card 15 Halloween Math

Ben has 6 ghosts. Ben gives 3 to Sam. How many ghosts does Ben have left?



Task card 16 Halloween Math

Lily has 1 candy. Ben brings 5 more. How many candies are there now?



Task card 17 Halloween Math

Lily has 2 ghosts. Noah brings 2 more. How many ghosts are there now?



Task card 18 Halloween Math

Ben has 4 candies. Ava brings 3 more. How many candies are there now?



Task card 19 Halloween Math

Lily has 10 pumpkins. Lily gives 3 to Zoe. How many pumpkins does Lily have left?



Task card 20 Halloween Math

Ben has 3 candies. Leo brings 3 more. How many candies are there now?



Task card 21 Halloween Math

Mia has 5 ghosts. Mia gives 4 to Omar. How many ghosts does Mia have left?



Task card 22 Halloween Math

How many candies are there?



Task card 23 Halloween Math

Mia has 6 ghosts. Leo brings 4 more. How many ghosts are there now?



Task card 24 Halloween Math

Sam has 6 ghosts. Leo brings 1 more. How many ghosts are there now?



Halloween Math Task Cards

Recording sheet · Kindergarten · Count the pictures and solve each story.

Name: _____ Date: _____

Scan to check your answers

1	2	3	4
5	6	7	8
9	10	11	12
13	14	15	16
17	18	19	20
21	22	23	24

Halloween Math Task Cards: Answer Key

Kindergarten · Hard

The answers online

1. 6	**2.** 9	**3.** 9
4. 9	**5.** 2	**6.** 3
7. 9	**8.** 4	**9.** 9
10. 10	**11.** 8	**12.** 2
13. 8	**14.** 6	**15.** 3
16. 6	**17.** 4	**18.** 7
19. 7	**20.** 6	**21.** 1
22. 6	**23.** 10	**24.** 7