Halloween Math · 1

Ava has 7 ghosts. Ava gives 4 to Mia. How many ghosts does Ava have left?



Halloween Math · 2

Zoe has 4 ghosts. Sam brings 1 more. How many ghosts are there now?



Halloween Math · 3

Noah has 6 pumpkins. Lily brings 1 more. How many pumpkins are there now?



Halloween Math · 4

Lily has 3 ghosts. Sam brings 1 more. How many ghosts are there now?



Halloween Math · 5

How many ghosts are there?



Halloween Math · 6

How many candies are there?



Halloween Math · 7

Omar has 3 candies. Omar gives 1 to Zoe. How many candies does Omar have left?



Halloween Math · 8

How many candies are there?



Halloween Math · 2

ANSWER

5

Halloween Math · 1

ANSWER

3

Halloween Math · 4

ANSWER

4

Halloween Math · 3

ANSWER

7

Halloween Math · 6

ANSWER

3

Halloween Math · 5

ANSWER

7

Halloween Math · 8

ANSWER

7

Halloween Math · 7

ANSWER

2

Halloween Math · 9

Mia has 7 candies. Mia gives 6 to Lily. How many candies does Mia have left?



Halloween Math · 10

Leo has 3 pumpkins. Noah brings 6 more. How many pumpkins are there now?



Halloween Math · 11

Ava has 2 ghosts. Mia brings 6 more. How many ghosts are there now?



Halloween Math · 12

How many ghosts are there?



Halloween Math · 13

Noah has 4 ghosts. Noah gives 2 to Ella. How many ghosts does Noah have left?



Halloween Math · 14

Leo has 6 candies. Ava brings 2 more. How many candies are there now?



Halloween Math · 15

Ava has 9 pumpkins. Ava gives 5 to Ben. How many pumpkins does Ava have left?



Halloween Math · 16

Leo has 4 candies. Ava brings 1 more. How many candies are there now?



Halloween Math · 10

ANSWER

9

Halloween Math · 9

ANSWER

1

Halloween Math · 12

ANSWER

6

Halloween Math · 11

ANSWER

8

Halloween Math · 14

ANSWER

8

Halloween Math · 13

ANSWER

2

Halloween Math · 16

ANSWER

5

Halloween Math · 15

ANSWER

4

Halloween Math · 17

Ella has 4 pumpkins. Ella gives 3 to Lily. How many pumpkins does Ella have left?



Halloween Math · 18

Zoe has 1 pumpkin. Omar brings 2 more. How many pumpkins are there now?



Halloween Math · 19

Sam has 6 ghosts. Ava brings 3 more. How many ghosts are there now?



Halloween Math · 20

Noah has 7 ghosts. Noah gives 6 to Leo. How many ghosts does Noah have left?



Halloween Math · 21

How many pumpkins are there?



Halloween Math · 22

How many pumpkins are there?



Halloween Math · 23

How many ghosts are there?



Halloween Math · 24

Sam has 4 candies. Lily brings 4 more. How many candies are there now?



Halloween Math · 18

ANSWER

3

Halloween Math · 17

ANSWER

1

Halloween Math · 20

ANSWER

1

Halloween Math · 19

ANSWER

9

Halloween Math · 22

ANSWER

10

Halloween Math · 21

ANSWER

3

Halloween Math · 24

ANSWER

8

Halloween Math · 23

ANSWER

9