Easter Math · 1

How many eggs are there?



Easter Math · 2

How many carrots are there?



Easter Math · 3

How many carrots are there?



Easter Math · 4

Sam has 1 carrot. Noah brings 1 more. How many carrots are there now?



Easter Math · 5

Omar has 5 flowers. Lily brings 1 more. How many flowers are there now?



Easter Math · 6

Lily has 7 flowers. Lily gives 3 to Ava. How many flowers does Lily have left?



Easter Math · 7

Leo has 4 eggs. Omar brings 2 more. How many eggs are there now?



Easter Math · 8

Mia has 6 carrots. Mia gives 2 to Ava. How many carrots does Mia have left?



Easter Math · 2

**ANSWER**

**6**

Easter Math · 1

**ANSWER**

**5**

Easter Math · 4

**ANSWER**

**2**

Easter Math · 3

**ANSWER**

**3**

Easter Math · 6

**ANSWER**

**4**

Easter Math · 5

**ANSWER**

**6**

Easter Math · 8

**ANSWER**

**4**

Easter Math · 7

**ANSWER**

**6**

Easter Math · 9

Mia has 6 flowers. Ben brings 3 more. How many flowers are there now?



Easter Math · 10

How many flowers are there?



Easter Math · 11

Noah has 6 eggs. Sam brings 2 more. How many eggs are there now?



Easter Math · 12

Zoe has 2 carrots. Ava brings 6 more. How many carrots are there now?



Easter Math · 13

Ben has 9 carrots. Ben gives 6 to Mia. How many carrots does Ben have left?



Easter Math · 14

Ella has 3 flowers. Ella gives 2 to Omar. How many flowers does Ella have left?



Easter Math · 15

How many flowers are there?



Easter Math · 16

Sam has 6 carrots. Mia brings 3 more. How many carrots are there now?



Easter Math · 10

**ANSWER**

**3**

Easter Math · 9

**ANSWER**

**9**

Easter Math · 12

**ANSWER**

**8**

Easter Math · 11

**ANSWER**

**8**

Easter Math · 14

**ANSWER**

**1**

Easter Math · 13

**ANSWER**

**3**

Easter Math · 16

**ANSWER**

**9**

Easter Math · 15

**ANSWER**

**7**

Easter Math · 17

Ben has 4 carrots. Sam brings 3 more. How many carrots are there now?



Easter Math · 18

Leo has 5 flowers. Leo gives 4 to Omar. How many flowers does Leo have left?



Easter Math · 19

How many carrots are there?



Easter Math · 20

How many carrots are there?



Easter Math · 21

How many carrots are there?



Easter Math · 22

Lily has 2 eggs. Sam brings 1 more. How many eggs are there now?



Easter Math · 23

Lily has 3 eggs. Lily gives 2 to Ava. How many eggs does Lily have left?



Easter Math · 24

Ella has 3 eggs. Sam brings 1 more. How many eggs are there now?



Easter Math · 18

**ANSWER**

# 1

Easter Math · 17

**ANSWER**

# 7

Easter Math · 20

**ANSWER**

# 10

Easter Math · 19

**ANSWER**

# 8

Easter Math · 22

**ANSWER**

# 3

Easter Math · 21

**ANSWER**

# 4

Easter Math · 24

**ANSWER**

# 4

Easter Math · 23

**ANSWER**

# 1