Counting Objects to 20 · 1

How many balloons? Start at the top and count all the way around.



Counting Objects to 20 · 2

How many balls? Start at the top and count all the way around.



Counting Objects to 20 · 3

How many balls? Start at the top and count all the way around.



Counting Objects to 20 · 4

How many apples? Start at the top and count all the way around.



Counting Objects to 20 · 5

How many hearts? Start at the top and count all the way around.



Counting Objects to 20 · 6

How many hearts? Start at the top and count all the way around.



Counting Objects to 20 · 7

How many apples? Start at the top and count all the way around.

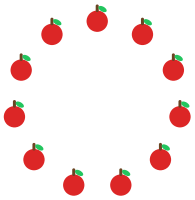

Counting Objects to 20 · 8

How many balls? Start at the top and count all the way around.



Counting Objects to 20 · 2

ANSWER

14

Counting Objects to 20 · 1

ANSWER

16

Counting Objects to 20 · 4

ANSWER

15

Counting Objects to 20 · 3

ANSWER

11

Counting Objects to 20 · 6

ANSWER

15

Counting Objects to 20 · 5

ANSWER

11

Counting Objects to 20 · 8

ANSWER

16

Counting Objects to 20 · 7

ANSWER

11

Counting Objects to 20 · 9

How many stars? Start at the top and count all the way around.



Counting Objects to 20 · 10

How many apples? Start at the top and count all the way around.



Counting Objects to 20 · 11

How many balloons? Start at the top and count all the way around.



Counting Objects to 20 · 12

How many balloons? Start at the top and count all the way around.



Counting Objects to 20 · 13

How many balls? Start at the top and count all the way around.



Counting Objects to 20 · 14

How many apples? Start at the top and count all the way around.

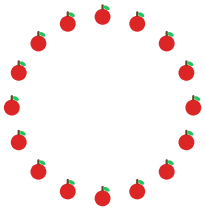

Counting Objects to 20 · 15

How many balls? Start at the top and count all the way around.



Counting Objects to 20 · 16

How many stars? Start at the top and count all the way around.



Counting Objects to 20 · 10

ANSWER

18

Counting Objects to 20 · 9

ANSWER

15

Counting Objects to 20 · 12

ANSWER

18

Counting Objects to 20 · 11

ANSWER

14

Counting Objects to 20 · 14

ANSWER

16

Counting Objects to 20 · 13

ANSWER

13

Counting Objects to 20 · 16

ANSWER

20

Counting Objects to 20 · 15

ANSWER

19

Counting Objects to 20 · 17

How many stars? Start at the top and count all the way around.



Counting Objects to 20 · 18

How many hearts? Start at the top and count all the way around.



Counting Objects to 20 · 19

How many stars? Start at the top and count all the way around.



Counting Objects to 20 · 20

How many hearts? Start at the top and count all the way around.



Counting Objects to 20 · 21

How many hearts? Start at the top and count all the way around.



Counting Objects to 20 · 22

How many balloons? Start at the top and count all the way around.



Counting Objects to 20 · 23

How many balloons? Start at the top and count all the way around.



Counting Objects to 20 · 24

How many balloons? Start at the top and count all the way around.



Counting Objects to 20 · 18

ANSWER

12

Counting Objects to 20 · 17

ANSWER

14

Counting Objects to 20 · 20

ANSWER

14

Counting Objects to 20 · 19

ANSWER

11

Counting Objects to 20 · 22

ANSWER

15

Counting Objects to 20 · 21

ANSWER

18

Counting Objects to 20 · 24

ANSWER

13

Counting Objects to 20 · 23

ANSWER

19