Counting Objects to 20 · 1

How many balloons? Start at the top and count all the way around.



Counting Objects to 20 · 2

How many balls? Start at the top and count all the way around.



Counting Objects to 20 · 3

How many balls? Start at the top and count all the way around.



Counting Objects to 20 · 4

How many apples? Start at the top and count all the way around.



Counting Objects to 20 · 5

How many hearts? Start at the top and count all the way around.



Counting Objects to 20 · 6

How many hearts? Start at the top and count all the way around.



Counting Objects to 20 · 7

How many apples? Start at the top and count all the way around.

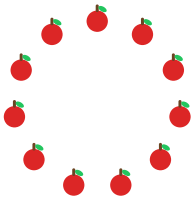

Counting Objects to 20 · 8

How many balls? Start at the top and count all the way around.



Counting Objects to 20 · 2

**ANSWER**

# 14

Counting Objects to 20 · 1

**ANSWER**

# 16

Counting Objects to 20 · 4

**ANSWER**

# 15

Counting Objects to 20 · 3

**ANSWER**

# 11

Counting Objects to 20 · 6

**ANSWER**

# 15

Counting Objects to 20 · 5

**ANSWER**

# 11

Counting Objects to 20 · 8

**ANSWER**

# 16

Counting Objects to 20 · 7

**ANSWER**

# 11

Counting Objects to 20 · 9

How many stars? Start at the top and count all the way around.



Counting Objects to 20 · 10

How many apples? Start at the top and count all the way around.



Counting Objects to 20 · 11

How many balloons? Start at the top and count all the way around.



Counting Objects to 20 · 12

How many balloons? Start at the top and count all the way around.



Counting Objects to 20 · 13

How many balls? Start at the top and count all the way around.



Counting Objects to 20 · 14

How many apples? Start at the top and count all the way around.

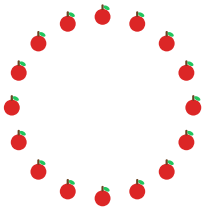

Counting Objects to 20 · 15

How many balls? Start at the top and count all the way around.



Counting Objects to 20 · 16

How many stars? Start at the top and count all the way around.



Counting Objects to 20 · 10

**ANSWER**

# 18

Counting Objects to 20 · 9

**ANSWER**

# 15

Counting Objects to 20 · 12

**ANSWER**

# 18

Counting Objects to 20 · 11

**ANSWER**

# 14

Counting Objects to 20 · 14

**ANSWER**

# 16

Counting Objects to 20 · 13

**ANSWER**

# 13

Counting Objects to 20 · 16

**ANSWER**

# 20

Counting Objects to 20 · 15

**ANSWER**

# 19

Counting Objects to 20 · 17

How many stars? Start at the top and count all the way around.



Counting Objects to 20 · 18

How many hearts? Start at the top and count all the way around.



Counting Objects to 20 · 19

How many stars? Start at the top and count all the way around.



Counting Objects to 20 · 20

How many hearts? Start at the top and count all the way around.



Counting Objects to 20 · 21

How many hearts? Start at the top and count all the way around.



Counting Objects to 20 · 22

How many balloons? Start at the top and count all the way around.



Counting Objects to 20 · 23

How many balloons? Start at the top and count all the way around.



Counting Objects to 20 · 24

How many balloons? Start at the top and count all the way around.



Counting Objects to 20 · 18

**ANSWER**

# 12

Counting Objects to 20 · 17

**ANSWER**

# 14

Counting Objects to 20 · 20

**ANSWER**

# 14

Counting Objects to 20 · 19

**ANSWER**

# 11

Counting Objects to 20 · 22

**ANSWER**

# 15

Counting Objects to 20 · 21

**ANSWER**

# 18

Counting Objects to 20 · 24

**ANSWER**

# 13

Counting Objects to 20 · 23

**ANSWER**

# 19