Task card 1 Comparing Length & Weight

Which ribbon is the longest: yellow, red, or orange?

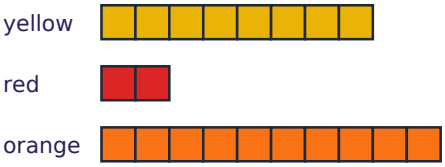

Task card 2 Comparing Length & Weight

How many cubes longer is the purple ribbon than the orange ribbon?

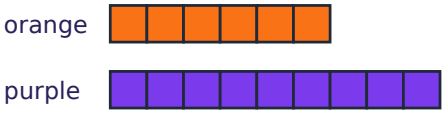

Task card 3 Comparing Length & Weight

Which ribbon is the shortest: yellow, pink, or purple?

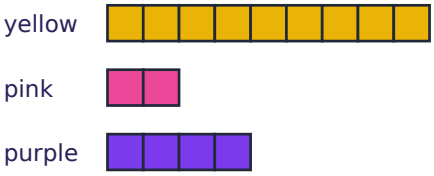

Task card 4 Comparing Length & Weight

Which box is lighter: the green box or the yellow box?

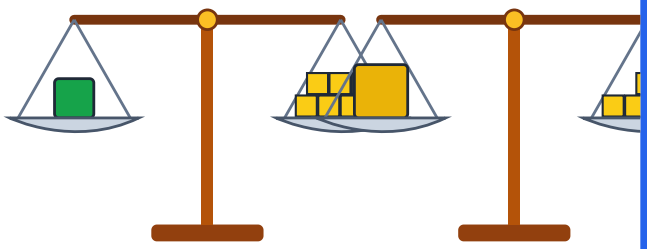

Task card 5 Comparing Length & Weight

Which tower is the tallest: red, yellow, or blue?

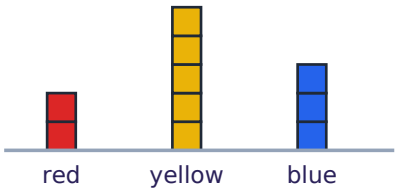

Task card 6 Comparing Length & Weight

Which box is heavier: the pink box or the green box?



Task card 7 Comparing Length & Weight

How many cubes taller is the blue tower than the orange tower?

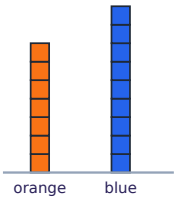

Task card 8 Comparing Length & Weight

Which box is lighter: the orange box or the yellow box?



Task card 9 Comparing Length & Weight

Which ribbon is longer: the yellow ribbon or the red ribbon?



Task card 10 Comparing Length & Weight

How many cubes longer is the green ribbon than the pink ribbon?



Task card 11 Comparing Length & Weight

Which ribbon is the longest: pink, orange, or red?

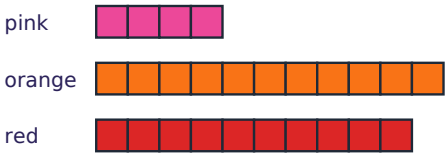

Task card 12 Comparing Length & Weight

Which box is lighter: the blue box or the pink box?

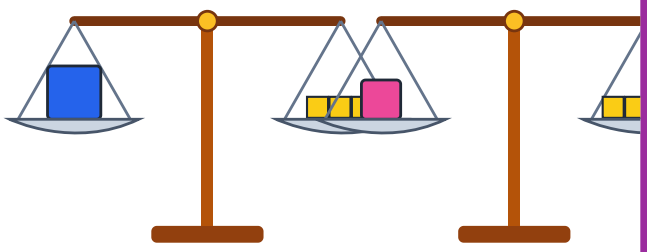

Task card 13 Comparing Length & Weight

Which tower is the shortest: purple, orange, or pink?

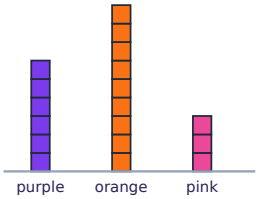

Task card 14 Comparing Length & Weight

Which box is heavier: the red box or the yellow box?



Task card 15 Comparing Length & Weight

Which ribbon is shorter: the red ribbon or the orange ribbon?

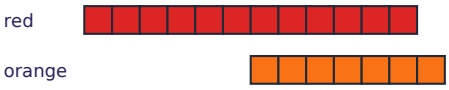

Task card 16 Comparing Length & Weight

The scale is level. The yellow box weighs the same as how many cubes?

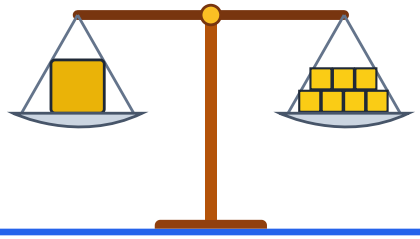

Task card 17 Comparing Length & Weight

Which ribbon is longer: the green ribbon or the blue ribbon?

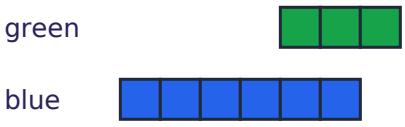

Task card 18 Comparing Length & Weight

How many cubes taller is the green tower than the red tower?

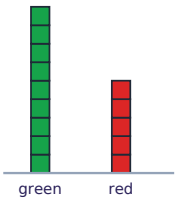

Task card 19 Comparing Length & Weight

Which ribbon is the shortest: orange, pink, or red?

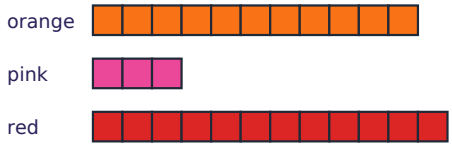

Task card 20 Comparing Length & Weight

Which box is lighter: the purple box or the pink box?

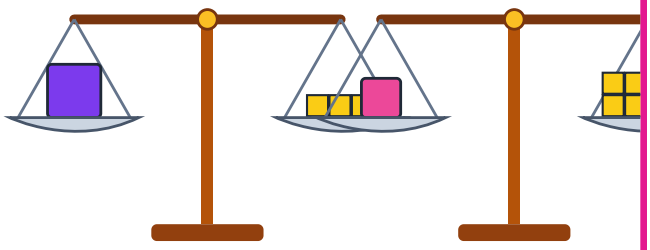

Task card 21 Comparing Length & Weight

Which tower is the tallest: red, orange, or yellow?

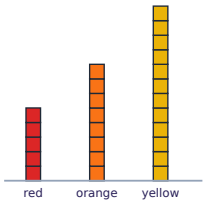

Task card 22 Comparing Length & Weight

Which box is lighter: the green box or the pink box?



Task card 23 Comparing Length & Weight

Which ribbon is shorter: the red ribbon or the pink ribbon?

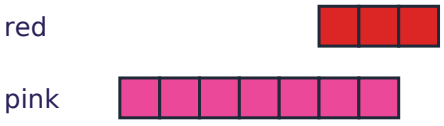

Task card 24 Comparing Length & Weight

How many cubes longer is the blue ribbon than the orange ribbon?

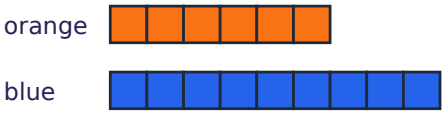

Comparing Length & Weight Task Cards

Recording sheet · Kindergarten · Look at the cubes or the scale. Write a color or a number.

Name: _____ Date: _____

Scan to check your answers

1	2	3	4
5	6	7	8
9	10	11	12
13	14	15	16
17	18	19	20
21	22	23	24

Comparing Length & Weight Task Cards: Answer Key

Kindergarten · Medium

The answers online

1. orange	**2.** 3	**3.** pink
4. yellow	**5.** yellow	**6.** green
7. 2	**8.** orange	**9.** yellow
10. 4	**11.** orange	**12.** blue
13. pink	**14.** red	**15.** orange
16. 7	**17.** blue	**18.** 4
19. pink	**20.** purple	**21.** yellow
22. green	**23.** red	**24.** 3