Task card 1 Comparing Length & Weight

Which box is the heaviest: green, purple, or blue?

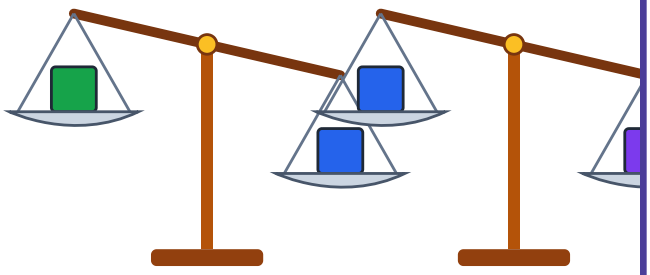

Task card 2 Comparing Length & Weight

Which ribbon is longer: the purple ribbon or the green ribbon?

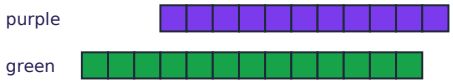

Task card 3 Comparing Length & Weight

How many cubes taller is the orange tower than the blue tower?

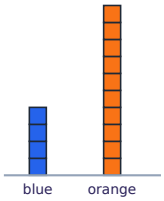

Task card 4 Comparing Length & Weight

Which box is lighter: the orange box or the yellow box?

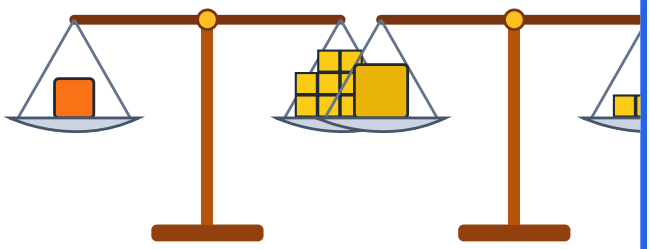

Task card 5 Comparing Length & Weight

Which ribbon is the longest: green, red, or yellow?

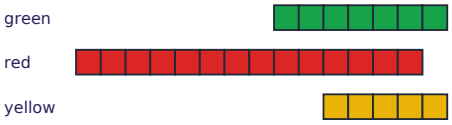

Task card 6 Comparing Length & Weight

Which box is the lightest: red, blue, or green?

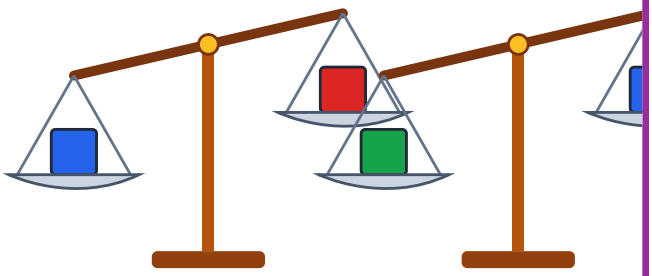

Task card 7 Comparing Length & Weight

How many cubes longer is the pink ribbon than the orange ribbon?

pink



orange



Task card 8 Comparing Length & Weight

Which box is lighter: the blue box or the green box?

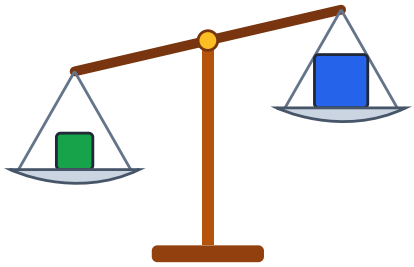

Task card 9 Comparing Length & Weight

Which box is the heaviest: yellow, purple, or orange?

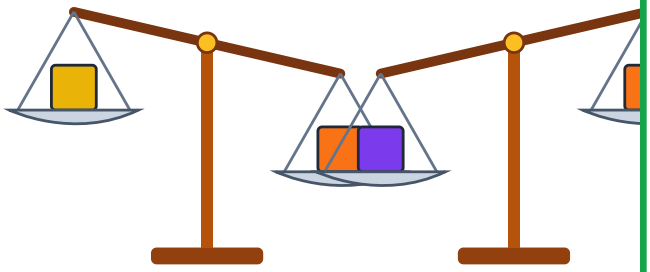

Task card 10 Comparing Length & Weight

Which ribbon is the longest: red, pink, or purple?

red



pink



purple



Task card 11 Comparing Length & Weight

How many cubes longer is the green ribbon than the yellow ribbon?

yellow



green



Task card 12 Comparing Length & Weight

Which box is heavier: the orange box or the purple box?

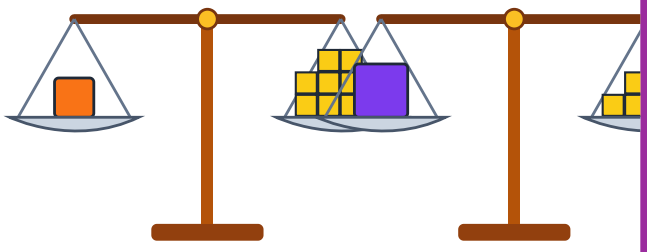

Task card 13 Comparing Length & Weight

Which ribbon is shorter: the purple ribbon or the blue ribbon?



Task card 14 Comparing Length & Weight

Which box is the lightest: purple, pink, or red?

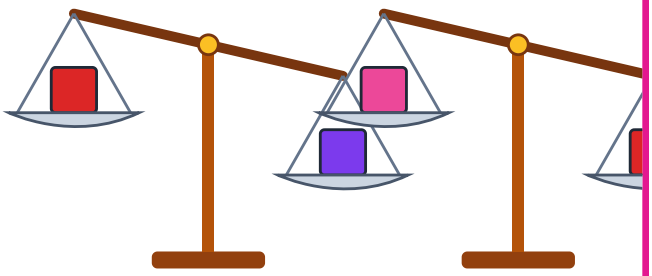

Task card 15 Comparing Length & Weight

How many cubes taller is the blue tower than the purple tower?

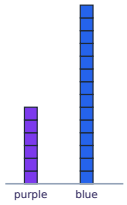

Task card 16 Comparing Length & Weight

The scale is level. The yellow box weighs the same as how many cubes?

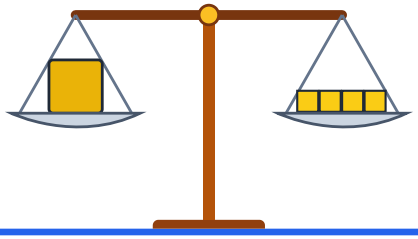

Task card 17 Comparing Length & Weight

Which box is the heaviest: green, pink, or blue?

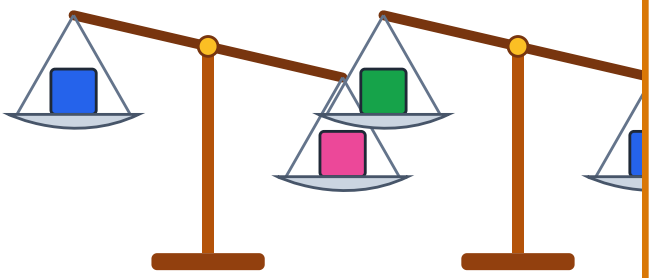

Task card 18 Comparing Length & Weight

Which ribbon is longer: the purple ribbon or the green ribbon?

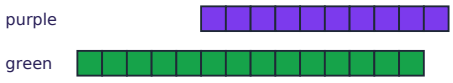

Task card 19 Comparing Length & Weight

How many cubes taller is the green tower than the orange tower?

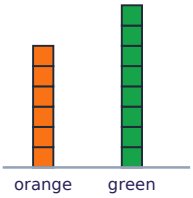

Task card 20 Comparing Length & Weight

Which box is heavier: the purple box or the red box?

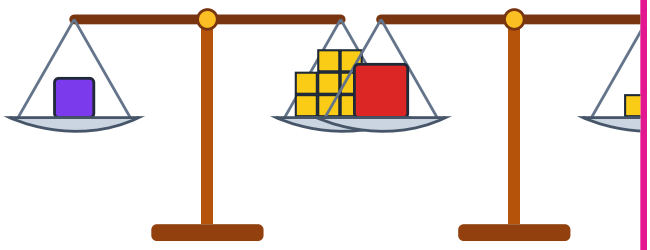

Task card 21 Comparing Length & Weight

Which ribbon is the longest: blue, purple, or green?

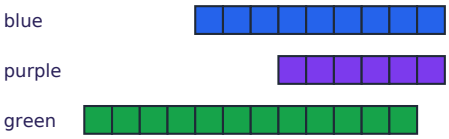

Task card 22 Comparing Length & Weight

Which box is the lightest: orange, red, or purple?

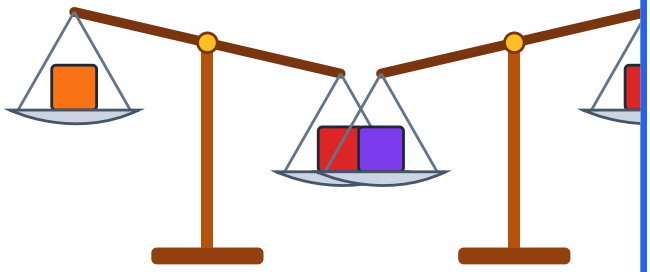

Task card 23 Comparing Length & Weight

How many cubes longer is the pink ribbon than the purple ribbon?

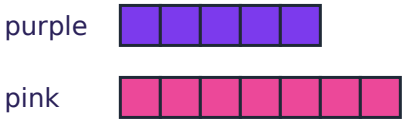

Task card 24 Comparing Length & Weight

Which box is lighter: the blue box or the orange box?



Comparing Length & Weight Task Cards

Recording sheet · Kindergarten · Look at the cubes or the scale. Write a color or a number.

Name: _____ Date: _____

Scan to check your answers

1	2	3	4
5	6	7	8
9	10	11	12
13	14	15	16
17	18	19	20
21	22	23	24

Comparing Length & Weight Task Cards: Answer Key

Kindergarten · Hard

The answers online

1. purple	**2.** green	**3.** 6
4. yellow	**5.** red	**6.** red
7. 1	**8.** blue	**9.** purple
10. pink	**11.** 7	**12.** orange
13. blue	**14.** pink	**15.** 8
16. 4	**17.** pink	**18.** green
19. 2	**20.** purple	**21.** green
22. orange	**23.** 2	**24.** orange