Task card 1 Comparing Length & Weight

Which ribbon is longer: the green ribbon or the pink ribbon?

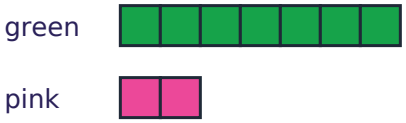

Task card 2 Comparing Length & Weight

Which ribbon is shorter: the blue ribbon or the orange ribbon?

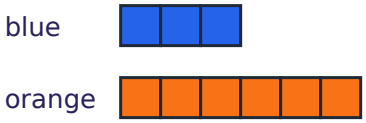

Task card 3 Comparing Length & Weight

Which tower is taller: the green tower or the blue tower?

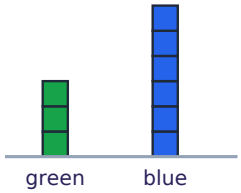

Task card 4 Comparing Length & Weight

Which box is heavier: the green box or the red box?



Task card 5 Comparing Length & Weight

Which ribbon is longer: the pink ribbon or the orange ribbon?

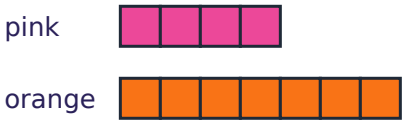

Task card 6 Comparing Length & Weight

Which box is lighter: the purple box or the blue box?

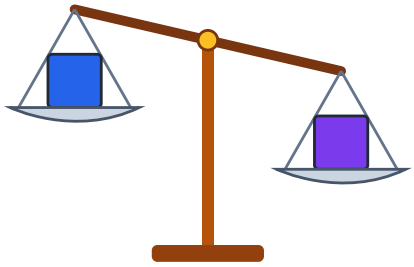

Task card 7 Comparing Length & Weight

Which tower is shorter: the pink tower or the green tower?

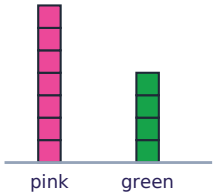

Task card 8 Comparing Length & Weight

Which box is heavier: the purple box or the red box?



Task card 9 Comparing Length & Weight

Which ribbon is longer: the red ribbon or the orange ribbon?

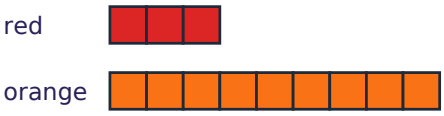

Task card 10 Comparing Length & Weight

How many cubes long is the yellow ribbon?



Task card 11 Comparing Length & Weight

Which ribbon is shorter: the blue ribbon or the orange ribbon?

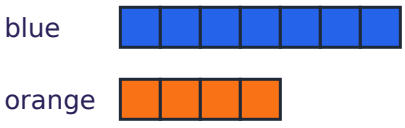

Task card 12 Comparing Length & Weight

Which box is heavier: the orange box or the green box?



Task card 13 Comparing Length & Weight

Which tower is taller: the purple tower or the yellow tower?

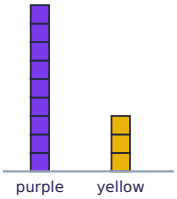

Task card 14 Comparing Length & Weight

Which box is lighter: the blue box or the green box?

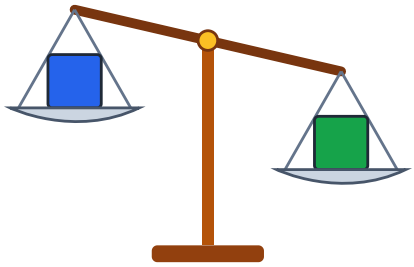

Task card 15 Comparing Length & Weight

How many cubes long is the green ribbon?

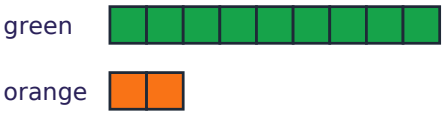

Task card 16 Comparing Length & Weight

The scale is level. The red box weighs the same as how many cubes?

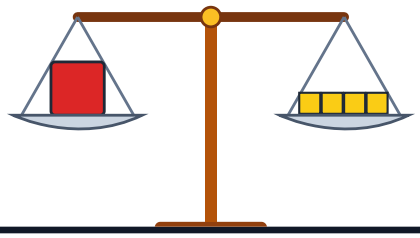

Task card 17 Comparing Length & Weight

Which ribbon is the longest: red, pink, or yellow?

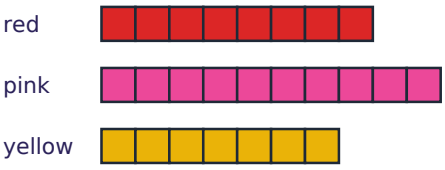

Task card 18 Comparing Length & Weight

How many cubes long is the pink ribbon?

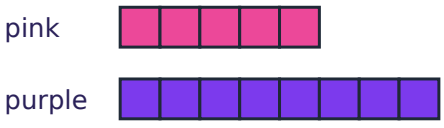

Task card 19 Comparing Length & Weight

Which ribbon is the shortest: yellow, orange, or purple?

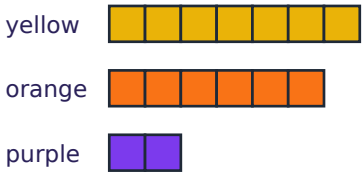

Task card 20 Comparing Length & Weight

Which box is heavier: the blue box or the yellow box?



Task card 21 Comparing Length & Weight

Which tower is the tallest: red, green, or pink?

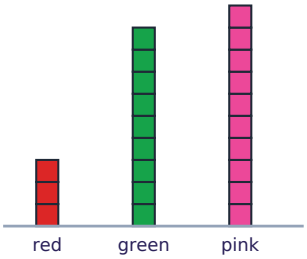

Task card 22 Comparing Length & Weight

Which box is lighter: the yellow box or the red box?

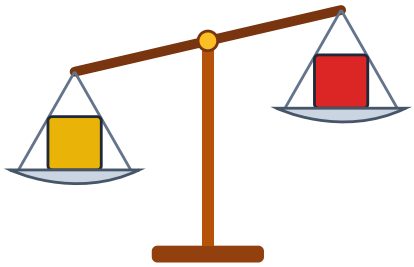

Task card 23 Comparing Length & Weight

How many cubes long is the pink ribbon?

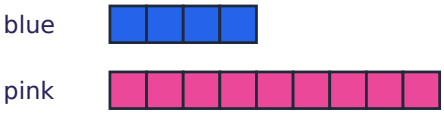

Task card 24 Comparing Length & Weight

The scale is level. The orange box weighs the same as how many cubes?

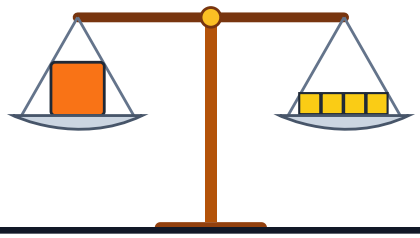

Comparing Length & Weight Task Cards

Recording sheet · Kindergarten · Look at the cubes or the scale. Write a color or a number.

Name: _____ Date: _____

Scan to check your answers

1	2	3	4
5	6	7	8
9	10	11	12
13	14	15	16
17	18	19	20
21	22	23	24

Comparing Length & Weight Task Cards: Answer Key

Kindergarten · Easy

The answers online

1. green	**2.** blue	**3.** blue
4. green	**5.** orange	**6.** blue
7. green	**8.** purple	**9.** orange
10. 8	**11.** orange	**12.** green
13. purple	**14.** blue	**15.** 9
16. 4	**17.** pink	**18.** 5
19. purple	**20.** yellow	**21.** pink
22. red	**23.** 9	**24.** 4