**Task card 1** Comparing Length & Weight

Which ribbon is longer: the green ribbon or the pink ribbon?

green



pink



**Task card 2** Comparing Length & Weight

Which ribbon is shorter: the blue ribbon or the orange ribbon?

blue



orange



**Task card 3** Comparing Length & Weight

Which tower is taller: the green tower or the blue tower?

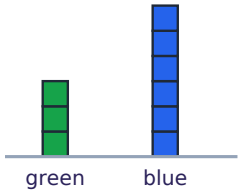


**Task card 4** Comparing Length & Weight

Which box is heavier: the green box or the red box?



**Task card 5** Comparing Length & Weight

Which ribbon is longer: the pink ribbon or the orange ribbon?

pink



orange



**Task card 6** Comparing Length & Weight

Which box is lighter: the purple box or the blue box?



**Task card 7** Comparing Length & Weight

Which tower is shorter: the pink tower or the green tower?

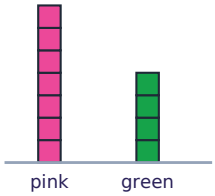


**Task card 8** Comparing Length & Weight

Which box is heavier: the purple box or the red box?



**Task card 9** Comparing Length & Weight

Which ribbon is longer: the red ribbon or the orange ribbon?

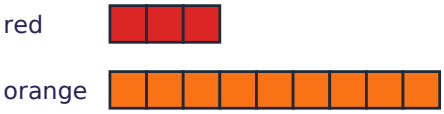


**Task card 10** Comparing Length & Weight

How many cubes long is the yellow ribbon?




**Task card 11** Comparing Length & Weight

Which ribbon is shorter: the blue ribbon or the orange ribbon?

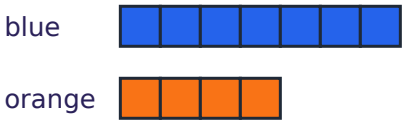


**Task card 12** Comparing Length & Weight

Which box is heavier: the orange box or the green box?



**Task card 13** Comparing Length & Weight

Which tower is taller: the purple tower or the yellow tower?

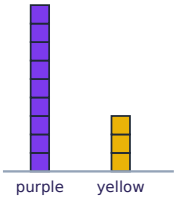


**Task card 14** Comparing Length & Weight

Which box is lighter: the blue box or the green box?

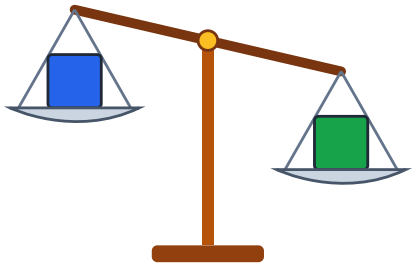

**Task card 15** Comparing Length & Weight

How many cubes long is the green ribbon?

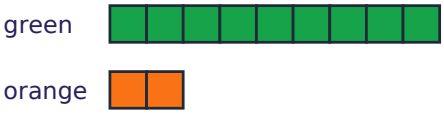


**Task card 16** Comparing Length & Weight

The scale is level. The red box weighs the same as how many cubes?

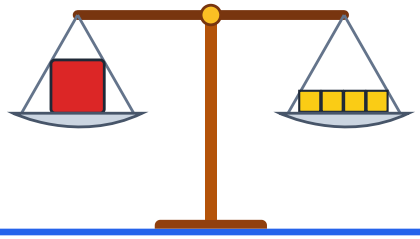

**Task card 17** Comparing Length & Weight

Which ribbon is the longest: red, pink, or yellow?

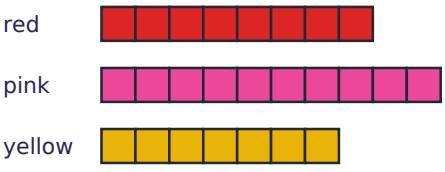


**Task card 18** Comparing Length & Weight

How many cubes long is the pink ribbon?

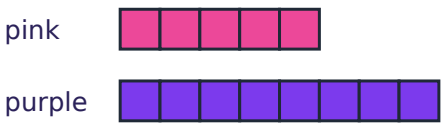

**Task card 19** Comparing Length & Weight

Which ribbon is the shortest: yellow, orange, or purple?

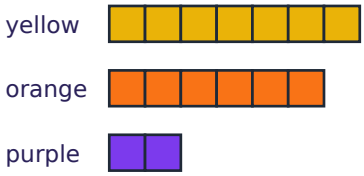


**Task card 20** Comparing Length & Weight

Which box is heavier: the blue box or the yellow box?



**Task card 21** Comparing Length & Weight

Which tower is the tallest: red, green, or pink?

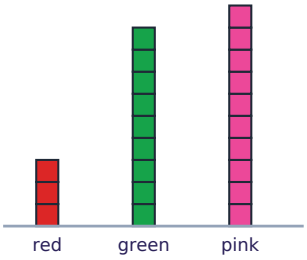


**Task card 22** Comparing Length & Weight

Which box is lighter: the yellow box or the red box?

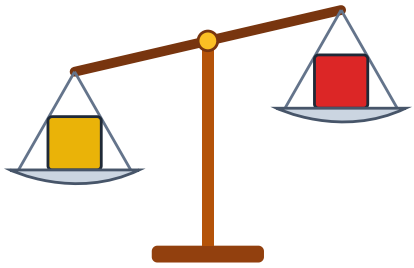

**Task card 23** Comparing Length & Weight

How many cubes long is the pink ribbon?

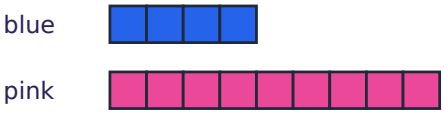


**Task card 24** Comparing Length & Weight

The scale is level. The orange box weighs the same as how many cubes?

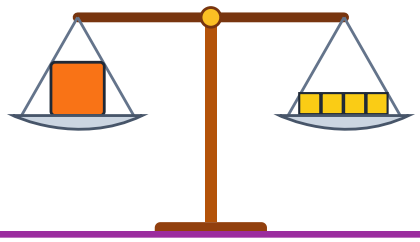

# Comparing Length & Weight Task Cards

Recording sheet · Kindergarten · Look at the cubes or the scale. Write a color or a number.

Name: _____ Date: _____

Scan to check your answers

| | | | |
|---|---|---|---|
| 1 | 2 | 3 | 4 |
| 5 | 6 | 7 | 8 |
| 9 | 10 | 11 | 12 |
| 13 | 14 | 15 | 16 |
| 17 | 18 | 19 | 20 |
| 21 | 22 | 23 | 24 |

# Comparing Length & Weight Task Cards: Answer Key

Kindergarten · Easy

The answers online

| | | |
|---|---|---|
| **1.** green | **2.** blue | **3.** blue |
| **4.** green | **5.** orange | **6.** blue |
| **7.** green | **8.** purple | **9.** orange |
| **10.** 8 | **11.** orange | **12.** green |
| **13.** purple | **14.** blue | **15.** 9 |
| **16.** 4 | **17.** pink | **18.** 5 |
| **19.** purple | **20.** yellow | **21.** pink |
| **22.** red | **23.** 9 | **24.** 4 |