Comparing Length & Weight · 1

Which box is the heaviest: green, purple, or blue?

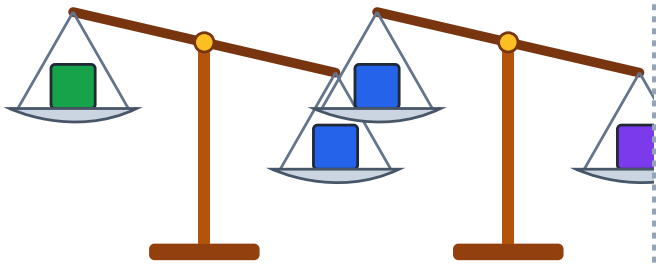

Comparing Length & Weight · 2

Which ribbon is longer: the purple ribbon or the green ribbon?

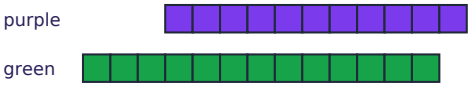

Comparing Length & Weight · 3

How many cubes taller is the orange tower than the blue tower?

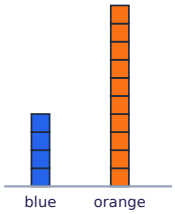

Comparing Length & Weight · 4

Which box is lighter: the orange box or the yellow box?

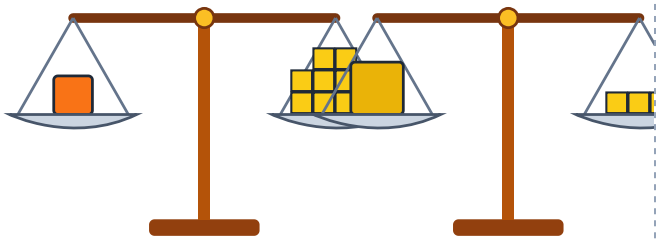

Comparing Length & Weight · 5

Which ribbon is the longest: green, red, or yellow?

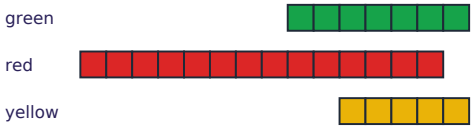

Comparing Length & Weight · 6

Which box is the lightest: red, blue, or green?

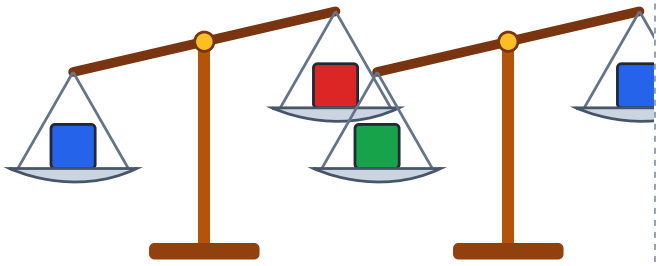

Comparing Length & Weight · 7

How many cubes longer is the pink ribbon than the orange ribbon?

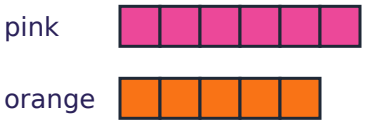

Comparing Length & Weight · 8

Which box is lighter: the blue box or the green box?

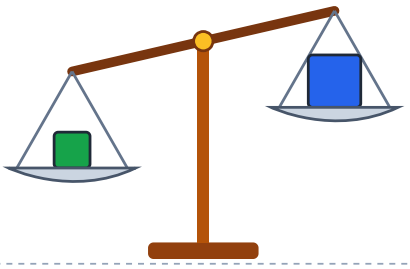

Comparing Length & Weight · 2

ANSWER

green

Comparing Length & Weight · 1

ANSWER

purple

Comparing Length & Weight · 4

ANSWER

yellow

Comparing Length & Weight · 3

ANSWER

6

Comparing Length & Weight · 6

ANSWER

red

Comparing Length & Weight · 5

ANSWER

red

Comparing Length & Weight · 8

ANSWER

blue

Comparing Length & Weight · 7

ANSWER

1

Comparing Length & Weight · 9

Which box is the heaviest: yellow, purple, or orange?

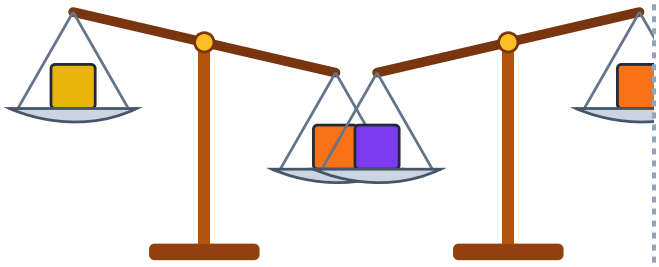

Comparing Length & Weight · 10

Which ribbon is the longest: red, pink, or purple?

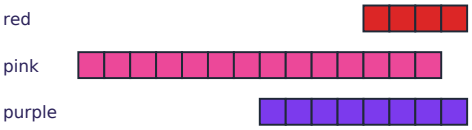

Comparing Length & Weight · 11

How many cubes longer is the green ribbon than the yellow ribbon?

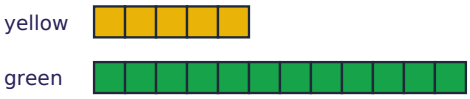

Comparing Length & Weight · 12

Which box is heavier: the orange box or the purple box?

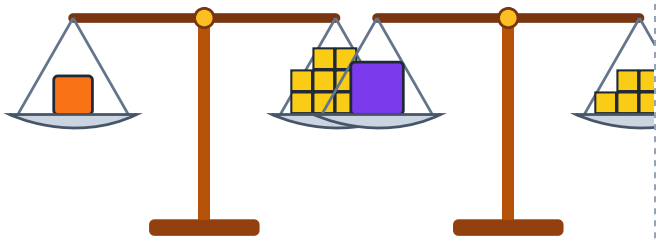

Comparing Length & Weight · 13

Which ribbon is shorter: the purple ribbon or the blue ribbon?



Comparing Length & Weight · 14

Which box is the lightest: purple, pink, or red?

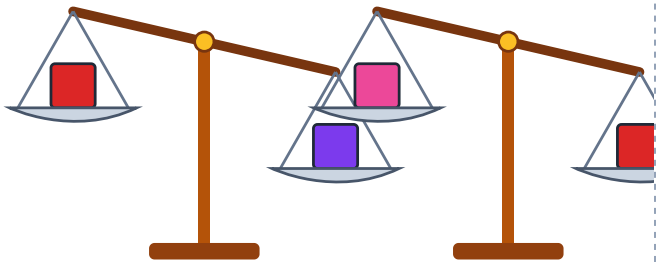

Comparing Length & Weight · 15

How many cubes taller is the blue tower than the purple tower?

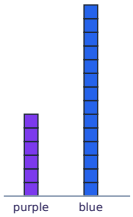

Comparing Length & Weight · 16

The scale is level. The yellow box weighs the same as how many cubes?

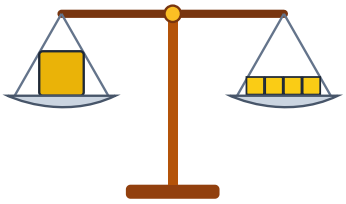

Comparing Length & Weight · 10

ANSWER

pink

Comparing Length & Weight · 9

ANSWER

purple

Comparing Length & Weight · 12

ANSWER

orange

Comparing Length & Weight · 11

ANSWER

7

Comparing Length & Weight · 14

ANSWER

pink

Comparing Length & Weight · 13

ANSWER

blue

Comparing Length & Weight · 16

ANSWER

4

Comparing Length & Weight · 15

ANSWER

8

Comparing Length & Weight · 17

Which box is the heaviest: green, pink, or blue?

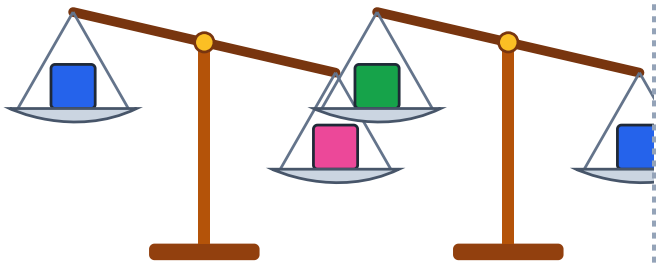

Comparing Length & Weight · 18

Which ribbon is longer: the purple ribbon or the green ribbon?

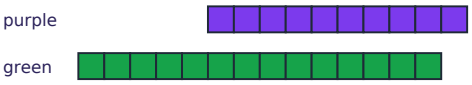

Comparing Length & Weight · 19

How many cubes taller is the green tower than the orange tower?

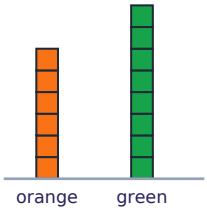

Comparing Length & Weight · 20

Which box is heavier: the purple box or the red box?

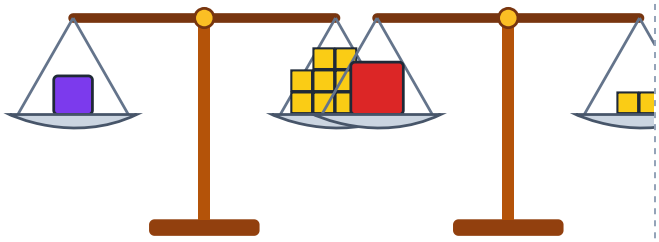

Comparing Length & Weight · 21

Which ribbon is the longest: blue, purple, or green?

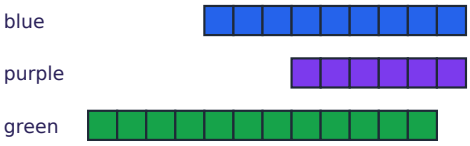

Comparing Length & Weight · 22

Which box is the lightest: orange, red, or purple?

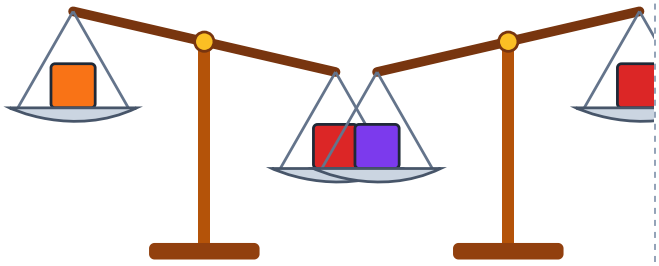

Comparing Length & Weight · 23

How many cubes longer is the pink ribbon than the purple ribbon?

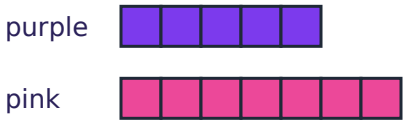

Comparing Length & Weight · 24

Which box is lighter: the blue box or the orange box?

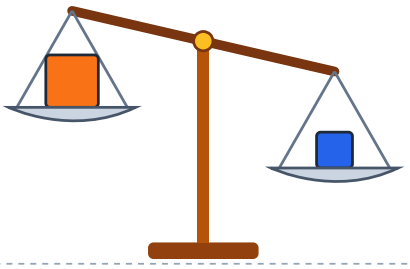

Comparing Length & Weight · 18

ANSWER

green

Comparing Length & Weight · 17

ANSWER

pink

Comparing Length & Weight · 20

ANSWER

purple

Comparing Length & Weight · 19

ANSWER

2

Comparing Length & Weight · 22

ANSWER

orange

Comparing Length & Weight · 21

ANSWER

green

Comparing Length & Weight · 24

ANSWER

orange

Comparing Length & Weight · 23

ANSWER

2