Comparing Length & Weight · 1

Which ribbon is the longest: yellow, red, or orange?

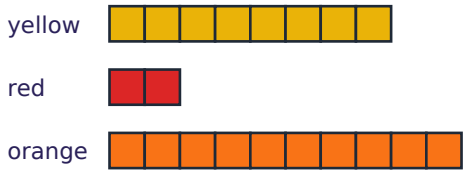

Comparing Length & Weight · 2

How many cubes longer is the purple ribbon than the orange ribbon?

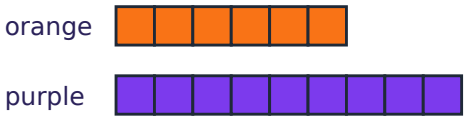

Comparing Length & Weight · 3

Which ribbon is the shortest: yellow, pink, or purple?

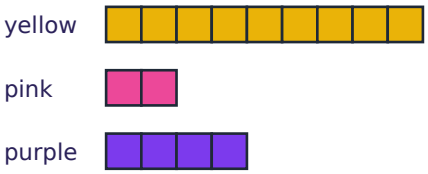

Comparing Length & Weight · 4

Which box is lighter: the green box or the yellow box?

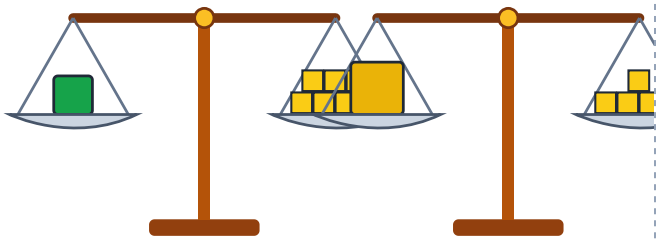

Comparing Length & Weight · 5

Which tower is the tallest: red, yellow, or blue?

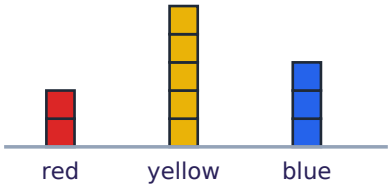

Comparing Length & Weight · 6

Which box is heavier: the pink box or the green box?

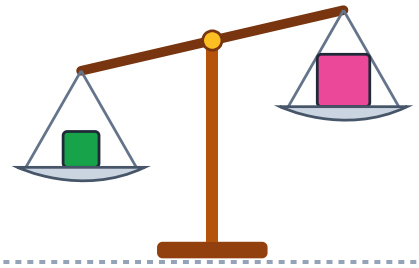

Comparing Length & Weight · 7

How many cubes taller is the blue tower than the orange tower?

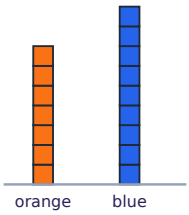

Comparing Length & Weight · 8

Which box is lighter: the orange box or the yellow box?

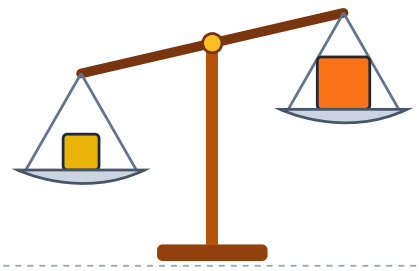

Comparing Length & Weight · 2

ANSWER

3

Comparing Length & Weight · 1

ANSWER

orange

Comparing Length & Weight · 4

ANSWER

yellow

Comparing Length & Weight · 3

ANSWER

pink

Comparing Length & Weight · 6

ANSWER

green

Comparing Length & Weight · 5

ANSWER

yellow

Comparing Length & Weight · 8

ANSWER

orange

Comparing Length & Weight · 7

ANSWER

2

Comparing Length & Weight · 9

Which ribbon is longer: the yellow ribbon or the red ribbon?



Comparing Length & Weight · 10

How many cubes longer is the green ribbon than the pink ribbon?

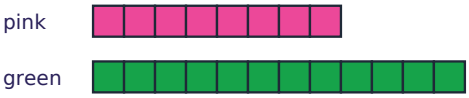

Comparing Length & Weight · 11

Which ribbon is the longest: pink, orange, or red?

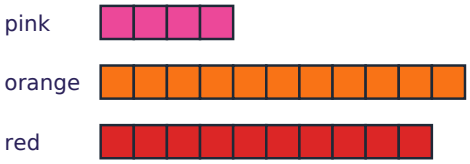

Comparing Length & Weight · 12

Which box is lighter: the blue box or the pink box?

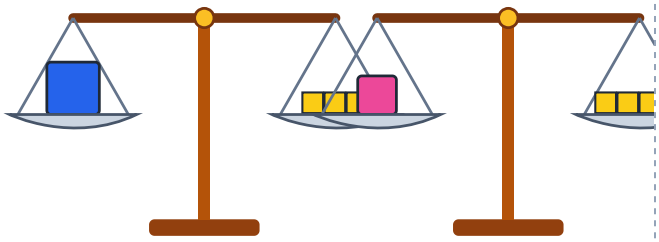

Comparing Length & Weight · 13

Which tower is the shortest: purple, orange, or pink?

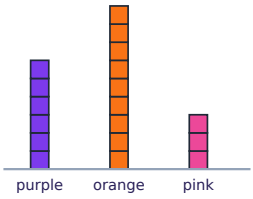

Comparing Length & Weight · 14

Which box is heavier: the red box or the yellow box?

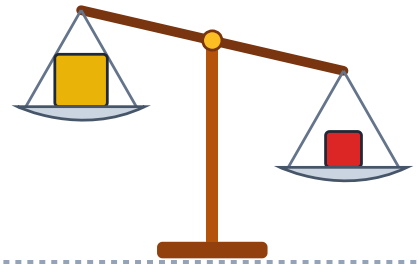

Comparing Length & Weight · 15

Which ribbon is shorter: the red ribbon or the orange ribbon?

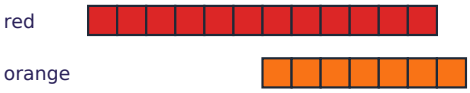

Comparing Length & Weight · 16

The scale is level. The yellow box weighs the same as how many cubes?

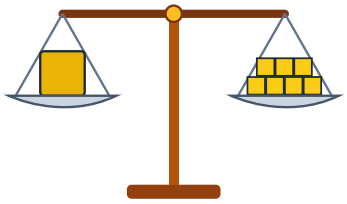

Comparing Length & Weight · 10

ANSWER

4

Comparing Length & Weight · 9

ANSWER

yellow

Comparing Length & Weight · 12

ANSWER

blue

Comparing Length & Weight · 11

ANSWER

orange

Comparing Length & Weight · 14

ANSWER

red

Comparing Length & Weight · 13

ANSWER

pink

Comparing Length & Weight · 16

ANSWER

7

Comparing Length & Weight · 15

ANSWER

orange

Comparing Length & Weight · 17

Which ribbon is longer: the green ribbon or the blue ribbon?

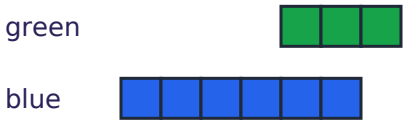

Comparing Length & Weight · 18

How many cubes taller is the green tower than the red tower?

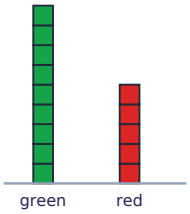

Comparing Length & Weight · 19

Which ribbon is the shortest: orange, pink, or red?

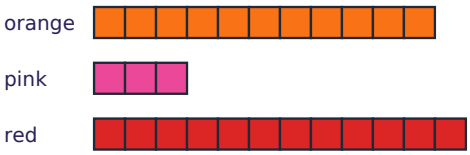

Comparing Length & Weight · 20

Which box is lighter: the purple box or the pink box?

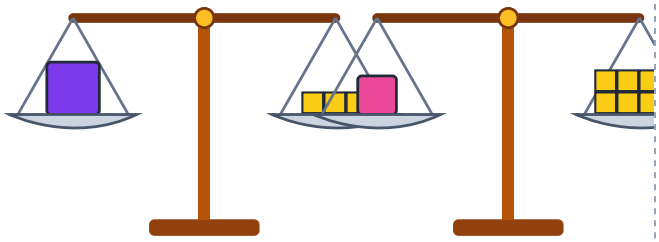

Comparing Length & Weight · 21

Which tower is the tallest: red, orange, or yellow?

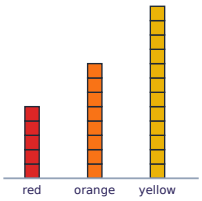

Comparing Length & Weight · 22

Which box is lighter: the green box or the pink box?

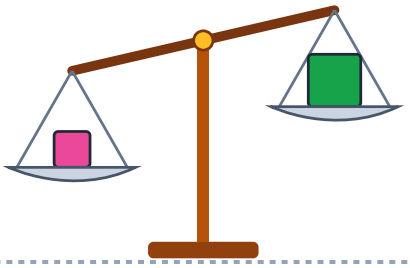

Comparing Length & Weight · 23

Which ribbon is shorter: the red ribbon or the pink ribbon?

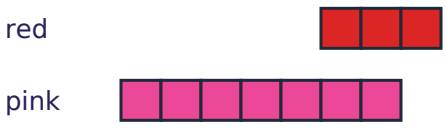

Comparing Length & Weight · 24

How many cubes longer is the blue ribbon than the orange ribbon?

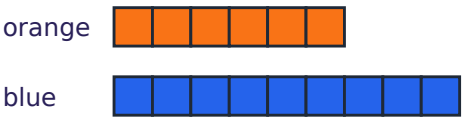

Comparing Length & Weight · 18

ANSWER

4

Comparing Length & Weight · 17

ANSWER

blue

Comparing Length & Weight · 20

ANSWER

purple

Comparing Length & Weight · 19

ANSWER

pink

Comparing Length & Weight · 22

ANSWER

green

Comparing Length & Weight · 21

ANSWER

yellow

Comparing Length & Weight · 24

ANSWER

3

Comparing Length & Weight · 23

ANSWER

red