Comparing Length & Weight · 1

Which ribbon is longer: the green ribbon or the pink ribbon?

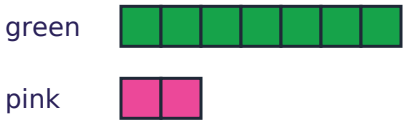

Comparing Length & Weight · 2

Which ribbon is shorter: the blue ribbon or the orange ribbon?

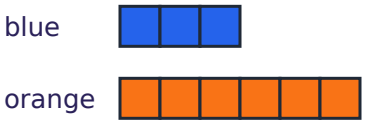

Comparing Length & Weight · 3

Which tower is taller: the green tower or the blue tower?

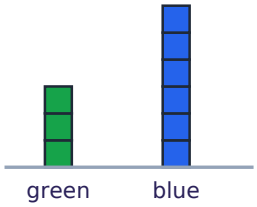

Comparing Length & Weight · 4

Which box is heavier: the green box or the red box?

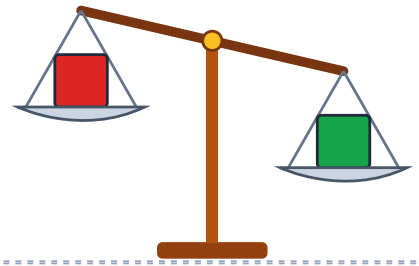

Comparing Length & Weight · 5

Which ribbon is longer: the pink ribbon or the orange ribbon?

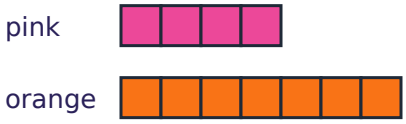

Comparing Length & Weight · 6

Which box is lighter: the purple box or the blue box?

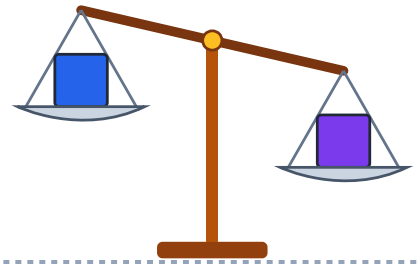

Comparing Length & Weight · 7

Which tower is shorter: the pink tower or the green tower?

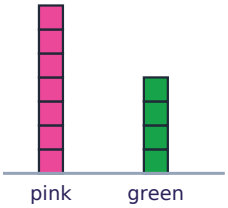

Comparing Length & Weight · 8

Which box is heavier: the purple box or the red box?



Comparing Length & Weight · 2

ANSWER

blue

Comparing Length & Weight · 1

ANSWER

green

Comparing Length & Weight · 4

ANSWER

green

Comparing Length & Weight · 3

ANSWER

blue

Comparing Length & Weight · 6

ANSWER

blue

Comparing Length & Weight · 5

ANSWER

orange

Comparing Length & Weight · 8

ANSWER

purple

Comparing Length & Weight · 7

ANSWER

green

Comparing Length & Weight · 9

Which ribbon is longer: the red ribbon or the orange ribbon?

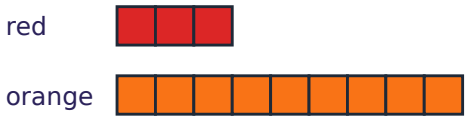

Comparing Length & Weight · 10

How many cubes long is the yellow ribbon?



Comparing Length & Weight · 11

Which ribbon is shorter: the blue ribbon or the orange ribbon?

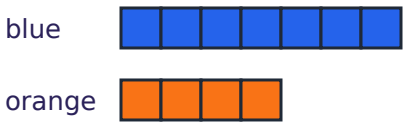

Comparing Length & Weight · 12

Which box is heavier: the orange box or the green box?

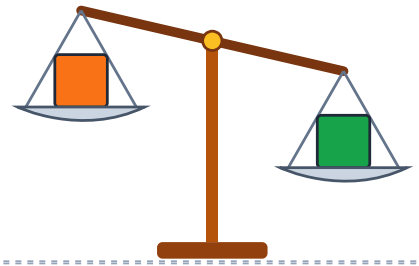

Comparing Length & Weight · 13

Which tower is taller: the purple tower or the yellow tower?

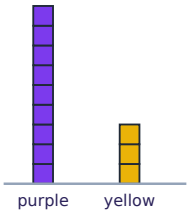

Comparing Length & Weight · 14

Which box is lighter: the blue box or the green box?

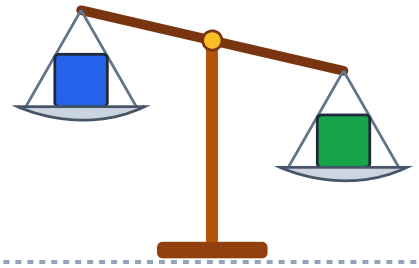

Comparing Length & Weight · 15

How many cubes long is the green ribbon?

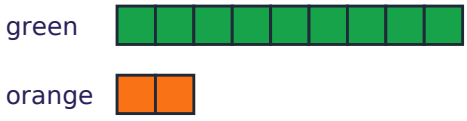

Comparing Length & Weight · 16

The scale is level. The red box weighs the same as how many cubes?

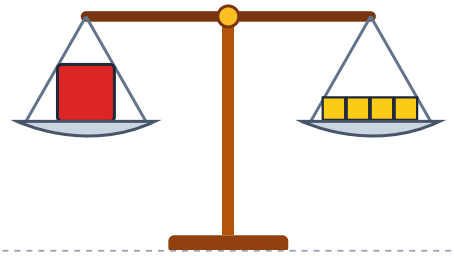

Comparing Length & Weight · 10

ANSWER

8

Comparing Length & Weight · 9

ANSWER

orange

Comparing Length & Weight · 12

ANSWER

green

Comparing Length & Weight · 11

ANSWER

orange

Comparing Length & Weight · 14

ANSWER

blue

Comparing Length & Weight · 13

ANSWER

purple

Comparing Length & Weight · 16

ANSWER

4

Comparing Length & Weight · 15

ANSWER

9

Comparing Length & Weight · 17

Which ribbon is the longest: red, pink, or yellow?

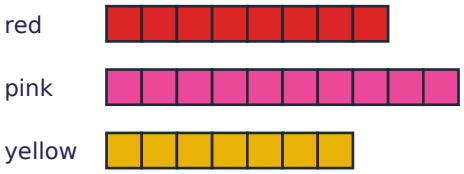

Comparing Length & Weight · 18

How many cubes long is the pink ribbon?

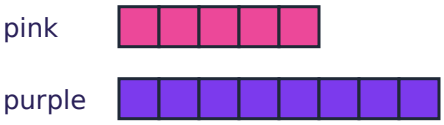

Comparing Length & Weight · 19

Which ribbon is the shortest: yellow, orange, or purple?

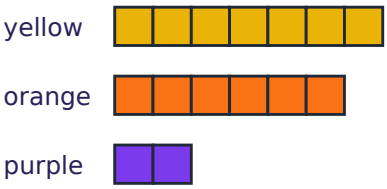

Comparing Length & Weight · 20

Which box is heavier: the blue box or the yellow box?

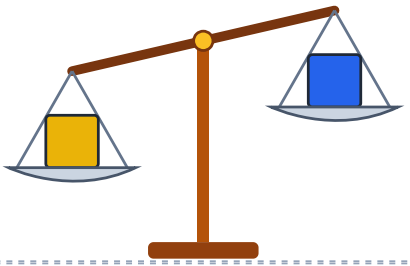

Comparing Length & Weight · 21

Which tower is the tallest: red, green, or pink?

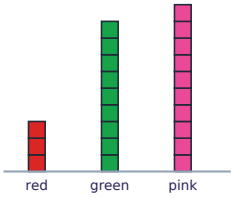

Comparing Length & Weight · 22

Which box is lighter: the yellow box or the red box?

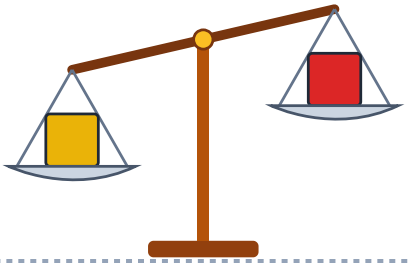

Comparing Length & Weight · 23

How many cubes long is the pink ribbon?

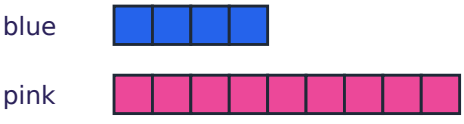

Comparing Length & Weight · 24

The scale is level. The orange box weighs the same as how many cubes?

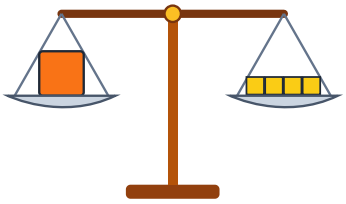

Comparing Length & Weight · 18

ANSWER

5

Comparing Length & Weight · 17

ANSWER

pink

Comparing Length & Weight · 20

ANSWER

yellow

Comparing Length & Weight · 19

ANSWER

purple

Comparing Length & Weight · 22

ANSWER

red

Comparing Length & Weight · 21

ANSWER

pink

Comparing Length & Weight · 24

ANSWER

4

Comparing Length & Weight · 23

ANSWER

9