Task card 1 Comparing Groups of Objects

Which group has more: the balls or the balloons? If they are the same, write same.



Task card 2 Comparing Groups of Objects

Which group has fewer: the apples or the balls? If they are the same, write same.



Task card 3 Comparing Groups of Objects

Which group has more: the apples or the balls? If they are the same, write same.



Task card 4 Comparing Groups of Objects

Which group has fewer: the stars or the balloons? If they are the same, write same.



Task card 5 Comparing Groups of Objects

Which group has more: the stars or the balls? If they are the same, write same.



Task card 6 Comparing Groups of Objects

Which group has fewer: the balls or the stars? If they are the same, write same.



Task card 7 Comparing Groups of Objects

Which group has more: the apples or the hearts? If they are the same, write same.



Task card 8 Comparing Groups of Objects

Which group has fewer: the balls or the hearts? If they are the same, write same.



Task card 9 Comparing Groups of Objects

Which group has more: the balloons or the stars? If they are the same, write same.



Task card 10 Comparing Groups of Objects

Which group has fewer: the apples or the hearts? If they are the same, write same.



Task card 11 Comparing Groups of Objects

Which group has more: the apples or the hearts? If they are the same, write same.



Task card 12 Comparing Groups of Objects

Which group has fewer: the stars or the balls? If they are the same, write same.



Task card 13 Comparing Groups of Objects

Which group has more: the hearts or the balloons? If they are the same, write same.



Task card 14 Comparing Groups of Objects

Which group has fewer: the hearts or the stars? If they are the same, write same.



Task card 15 Comparing Groups of Objects

Which group has more: the balls or the hearts? If they are the same, write same.



Task card 16 Comparing Groups of Objects

Which group has fewer: the balloons or the apples? If they are the same, write same.

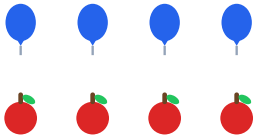

Task card 17 Comparing Groups of Objects

Which group has more: the balloons or the apples? If they are the same, write same.

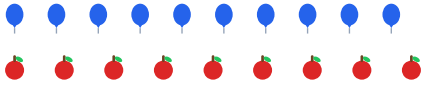

Task card 18 Comparing Groups of Objects

Which group has fewer: the balloons or the apples? If they are the same, write same.

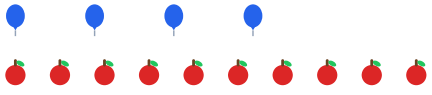

Task card 19 Comparing Groups of Objects

Which group has more: the apples or the hearts? If they are the same, write same.



Task card 20 Comparing Groups of Objects

Which group has fewer: the apples or the stars? If they are the same, write same.



Task card 21 Comparing Groups of Objects

Which group has more: the hearts or the stars? If they are the same, write same.



Task card 22 Comparing Groups of Objects

Which group has fewer: the apples or the balls? If they are the same, write same.

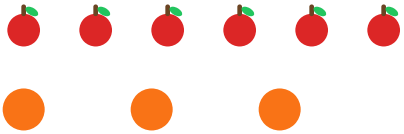

Task card 23 Comparing Groups of Objects

Which group has more: the hearts or the balls? If they are the same, write same.



Task card 24 Comparing Groups of Objects

Which group has more: the apples or the balloons? If they are the same, write same.

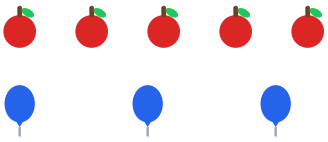

Comparing Groups of Objects Task Cards

Recording sheet · Kindergarten · Count both groups. Write the name of the group, or write same.

Name: _____ Date: _____

Scan to check your answers

1	2	3	4
5	6	7	8
9	10	11	12
13	14	15	16
17	18	19	20
21	22	23	24

Comparing Groups of Objects Task Cards: Answer Key

Kindergarten · Medium

The answers online

1. balls	**2.** balls	**3.** balls
4. same	**5.** stars	**6.** stars
7. hearts	**8.** same	**9.** balloons
10. hearts	**11.** hearts	**12.** same
13. balloons	**14.** stars	**15.** hearts
16. same	**17.** balloons	**18.** balloons
19. hearts	**20.** same	**21.** hearts
22. balls	**23.** balls	**24.** apples