Comparing Groups of Objects · 1

Which group has more: the balls or the balloons? If they are the same, write same.



Comparing Groups of Objects · 2

Which group has fewer: the apples or the balls? If they are the same, write same.



Comparing Groups of Objects · 3

Which group has more: the apples or the balls? If they are the same, write same.



Comparing Groups of Objects · 4

Which group has fewer: the stars or the balloons? If they are the same, write same.



Comparing Groups of Objects · 5

Which group has more: the stars or the balls? If they are the same, write same.



Comparing Groups of Objects · 6

Which group has fewer: the balls or the stars? If they are the same, write same.



Comparing Groups of Objects · 7

Which group has more: the apples or the hearts? If they are the same, write same.



Comparing Groups of Objects · 8

Which group has fewer: the balls or the hearts? If they are the same, write same.



Comparing Groups of Objects · 2

ANSWER

balls

Comparing Groups of Objects · 1

ANSWER

balls

Comparing Groups of Objects · 4

ANSWER

same

Comparing Groups of Objects · 3

ANSWER

balls

Comparing Groups of Objects · 6

ANSWER

stars

Comparing Groups of Objects · 5

ANSWER

stars

Comparing Groups of Objects · 8

ANSWER

same

Comparing Groups of Objects · 7

ANSWER

hearts

Comparing Groups of Objects · 9

Which group has more: the balloons or the stars? If they are the same, write same.



Comparing Groups of Objects · 10

Which group has fewer: the apples or the hearts? If they are the same, write same.



Comparing Groups of Objects · 11

Which group has more: the apples or the hearts? If they are the same, write same.



Comparing Groups of Objects · 12

Which group has fewer: the stars or the balls? If they are the same, write same.



Comparing Groups of Objects · 13

Which group has more: the hearts or the balloons? If they are the same, write same.



Comparing Groups of Objects · 14

Which group has fewer: the hearts or the stars? If they are the same, write same.



Comparing Groups of Objects · 15

Which group has more: the balls or the hearts? If they are the same, write same.



Comparing Groups of Objects · 16

Which group has fewer: the balloons or the apples? If they are the same, write same.

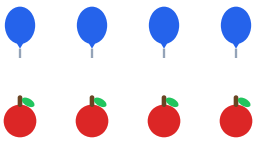

Comparing Groups of Objects · 10

ANSWER

hearts

Comparing Groups of Objects · 9

ANSWER

balloons

Comparing Groups of Objects · 12

ANSWER

same

Comparing Groups of Objects · 11

ANSWER

hearts

Comparing Groups of Objects · 14

ANSWER

stars

Comparing Groups of Objects · 13

ANSWER

balloons

Comparing Groups of Objects · 16

ANSWER

same

Comparing Groups of Objects · 15

ANSWER

hearts

Comparing Groups of Objects · 17

Which group has more: the balloons or the apples? If they are the same, write same.

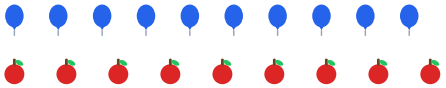

Comparing Groups of Objects · 18

Which group has fewer: the balloons or the apples? If they are the same, write same.

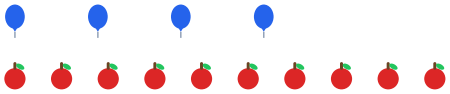

Comparing Groups of Objects · 19

Which group has more: the apples or the hearts? If they are the same, write same.



Comparing Groups of Objects · 20

Which group has fewer: the apples or the stars? If they are the same, write same.



Comparing Groups of Objects · 21

Which group has more: the hearts or the stars? If they are the same, write same.



Comparing Groups of Objects · 22

Which group has fewer: the apples or the balls? If they are the same, write same.

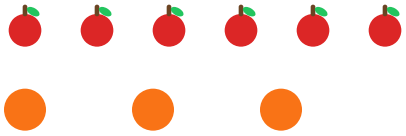

Comparing Groups of Objects · 23

Which group has more: the hearts or the balls? If they are the same, write same.



Comparing Groups of Objects · 24

Which group has more: the apples or the balloons? If they are the same, write same.

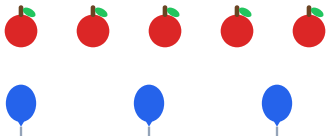

Comparing Groups of Objects · 18

ANSWER

balloons

Comparing Groups of Objects · 17

ANSWER

balloons

Comparing Groups of Objects · 20

ANSWER

same

Comparing Groups of Objects · 19

ANSWER

hearts

Comparing Groups of Objects · 22

ANSWER

balls

Comparing Groups of Objects · 21

ANSWER

hearts

Comparing Groups of Objects · 24

ANSWER

apples

Comparing Groups of Objects · 23

ANSWER

balls