**Task card 1** Coins: Penny, Nickel, Dime & Quart...

How many cents are these nickels worth?




**Task card 2** Coins: Penny, Nickel, Dime & Quart...

What is the name of this coin? Write penny, nickel, dime or quarter.




**Task card 3** Coins: Penny, Nickel, Dime & Quart...

How many cents are these pennies worth?




**Task card 4** Coins: Penny, Nickel, Dime & Quart...

Which coin is worth more, a penny or a dime?

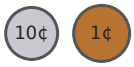


**Task card 5** Coins: Penny, Nickel, Dime & Quart...

How many cents are these nickels worth?




**Task card 6** Coins: Penny, Nickel, Dime & Quart...

How many cents is a dime worth?

**Task card 7** Coins: Penny, Nickel, Dime & Quart...

How many cents are these pennies worth?




**Task card 8** Coins: Penny, Nickel, Dime & Quart...

How many cents are these nickels worth?




**Task card 9** Coins: Penny, Nickel, Dime & Quart...

How many cents are these dimes worth?




**Task card 10** Coins: Penny, Nickel, Dime & Quart...

What is the name of this coin? Write penny, nickel, dime or quarter.




**Task card 11** Coins: Penny, Nickel, Dime & Quart...

Which coin is worth more, a quarter or a dime?

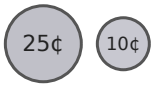


**Task card 12** Coins: Penny, Nickel, Dime & Quart...

How many cents are these dimes worth?

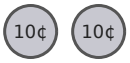

**Task card 13** Coins: Penny, Nickel, Dime & Quart...

How many cents are these pennies worth?




**Task card 14** Coins: Penny, Nickel, Dime & Quart...

How many cents is a nickel worth?

**Task card 15** Coins: Penny, Nickel, Dime & Quart...

How many cents in all?




**Task card 16** Coins: Penny, Nickel, Dime & Quart...

How many cents are these dimes worth?




**Task card 17** Coins: Penny, Nickel, Dime & Quart...

Which coin is worth more, a dime or a quarter?

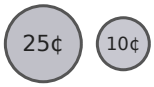


**Task card 18** Coins: Penny, Nickel, Dime & Quart...

How many cents in all?



**Task card 19** Coins: Penny, Nickel, Dime & Quart...

How many cents are these dimes worth?

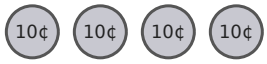


**Task card 20** Coins: Penny, Nickel, Dime & Quart...

How many pennies make 1 nickel?




**Task card 21** Coins: Penny, Nickel, Dime & Quart...

What is the name of this coin? Write penny, nickel, dime or quarter.




**Task card 22** Coins: Penny, Nickel, Dime & Quart...

How many cents are these pennies worth?




**Task card 23** Coins: Penny, Nickel, Dime & Quart...

Which coin is worth more, a dime or a nickel?




**Task card 24** Coins: Penny, Nickel, Dime & Quart...

How many cents is a quarter worth?

# Coins: Penny, Nickel, Dime & Quarter Task Cards

Recording sheet · Kindergarten · Look at the coins. Write a number of cents, or the name of a coin (penny, nickel, dime or quarter).

Scan to check your answers

Name: _____ Date: _____

| | | | |
|---|---|---|---|
| 1 | 2 | 3 | 4 |
| 5 | 6 | 7 | 8 |
| 9 | 10 | 11 | 12 |
| 13 | 14 | 15 | 16 |
| 17 | 18 | 19 | 20 |
| 21 | 22 | 23 | 24 |

# Coins: Penny, Nickel, Dime & Quarter Task Cards: Answer Key

Kindergarten · Medium

The answers online

| | | |
|---|---|---|
| **1.** 10 | **2.** penny | **3.** 3 |
| **4.** dime | **5.** 15 | **6.** 10 |
| **7.** 4 | **8.** 20 | **9.** 30 |
| **10.** nickel | **11.** quarter | **12.** 20 |
| **13.** 8 | **14.** 5 | **15.** 16 |
| **16.** 50 | **17.** quarter | **18.** 12 |
| **19.** 40 | **20.** 5 | **21.** dime |
| **22.** 2 | **23.** dime | **24.** 25 |