Task card 1 Coins: Penny, Nickel, Dime & Quart...

How many cents in all?



Task card 2 Coins: Penny, Nickel, Dime & Quart...

How many cents are these nickels worth?



Task card 3 Coins: Penny, Nickel, Dime & Quart...

How many pennies make 1 dime?



Task card 4 Coins: Penny, Nickel, Dime & Quart...

How many cents are these dimes worth?

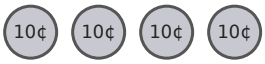

Task card 5 Coins: Penny, Nickel, Dime & Quart...

Which coin is worth more, a penny or a nickel?

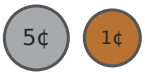

Task card 6 Coins: Penny, Nickel, Dime & Quart...

How many cents in all?

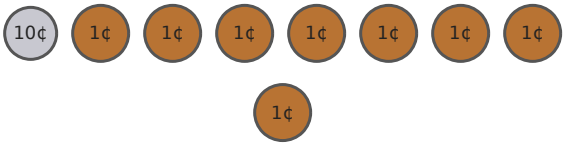

Task card 7 Coins: Penny, Nickel, Dime & Quart...

How many pennies make 1 nickel?



Task card 8 Coins: Penny, Nickel, Dime & Quart...

What is the name of this coin? Write penny, nickel, dime or quarter.



Task card 9 Coins: Penny, Nickel, Dime & Quart...

How many cents in all?



Task card 10 Coins: Penny, Nickel, Dime & Quart...

How many cents are these dimes worth?



Task card 11 Coins: Penny, Nickel, Dime & Quart...

How many cents are these nickels worth?



Task card 12 Coins: Penny, Nickel, Dime & Quart...

How many cents in all?



Task card 13 Coins: Penny, Nickel, Dime & Quart...

Which coin is worth more, a quarter or a dime?

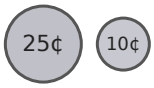

Task card 14 Coins: Penny, Nickel, Dime & Quart...

How many cents are these dimes worth?



Task card 15 Coins: Penny, Nickel, Dime & Quart...

How many cents in all?

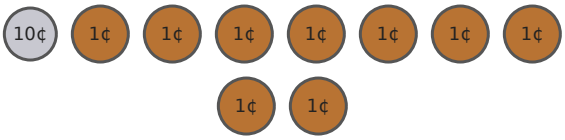

Task card 16 Coins: Penny, Nickel, Dime & Quart...

How many cents in all?



Task card 17 Coins: Penny, Nickel, Dime & Quart...

How many cents in all?



Task card 18 Coins: Penny, Nickel, Dime & Quart...

Which coin is worth more, a nickel or a quarter?



Task card 19 Coins: Penny, Nickel, Dime & Quart...

How many cents in all?



Task card 20 Coins: Penny, Nickel, Dime & Quart...

How many cents are these nickels worth?



Task card 21 Coins: Penny, Nickel, Dime & Quart...

What is the name of this coin? Write penny, nickel, dime or quarter.



Task card 22 Coins: Penny, Nickel, Dime & Quart...

How many cents are these dimes worth?

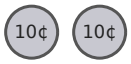

Task card 23 Coins: Penny, Nickel, Dime & Quart...

How many cents in all?



Task card 24 Coins: Penny, Nickel, Dime & Quart...

Which coin is worth more, a dime or a nickel?



Coins: Penny, Nickel, Dime & Quarter Task Cards

Recording sheet · Kindergarten · Look at the coins. Write a number of cents, or the name of a coin (penny, nickel, dime or quarter).

Scan to check your answers

Name: _____ Date: _____

1	2	3	4
5	6	7	8
9	10	11	12
13	14	15	16
17	18	19	20
21	22	23	24

Coins: Penny, Nickel, Dime & Quarter Task Cards: Answer Key

Kindergarten · Hard

The answers online

1. 16	**2.** 20	**3.** 10
4. 40	**5.** nickel	**6.** 18
7. 5	**8.** dime	**9.** 17
10. 30	**11.** 15	**12.** 12
13. quarter	**14.** 50	**15.** 19
16. 11	**17.** 13	**18.** quarter
19. 14	**20.** 10	**21.** nickel
22. 20	**23.** 15	**24.** dime