Task card 1 Coins: Penny, Nickel, Dime & Quart...

How many cents are these pennies worth?



Task card 2 Coins: Penny, Nickel, Dime & Quart...

How many cents are these pennies worth?



Task card 3 Coins: Penny, Nickel, Dime & Quart...

How many cents is a dime worth?

Task card 4 Coins: Penny, Nickel, Dime & Quart...

How many cents are these pennies worth?



Task card 5 Coins: Penny, Nickel, Dime & Quart...

How many cents are these pennies worth?



Task card 6 Coins: Penny, Nickel, Dime & Quart...

How many cents is a quarter worth?

Task card 7 Coins: Penny, Nickel, Dime & Quart...

What is the name of this coin? Write penny, nickel, dime or quarter.



Task card 8 Coins: Penny, Nickel, Dime & Quart...

How many cents are these pennies worth?



Task card 9 Coins: Penny, Nickel, Dime & Quart...

How many cents is a penny worth?

Task card 10 Coins: Penny, Nickel, Dime & Quart...

What is the name of this coin? Write penny, nickel, dime or quarter.



Task card 11 Coins: Penny, Nickel, Dime & Quart...

How many cents are these pennies worth?

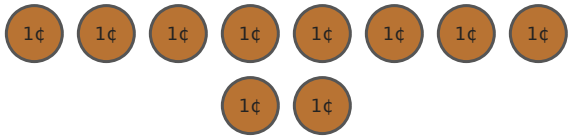

Task card 12 Coins: Penny, Nickel, Dime & Quart...

How many cents are these pennies worth?



Task card 13 Coins: Penny, Nickel, Dime & Quart...

How many cents are these pennies worth?

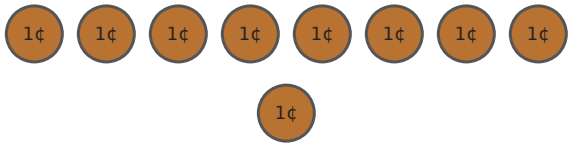

Task card 14 Coins: Penny, Nickel, Dime & Quart...

Which coin is worth more, a nickel or a dime?



Task card 15 Coins: Penny, Nickel, Dime & Quart...

How many cents is a nickel worth?

Task card 16 Coins: Penny, Nickel, Dime & Quart...

What is the name of this coin? Write penny, nickel, dime or quarter.



Task card 17 Coins: Penny, Nickel, Dime & Quart...

Which coin is worth more, a penny or a nickel?

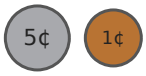

Task card 18 Coins: Penny, Nickel, Dime & Quart...

What is the name of this coin? Write penny, nickel, dime or quarter.



Task card 19 Coins: Penny, Nickel, Dime & Quart...

Which coin is worth more, a dime or a nickel?



Task card 20 Coins: Penny, Nickel, Dime & Quart...

Which coin is worth more, a quarter or a dime?

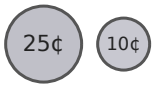

Task card 21 Coins: Penny, Nickel, Dime & Quart...

Which coin is worth more, a nickel or a penny?

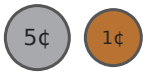

Coins: Penny, Nickel, Dime & Quarter Task Cards

Recording sheet · Kindergarten · Look at the coins. Write a number of cents, or the name of a coin (penny, nickel, dime or quarter).

Scan to check your answers

Name: _____ Date: _____

1	2	3	4
5	6	7	8
9	10	11	12
13	14	15	16
17	18	19	20
21			

Coins: Penny, Nickel, Dime & Quarter Task Cards: Answer Key

Kindergarten · Easy

The answers online

1. 5	**2.** 2	**3.** 10
4. 4	**5.** 3	**6.** 25
7. quarter	**8.** 7	**9.** 1
10. dime	**11.** 10	**12.** 8
13. 9	**14.** dime	**15.** 5
16. penny	**17.** nickel	**18.** nickel
19. dime	**20.** quarter	**21.** nickel