Coins: Penny, Nickel, Dime & Quarter · 1

How many cents are these nickels worth?



Coins: Penny, Nickel, Dime & Quarter · 2

What is the name of this coin? Write penny, nickel, dime or quarter.



Coins: Penny, Nickel, Dime & Quarter · 3

How many cents are these pennies worth?



Coins: Penny, Nickel, Dime & Quarter · 4

Which coin is worth more, a penny or a dime?



Coins: Penny, Nickel, Dime & Quarter · 5

How many cents are these nickels worth?



Coins: Penny, Nickel, Dime & Quarter · 6

How many cents is a dime worth?

Coins: Penny, Nickel, Dime & Quarter · 7

How many cents are these pennies worth?



Coins: Penny, Nickel, Dime & Quarter · 8

How many cents are these nickels worth?



Coins: Penny, Nickel, Dime & Quarter · 2

ANSWER

penny

Coins: Penny, Nickel, Dime & Quarter · 1

ANSWER

10

Coins: Penny, Nickel, Dime & Quarter · 4

ANSWER

dime

Coins: Penny, Nickel, Dime & Quarter · 3

ANSWER

3

Coins: Penny, Nickel, Dime & Quarter · 6

ANSWER

10

Coins: Penny, Nickel, Dime & Quarter · 5

ANSWER

15

Coins: Penny, Nickel, Dime & Quarter · 8

ANSWER

20

Coins: Penny, Nickel, Dime & Quarter · 7

ANSWER

4

How many cents are these dimes worth?



What is the name of this coin? Write penny, nickel, dime or quarter.



Which coin is worth more, a quarter or a dime?

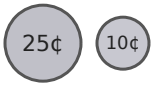

How many cents are these dimes worth?

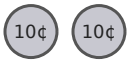

How many cents are these pennies worth?



How many cents is a nickel worth?

How many cents in all?



How many cents are these dimes worth?



Coins: Penny, Nickel, Dime & Quarter · 10

ANSWER

nickel

Coins: Penny, Nickel, Dime & Quarter · 9

ANSWER

30

Coins: Penny, Nickel, Dime & Quarter · 12

ANSWER

20

Coins: Penny, Nickel, Dime & Quarter · 11

ANSWER

quarter

Coins: Penny, Nickel, Dime & Quarter · 14

ANSWER

5

Coins: Penny, Nickel, Dime & Quarter · 13

ANSWER

8

Coins: Penny, Nickel, Dime & Quarter · 16

ANSWER

50

Coins: Penny, Nickel, Dime & Quarter · 15

ANSWER

16

Which coin is worth more, a dime or a quarter?

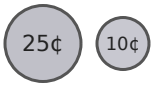

How many cents in all?



How many cents are these dimes worth?

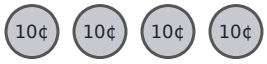

How many pennies make 1 nickel?



What is the name of this coin? Write penny, nickel, dime or quarter.



How many cents are these pennies worth?



Which coin is worth more, a dime or a nickel?



How many cents is a quarter worth?

Coins: Penny, Nickel, Dime & Quarter · 18

ANSWER

12

Coins: Penny, Nickel, Dime & Quarter · 17

ANSWER

quarter

Coins: Penny, Nickel, Dime & Quarter · 20

ANSWER

5

Coins: Penny, Nickel, Dime & Quarter · 19

ANSWER

40

Coins: Penny, Nickel, Dime & Quarter · 22

ANSWER

2

Coins: Penny, Nickel, Dime & Quarter · 21

ANSWER

dime

Coins: Penny, Nickel, Dime & Quarter · 24

ANSWER

25

Coins: Penny, Nickel, Dime & Quarter · 23

ANSWER

dime