Back to School Math · 1

How many pencils are there?



Back to School Math · 2

Ben has 1 book. Lily brings 4 more. How many books are there now?



Back to School Math · 3

Ella has 3 pencils. Ella gives 1 to Ben. How many pencils does Ella have left?



Back to School Math · 4

How many apples are there?



Back to School Math · 5

Ben has 2 apples. Zoe brings 1 more. How many apples are there now?



Back to School Math · 6

Ella has 3 books. Ella gives 1 to Lily. How many books does Ella have left?



Back to School Math · 7

How many pencils are there?



Back to School Math · 8

Zoe has 3 apples. Mia brings 2 more. How many apples are there now?



Back to School Math · 2

ANSWER

5

Back to School Math · 1

ANSWER

5

Back to School Math · 4

ANSWER

3

Back to School Math · 3

ANSWER

2

Back to School Math · 6

ANSWER

2

Back to School Math · 5

ANSWER

3

Back to School Math · 8

ANSWER

5

Back to School Math · 7

ANSWER

3

Back to School Math · 9

Noah has 4 pencils. Mia brings 2 more. How many pencils are there now?



Back to School Math · 10

Ella has 4 pencils. Ella gives 1 to Omar. How many pencils does Ella have left?



Back to School Math · 11

Ella has 4 apples. Ella gives 3 to Mia. How many apples does Ella have left?



Back to School Math · 12

How many pencils are there?



Back to School Math · 13

Noah has 1 apple. Leo brings 5 more. How many apples are there now?



Back to School Math · 14

Leo has 3 apples. Ella brings 3 more. How many apples are there now?



Back to School Math · 15

Omar has 3 books. Ben brings 3 more. How many books are there now?



Back to School Math · 16

Zoe has 3 pencils. Zoe gives 2 to Omar. How many pencils does Zoe have left?



Back to School Math · 10

ANSWER

3

Back to School Math · 9

ANSWER

6

Back to School Math · 12

ANSWER

4

Back to School Math · 11

ANSWER

1

Back to School Math · 14

ANSWER

6

Back to School Math · 13

ANSWER

6

Back to School Math · 16

ANSWER

1

Back to School Math · 15

ANSWER

6

Back to School Math · 17

Lily has 3 pencils. Lily gives 2 to Ava. How many pencils does Lily have left?



Back to School Math · 18

Omar has 3 pencils. Omar gives 1 to Zoe. How many pencils does Omar have left?



Back to School Math · 19

Sam has 4 pencils. Lily brings 2 more. How many pencils are there now?



Back to School Math · 20

Lily has 4 pencils. Sam brings 3 more. How many pencils are there now?



Back to School Math · 21

Leo has 2 pencils. Omar brings 2 more. How many pencils are there now?



Back to School Math · 22

Ella has 5 apples. Ella gives 1 to Sam. How many apples does Ella have left?



Back to School Math · 23

Lily has 2 apples. Leo brings 2 more. How many apples are there now?



Back to School Math · 24

How many books are there?



Back to School Math · 18

ANSWER

2

Back to School Math · 17

ANSWER

1

Back to School Math · 20

ANSWER

7

Back to School Math · 19

ANSWER

6

Back to School Math · 22

ANSWER

4

Back to School Math · 21

ANSWER

4

Back to School Math · 24

ANSWER

4

Back to School Math · 23

ANSWER

4