Task card 1 100th Day of School Math

Zoe has 3 stars. Zoe gives 1 to Sam. How many stars does Zoe have left?



Task card 2 100th Day of School Math

Noah has 6 pencils. Omar brings 2 more. How many pencils are there now?



Task card 3 100th Day of School Math

How many pencils are there?



Task card 4 100th Day of School Math

Leo has 5 stars. Leo gives 3 to Lily. How many stars does Leo have left?



Task card 5 100th Day of School Math

How many stars are there?



Task card 6 100th Day of School Math

Mia has 2 balloons. Noah brings 2 more. How many balloons are there now?



Task card 7 100th Day of School Math

How many stars are there?



Task card 8 100th Day of School Math

Ben has 6 balloons. Omar brings 2 more. How many balloons are there now?



Task card 9 100th Day of School Math

Ella has 6 balloons. Lily brings 2 more. How many balloons are there now?



Task card 10 100th Day of School Math

How many balloons are there?



Task card 11 100th Day of School Math

How many balloons are there?



Task card 12 100th Day of School Math

How many stars are there?



Task card 13 100th Day of School Math

Sam has 5 pencils. Ava brings 4 more. How many pencils are there now?



Task card 14 100th Day of School Math

Lily has 5 stars. Noah brings 4 more. How many stars are there now?



Task card 15 100th Day of School Math

Omar has 6 balloons. Omar gives 1 to Lily. How many balloons does Omar have left?



Task card 16 100th Day of School Math

Ella has 4 pencils. Ella gives 2 to Zoe. How many pencils does Ella have left?



Task card 17 100th Day of School Math

How many stars are there?



Task card 18 100th Day of School Math

How many stars are there?



Task card 19 100th Day of School Math

Lily has 2 stars. Zoe brings 1 more. How many stars are there now?



Task card 20 100th Day of School Math

Ella has 3 balloons. Zoe brings 6 more. How many balloons are there now?



Task card 21 100th Day of School Math

How many stars are there?



Task card 22 100th Day of School Math

Leo has 5 balloons. Leo gives 2 to Ava. How many balloons does Leo have left?



Task card 23 100th Day of School Math

Leo has 2 stars. Omar brings 4 more. How many stars are there now?



Task card 24 100th Day of School Math

Ben has 5 balloons. Ben gives 1 to Lily. How many balloons does Ben have left?



100th Day of School Math Task Cards

Recording sheet · Kindergarten · Count the pictures and solve each story.

Name: _____ Date: _____

Scan to check your answers

1	2	3	4
5	6	7	8
9	10	11	12
13	14	15	16
17	18	19	20
21	22	23	24

100th Day of School Math Task Cards: Answer Key

Kindergarten · Hard

The answers online

1. 2	**2.** 8	**3.** 6
4. 2	**5.** 8	**6.** 4
7. 6	**8.** 8	**9.** 8
10. 6	**11.** 3	**12.** 5
13. 9	**14.** 9	**15.** 5
16. 2	**17.** 3	**18.** 10
19. 3	**20.** 9	**21.** 9
22. 3	**23.** 6	**24.** 4