100th Day of School Math · 1

Zoe has 3 stars. Zoe gives 1 to Sam. How many stars does Zoe have left?



100th Day of School Math · 2

Noah has 6 pencils. Omar brings 2 more. How many pencils are there now?



100th Day of School Math · 3

How many pencils are there?



100th Day of School Math · 4

Leo has 5 stars. Leo gives 3 to Lily. How many stars does Leo have left?



100th Day of School Math · 5

How many stars are there?



100th Day of School Math · 6

Mia has 2 balloons. Noah brings 2 more. How many balloons are there now?



100th Day of School Math · 7

How many stars are there?



100th Day of School Math · 8

Ben has 6 balloons. Omar brings 2 more. How many balloons are there now?



100th Day of School Math · 2

ANSWER

8

100th Day of School Math · 1

ANSWER

2

100th Day of School Math · 4

ANSWER

2

100th Day of School Math · 3

ANSWER

6

100th Day of School Math · 6

ANSWER

4

100th Day of School Math · 5

ANSWER

8

100th Day of School Math · 8

ANSWER

8

100th Day of School Math · 7

ANSWER

6

100th Day of School Math · 9

Ella has 6 balloons. Lily brings 2 more. How many balloons are there now?



100th Day of School Math · 10

How many balloons are there?



100th Day of School Math · 11

How many balloons are there?



100th Day of School Math · 12

How many stars are there?



100th Day of School Math · 13

Sam has 5 pencils. Ava brings 4 more. How many pencils are there now?



100th Day of School Math · 14

Lily has 5 stars. Noah brings 4 more. How many stars are there now?



100th Day of School Math · 15

Omar has 6 balloons. Omar gives 1 to Lily. How many balloons does Omar have left?



100th Day of School Math · 16

Ella has 4 pencils. Ella gives 2 to Zoe. How many pencils does Ella have left?



100th Day of School Math · 10

ANSWER

6

100th Day of School Math · 9

ANSWER

8

100th Day of School Math · 12

ANSWER

5

100th Day of School Math · 11

ANSWER

3

100th Day of School Math · 14

ANSWER

9

100th Day of School Math · 13

ANSWER

9

100th Day of School Math · 16

ANSWER

2

100th Day of School Math · 15

ANSWER

5

100th Day of School Math · 17

How many stars are there?



100th Day of School Math · 18

How many stars are there?



100th Day of School Math · 19

Lily has 2 stars. Zoe brings 1 more. How many stars are there now?



100th Day of School Math · 20

Ella has 3 balloons. Zoe brings 6 more. How many balloons are there now?



100th Day of School Math · 21

How many stars are there?



100th Day of School Math · 22

Leo has 5 balloons. Leo gives 2 to Ava. How many balloons does Leo have left?



100th Day of School Math · 23

Leo has 2 stars. Omar brings 4 more. How many stars are there now?



100th Day of School Math · 24

Ben has 5 balloons. Ben gives 1 to Lily. How many balloons does Ben have left?



100th Day of School Math · 18

ANSWER

10

100th Day of School Math · 17

ANSWER

3

100th Day of School Math · 20

ANSWER

9

100th Day of School Math · 19

ANSWER

3

100th Day of School Math · 22

ANSWER

3

100th Day of School Math · 21

ANSWER

9

100th Day of School Math · 24

ANSWER

4

100th Day of School Math · 23

ANSWER

6