Slope & Graphing Linear Equations · 1

Find the slope of the line through A(2, 1) and B(7, -29).

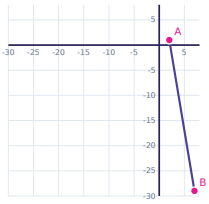

Slope & Graphing Linear Equations · 2

A line has a slope of 1 and passes through the point (-5,10). Find the y-intercept.

Slope & Graphing Linear Equations · 3

Find the slope of the line through A(9, -9) and B(10, -14).

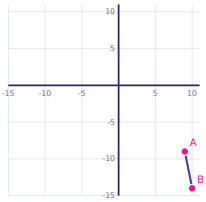

Slope & Graphing Linear Equations · 4

Find the slope of the line through A(2, -2) and B(7, -17).

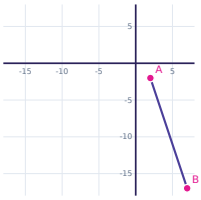

Slope & Graphing Linear Equations · 5

A line has a slope of -6 and passes through the point (2,-26). Find the y-intercept.

Slope & Graphing Linear Equations · 6

Find the slope of the line through A(-1, -9) and B(5, 21).

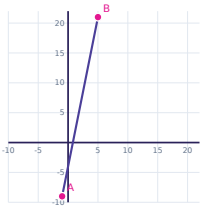

Slope & Graphing Linear Equations · 7

Find the slope of the line through A(-6, 4) and B(-2, 0).

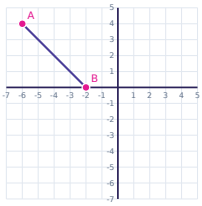

Slope & Graphing Linear Equations · 8

A line has a slope of 2 and passes through the point (-5,-17). Find the y-intercept.

Slope & Graphing Linear Equations · 2

ANSWER

15

Slope & Graphing Linear Equations · 1

ANSWER

-6

Slope & Graphing Linear Equations · 4

ANSWER

-3

Slope & Graphing Linear Equations · 3

ANSWER

-5

Slope & Graphing Linear Equations · 6

ANSWER

5

Slope & Graphing Linear Equations · 5

ANSWER

-14

Slope & Graphing Linear Equations · 8

ANSWER

-7

Slope & Graphing Linear Equations · 7

ANSWER

-1

Slope & Graphing Linear Equations · 9

Find the slope of the line through A(7, 7) and B(13, -35).

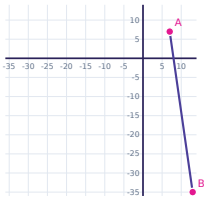

Slope & Graphing Linear Equations · 10

Find the slope of the line through A(-6, 2) and B(0, 26).

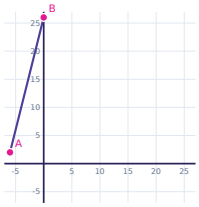

Slope & Graphing Linear Equations · 11

A line has a slope of 7 and passes through the point (8,69). Find the y-intercept.

Slope & Graphing Linear Equations · 12

Find the slope of the line through A(-3, 1) and B(2, -24).

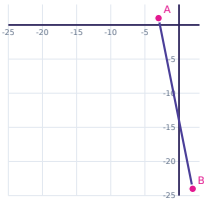

Slope & Graphing Linear Equations · 13

Find the slope of the line through A(7, -9) and B(12, 11).

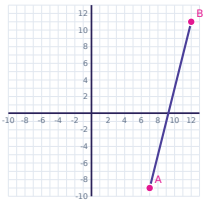

Slope & Graphing Linear Equations · 14

A line has a slope of -1 and passes through the point (0,5). Find the y-intercept.

Slope & Graphing Linear Equations · 15

Find the slope of the line through A(8, 0) and B(13, -40).

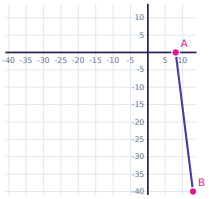

Slope & Graphing Linear Equations · 16

Find the slope of the line through A(1, 0) and B(2, 8).

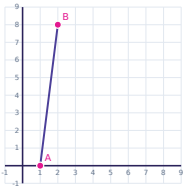

Slope & Graphing Linear Equations · 10

ANSWER

4

Slope & Graphing Linear Equations · 9

ANSWER

-7

Slope & Graphing Linear Equations · 12

ANSWER

-5

Slope & Graphing Linear Equations · 11

ANSWER

13

Slope & Graphing Linear Equations · 14

ANSWER

5

Slope & Graphing Linear Equations · 13

ANSWER

4

Slope & Graphing Linear Equations · 16

ANSWER

8

Slope & Graphing Linear Equations · 15

ANSWER

-8

Slope & Graphing Linear Equations · 17

A line has a slope of -5 and passes through the point (-4,5). Find the y-intercept.

Slope & Graphing Linear Equations · 18

Find the slope of the line through A(0, 5) and B(5, -20).

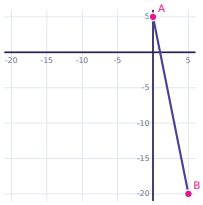

Slope & Graphing Linear Equations · 19

Find the slope of the line through A(-10, 6) and B(-4, -18).

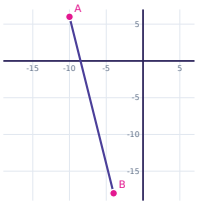

Slope & Graphing Linear Equations · 20

A line has a slope of -5 and passes through the point (3,-27). Find the y-intercept.

Slope & Graphing Linear Equations · 21

Find the slope of the line through A(-3, -6) and B(0, 0).

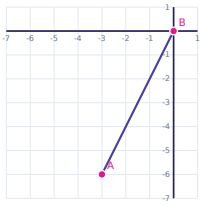

Slope & Graphing Linear Equations · 22

Find the slope of the line through A(-8, -3) and B(-7, 0).

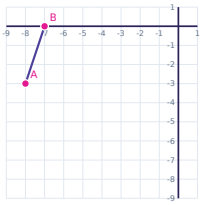

Slope & Graphing Linear Equations · 23

A line has a slope of 6 and passes through the point (-9,-63). Find the y-intercept.

Slope & Graphing Linear Equations · 24

Find the slope of the line through A(10, 4) and B(13, 22).

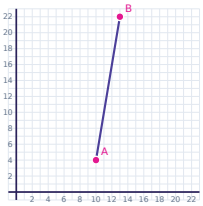

Slope & Graphing Linear Equations · 18

ANSWER

-5

Slope & Graphing Linear Equations · 17

ANSWER

-15

Slope & Graphing Linear Equations · 20

ANSWER

-12

Slope & Graphing Linear Equations · 19

ANSWER

-4

Slope & Graphing Linear Equations · 22

ANSWER

3

Slope & Graphing Linear Equations · 21

ANSWER

2

Slope & Graphing Linear Equations · 24

ANSWER

6

Slope & Graphing Linear Equations · 23

ANSWER

-9