Slope & Graphing Linear Equations · 1

Find the slope of the line through A(4, 6) and B(7, -18).

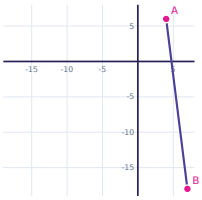

Slope & Graphing Linear Equations · 2

A line has a slope of -3 and passes through the point (4,-2). Find the y-intercept.

Slope & Graphing Linear Equations · 3

Find the slope of the line through A(6, -10) and B(9, -19).

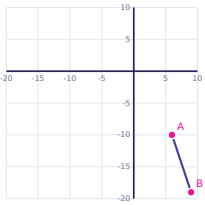

Slope & Graphing Linear Equations · 4

Find the slope of the line through A(-7, -3) and B(-1, -21).

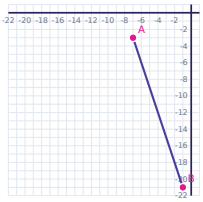

Slope & Graphing Linear Equations · 5

A line has a slope of 7 and passes through the point (0,0). Find the y-intercept.

Slope & Graphing Linear Equations · 6

Find the slope of the line through A(9, 8) and B(14, -17).

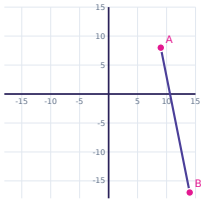

Slope & Graphing Linear Equations · 7

Find the slope of the line through A(-3, -3) and B(-1, 3).

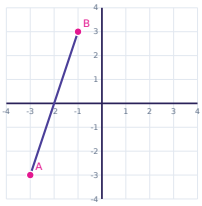

Slope & Graphing Linear Equations · 8

A line has a slope of 1 and passes through the point (-2,13). Find the y-intercept.

Slope & Graphing Linear Equations · 2

ANSWER

10

Slope & Graphing Linear Equations · 1

ANSWER

-8

Slope & Graphing Linear Equations · 4

ANSWER

-3

Slope & Graphing Linear Equations · 3

ANSWER

-3

Slope & Graphing Linear Equations · 6

ANSWER

-5

Slope & Graphing Linear Equations · 5

ANSWER

0

Slope & Graphing Linear Equations · 8

ANSWER

15

Slope & Graphing Linear Equations · 7

ANSWER

3

Slope & Graphing Linear Equations · 9

Find the slope of the line through A(2, 6) and B(5, -15).

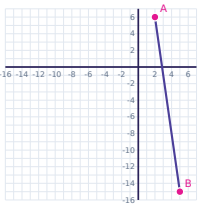

Slope & Graphing Linear Equations · 10

Find the slope of the line through A(9, -10) and B(14, -50).

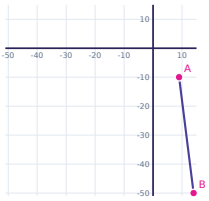

Slope & Graphing Linear Equations · 11

A line has a slope of 8 and passes through the point (10,87). Find the y-intercept.

Slope & Graphing Linear Equations · 12

Find the slope of the line through A(-9, 3) and B(-5, -1).

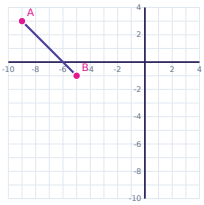

Slope & Graphing Linear Equations · 13

Find the slope of the line through A(5, 10) and B(11, 16).

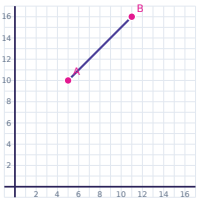

Slope & Graphing Linear Equations · 14

A line has a slope of 7 and passes through the point (8,48). Find the y-intercept.

Slope & Graphing Linear Equations · 15

Find the slope of the line through A(1, 6) and B(5, 30).

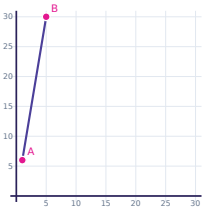

Slope & Graphing Linear Equations · 16

Find the slope of the line through A(-9, -3) and B(-8, -6).

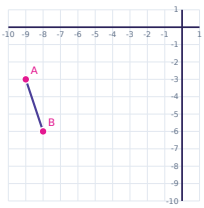

Slope & Graphing Linear Equations · 10

ANSWER

-8

Slope & Graphing Linear Equations · 9

ANSWER

-7

Slope & Graphing Linear Equations · 12

ANSWER

-1

Slope & Graphing Linear Equations · 11

ANSWER

7

Slope & Graphing Linear Equations · 14

ANSWER

-8

Slope & Graphing Linear Equations · 13

ANSWER

1

Slope & Graphing Linear Equations · 16

ANSWER

-3

Slope & Graphing Linear Equations · 15

ANSWER

6

Slope & Graphing Linear Equations · 17

A line has a slope of 1 and passes through the point (3,14). Find the y-intercept.

Slope & Graphing Linear Equations · 18

Find the slope of the line through A(-3, -3) and B(-2, -11).

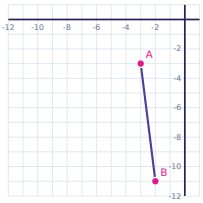

Slope & Graphing Linear Equations · 19

Find the slope of the line through A(6, -4) and B(9, -7).

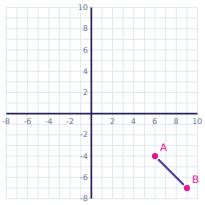

Slope & Graphing Linear Equations · 20

A line has a slope of -3 and passes through the point (-10,36). Find the y-intercept.

Slope & Graphing Linear Equations · 21

Find the slope of the line through A(9, -2) and B(10, 7).

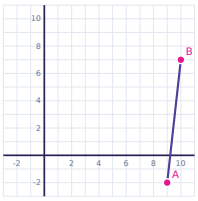

Slope & Graphing Linear Equations · 22

Find the slope of the line through A(-10, -5) and B(-6, -1).

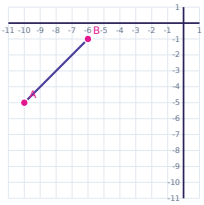

Slope & Graphing Linear Equations · 23

A line has a slope of 3 and passes through the point (-4,-27). Find the y-intercept.

Slope & Graphing Linear Equations · 24

Find the slope of the line through A(8, 4) and B(9, -4).

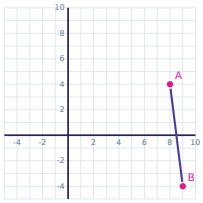

Slope & Graphing Linear Equations · 18

ANSWER

-8

Slope & Graphing Linear Equations · 17

ANSWER

11

Slope & Graphing Linear Equations · 20

ANSWER

6

Slope & Graphing Linear Equations · 19

ANSWER

-1

Slope & Graphing Linear Equations · 22

ANSWER

1

Slope & Graphing Linear Equations · 21

ANSWER

9

Slope & Graphing Linear Equations · 24

ANSWER

-8

Slope & Graphing Linear Equations · 23

ANSWER

-15