Slope & Graphing Linear Equations · 1

Find the slope of the line through A(7, -6) and B(12, 4).

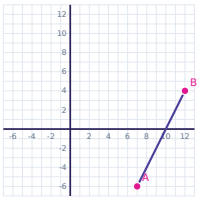

Slope & Graphing Linear Equations · 2

A line has a slope of 1 and passes through the point (6,-5). Find the y-intercept.

Slope & Graphing Linear Equations · 3

Find the slope of the line through A(-5, 0) and B(1, 6).

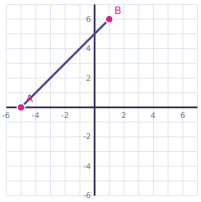

Slope & Graphing Linear Equations · 4

A line has a slope of 1 and passes through the point (9,-3). Find the y-intercept.

Slope & Graphing Linear Equations · 5

Find the slope of the line through A(7, 6) and B(13, 12).

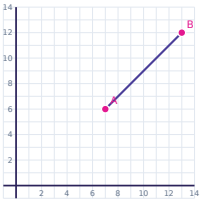

Slope & Graphing Linear Equations · 6

A line has a slope of -3 and passes through the point (-2,-5). Find the y-intercept.

Slope & Graphing Linear Equations · 7

Find the slope of the line through A(7, -5) and B(10, -2).

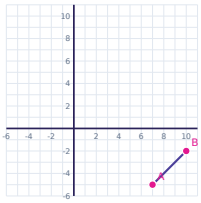

Slope & Graphing Linear Equations · 8

Find the slope of the line through A(-2, 2) and B(1, -7).

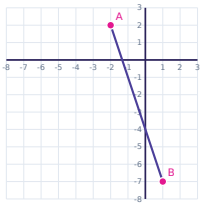

Slope & Graphing Linear Equations · 2

ANSWER

-11

Slope & Graphing Linear Equations · 1

ANSWER

2

Slope & Graphing Linear Equations · 4

ANSWER

-12

Slope & Graphing Linear Equations · 3

ANSWER

1

Slope & Graphing Linear Equations · 6

ANSWER

-11

Slope & Graphing Linear Equations · 5

ANSWER

1

Slope & Graphing Linear Equations · 8

ANSWER

-3

Slope & Graphing Linear Equations · 7

ANSWER

1

Slope & Graphing Linear Equations · 9

A line has a slope of 3 and passes through the point (10,30). Find the y-intercept.

Slope & Graphing Linear Equations · 10

Find the slope of the line through A(-2, 3) and B(0, -3).

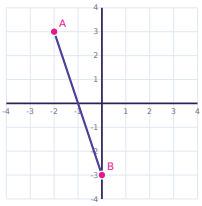

Slope & Graphing Linear Equations · 11

A line has a slope of -2 and passes through the point (-9,30). Find the y-intercept.

Slope & Graphing Linear Equations · 12

Find the slope of the line through A(-2, -8) and B(-1, -10).

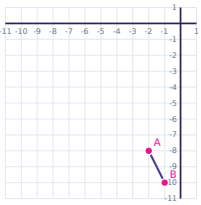

Slope & Graphing Linear Equations · 13

A line has a slope of -3 and passes through the point (6,-25). Find the y-intercept.

Slope & Graphing Linear Equations · 14

Find the slope of the line through A(6, 7) and B(11, 12).

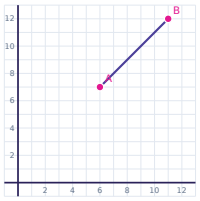

Slope & Graphing Linear Equations · 15

Find the slope of the line through A(9, 9) and B(11, 1).

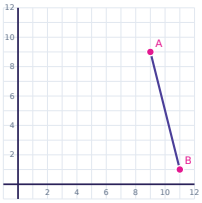

Slope & Graphing Linear Equations · 16

A line has a slope of 4 and passes through the point (-7,-21). Find the y-intercept.

Slope & Graphing Linear Equations · 10

ANSWER

-3

Slope & Graphing Linear Equations · 9

ANSWER

0

Slope & Graphing Linear Equations · 12

ANSWER

-2

Slope & Graphing Linear Equations · 11

ANSWER

12

Slope & Graphing Linear Equations · 14

ANSWER

1

Slope & Graphing Linear Equations · 13

ANSWER

-7

Slope & Graphing Linear Equations · 16

ANSWER

7

Slope & Graphing Linear Equations · 15

ANSWER

-4

Slope & Graphing Linear Equations · 17

Find the slope of the line through A(-2, -9) and B(0, -15).

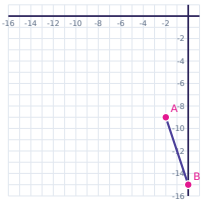

Slope & Graphing Linear Equations · 18

Find the slope of the line through A(-4, -5) and B(0, 3).

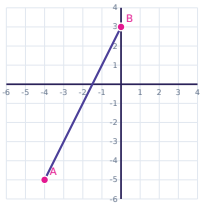

Slope & Graphing Linear Equations · 19

A line has a slope of 4 and passes through the point (6,35). Find the y-intercept.

Slope & Graphing Linear Equations · 20

Find the slope of the line through A(1, -9) and B(3, -13).

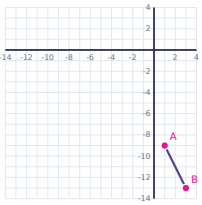

Slope & Graphing Linear Equations · 21

Find the slope of the line through A(-10, 5) and B(-8, 7).

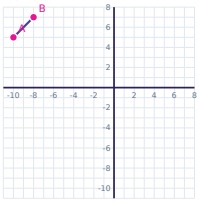

Slope & Graphing Linear Equations · 22

A line has a slope of -3 and passes through the point (4,-10). Find the y-intercept.

Slope & Graphing Linear Equations · 23

Find the slope of the line through A(-4, -1) and B(-2, 3).

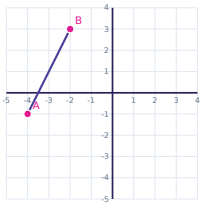

Slope & Graphing Linear Equations · 24

A line has a slope of 1 and passes through the point (5,-10). Find the y-intercept.

Slope & Graphing Linear Equations · 18

ANSWER

2

Slope & Graphing Linear Equations · 17

ANSWER

-3

Slope & Graphing Linear Equations · 20

ANSWER

-2

Slope & Graphing Linear Equations · 19

ANSWER

11

Slope & Graphing Linear Equations · 22

ANSWER

2

Slope & Graphing Linear Equations · 21

ANSWER

1

Slope & Graphing Linear Equations · 24

ANSWER

-15

Slope & Graphing Linear Equations · 23

ANSWER

2