Task card 1 Function Notation with Graphs & Ta...

The graph shows y = f(x). Find f(0).

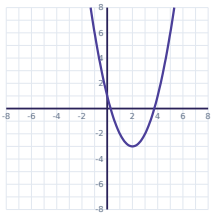

Task card 2 Function Notation with Graphs & Ta...

The graph shows y = f(x). Find x when f(x) = 3.

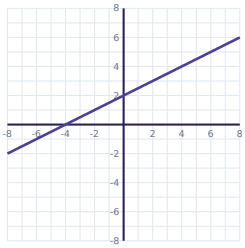

Task card 3 Function Notation with Graphs & Ta...

The graph shows y = f(x), and g(x) = -4x + 3. Find f(-1) + g(-4).

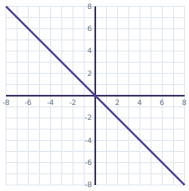

Task card 4 Function Notation with Graphs & Ta...

The graph shows y = f(x). Find f(-4).

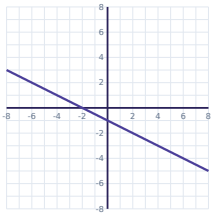

Task card 5 Function Notation with Graphs & Ta...

The graph shows y = f(x). Find x when f(x) = -4.

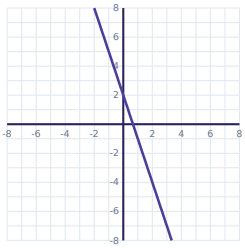

Task card 6 Function Notation with Graphs & Ta...

The graph shows y = f(x), and g(x) = -2x + 8. Find f(1) - g(2).

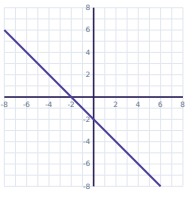

Task card 7 Function Notation with Graphs & Ta...

The graph shows y = f(x). Find f(3).

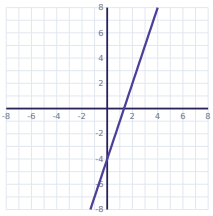

Task card 8 Function Notation with Graphs & Ta...

The graph shows y = f(x). Find x when f(x) = -5.

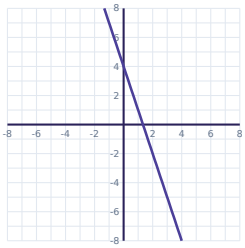

Task card 9 Function Notation with Graphs & Ta...

The graph shows y = f(x), and g(x) = 5x - 7. Find f(0) - g(3).

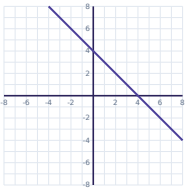

Task card 10 Function Notation with Graphs & Ta...

The graph shows y = f(x). Find f(1).

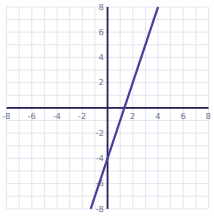

Task card 11 Function Notation with Graphs & Ta...

The graph shows y = f(x). Find x when f(x) = 6.

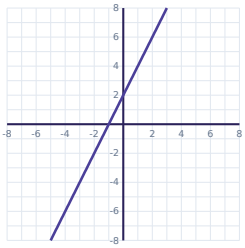

Task card 12 Function Notation with Graphs & Ta...

The graph shows y = f(x), and g(x) = -4x + 8. Find f(1) - g(-4).

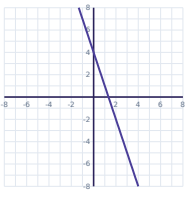

Task card 13 Function Notation with Graphs & Ta...

The graph shows y = f(x). Find f(2).

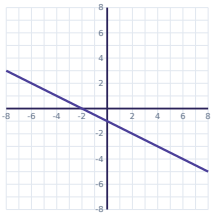

Task card 14 Function Notation with Graphs & Ta...

The graph shows y = f(x). Find x when f(x) = 5.

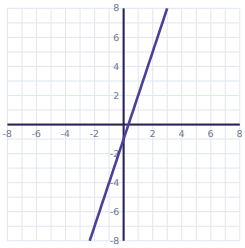

Task card 15 Function Notation with Graphs & Ta...

The graph shows y = f(x), and g(x) = 2x - 4. Find f(-1) + g(1).

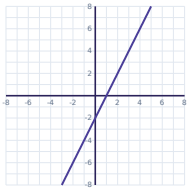

Task card 16 Function Notation with Graphs & Ta...

The graph shows y = f(x). Find f(-1).

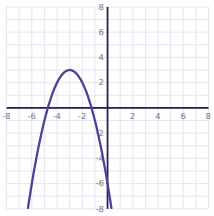

Task card 17 Function Notation with Graphs & Ta...

The graph shows y = f(x). Find x when f(x) = 5.

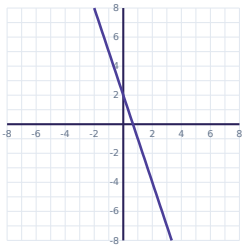

Task card 18 Function Notation with Graphs & Ta...

The graph shows y = f(x), and g(x) = -5x - 1. Find f(-1) - g(-5).

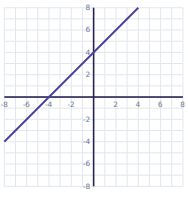

Task card 19 Function Notation with Graphs & Ta...

The graph shows y = f(x). Find f(-1).

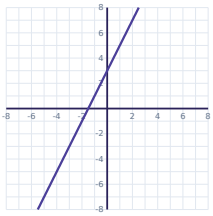

Task card 20 Function Notation with Graphs & Ta...

The graph shows y = f(x). Find x when f(x) = -2.

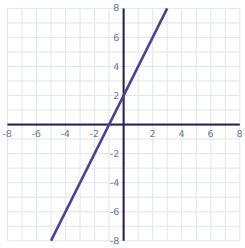

Task card 21 Function Notation with Graphs & Ta...

The graph shows y = f(x), and g(x) = -3x. Find f(0) + g(-4).

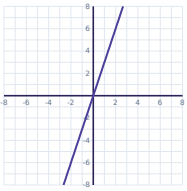

Task card 22 Function Notation with Graphs & Ta...

The graph shows y = f(x). Find f(0).

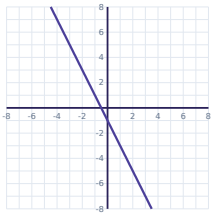

Task card 23 Function Notation with Graphs & Ta...

The graph shows y = f(x). Find x when f(x) = 5.

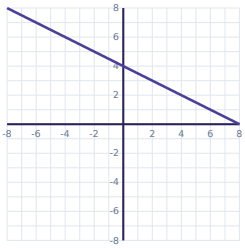

Task card 24 Function Notation with Graphs & Ta...

The graph shows y = f(x), and g(x) = 2x - 6. Find f(0) + g(-3).

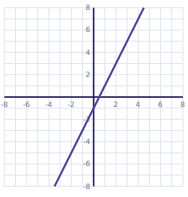

Function Notation with Graphs & Tables Task Cards

Recording sheet · Grade 9 · Use the graph, the table or the rule to answer each question.

Scan to check your answers

Name: _____ Date: _____

1	2	3	4
5	6	7	8
9	10	11	12
13	14	15	16
17	18	19	20
21	22	23	24

Function Notation with Graphs & Tables Task Cards: Answer Key

Grade 9 · Medium

The answers online

1. 1	**2.** 2	**3.** 20
4. 1	**5.** 2	**6.** -7
7. 5	**8.** 3	**9.** -4
10. -1	**11.** 2	**12.** -23
13. -2	**14.** 2	**15.** -6
16. -1	**17.** -1	**18.** -21
19. 1	**20.** -2	**21.** 12
22. -1	**23.** -2	**24.** -13