Task card 1 Function Notation with Graphs & Ta...

The graph shows y = f(x). Find f(-1).

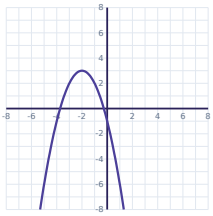

Task card 2 Function Notation with Graphs & Ta...

The graph shows y = f(x). Find x when f(x) = -2.

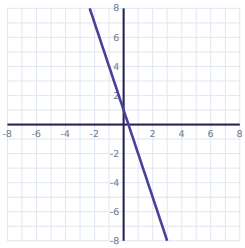

Task card 3 Function Notation with Graphs & Ta...

The graph shows y = f(x), and g(x) = 5x + 2. Find f(-1) - g(4).

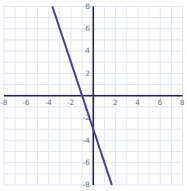

Task card 4 Function Notation with Graphs & Ta...

The graph shows y = f(x). Find f(6).

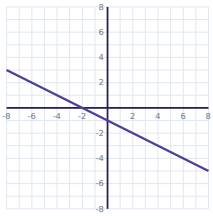

Task card 5 Function Notation with Graphs & Ta...

The graph shows y = f(x). Find x when f(x) = -6.

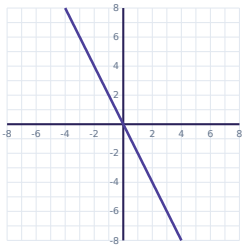

Task card 6 Function Notation with Graphs & Ta...

The graph shows y = f(x), and g(x) = -2x + 8. Find f(2) - g(-3).

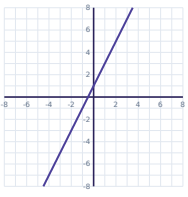

Task card 7 Function Notation with Graphs & Ta...

The graph shows y = f(x). Find f(-3).

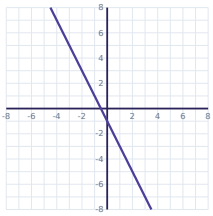

Task card 8 Function Notation with Graphs & Ta...

The graph shows y = f(x). Find x when f(x) = -6.

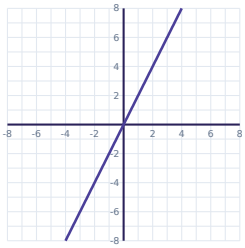

Task card 9 Function Notation with Graphs & Ta...

The graph shows y = f(x), and g(x) = 2x + 5. Find f(1) - g(-4).

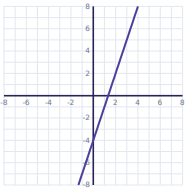

Task card 10 Function Notation with Graphs & Ta...

The graph shows y = f(x). Find f(2).

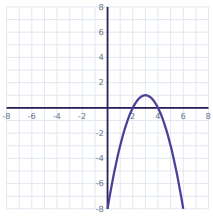

Task card 11 Function Notation with Graphs & Ta...

The graph shows y = f(x). Find x when f(x) = 0.

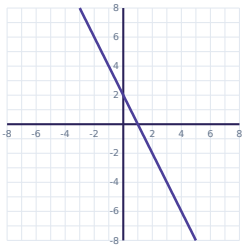

Task card 12 Function Notation with Graphs & Ta...

The graph shows y = f(x), and g(x) = -2x - 5. Find f(-1) - g(5).

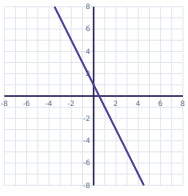

Task card 13 Function Notation with Graphs & Ta...

The graph shows y = f(x). Find f(-5).

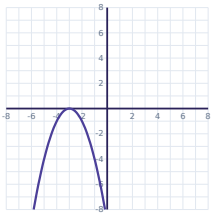

Task card 14 Function Notation with Graphs & Ta...

The graph shows y = f(x). Find x when f(x) = 7.

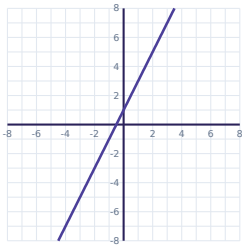

Task card 15 Function Notation with Graphs & Ta...

The graph shows y = f(x), and g(x) = -3x + 5. Find f(-1) + g(4).

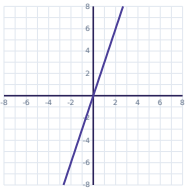

Task card 16 Function Notation with Graphs & Ta...

The graph shows y = f(x). Find f(1).

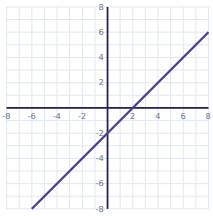

Task card 17 Function Notation with Graphs & Ta...

The graph shows y = f(x). Find x when f(x) = -1.

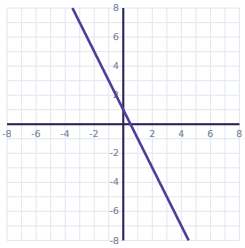

Task card 18 Function Notation with Graphs & Ta...

The graph shows y = f(x), and g(x) = -5x + 4. Find f(2) - g(2).

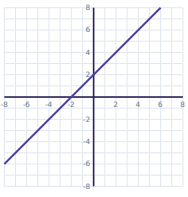

Task card 19 Function Notation with Graphs & Ta...

The graph shows y = f(x). Find f(4).

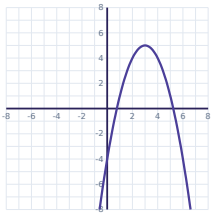

Task card 20 Function Notation with Graphs & Ta...

The graph shows y = f(x). Find x when f(x) = -1.

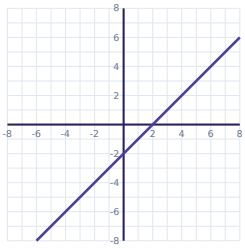

Task card 21 Function Notation with Graphs & Ta...

The graph shows y = f(x), and g(x) = 3x + 7. Find f(2) + g(3).

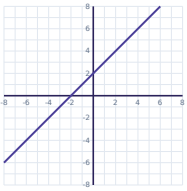

Task card 22 Function Notation with Graphs & Ta...

The graph shows y = f(x). Find f(-1).

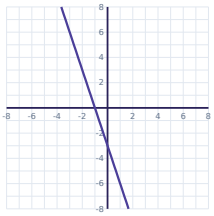

Task card 23 Function Notation with Graphs & Ta...

The graph shows y = f(x). Find x when f(x) = -1.

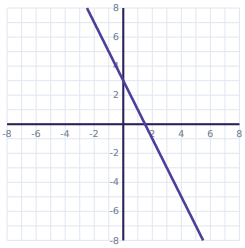

Task card 24 Function Notation with Graphs & Ta...

The graph shows y = f(x), and g(x) = -3x - 5. Find f(-4) + g(3).

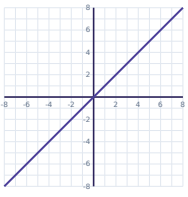

Function Notation with Graphs & Tables Task Cards

Recording sheet · Grade 9 · Use the graph, the table or the rule to answer each question.

Scan to check your answers

Name: _____ Date: _____

1	2	3	4
5	6	7	8
9	10	11	12
13	14	15	16
17	18	19	20
21	22	23	24

Function Notation with Graphs & Tables Task Cards: Answer Key

Grade 9 · Hard

The answers online

1. 2	**2.** 1	**3.** -22
4. -4	**5.** 3	**6.** -9
7. 5	**8.** -3	**9.** 2
10. 0	**11.** 1	**12.** 18
13. -4	**14.** 3	**15.** -10
16. -1	**17.** 1	**18.** 10
19. 4	**20.** 1	**21.** 20
22. 0	**23.** 2	**24.** -18