Task card 1 Function Notation with Graphs & Ta...

The graph shows y = f(x). Find f(2).

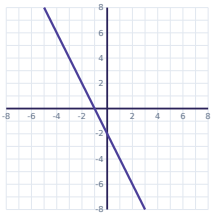

Task card 2 Function Notation with Graphs & Ta...

The graph shows y = f(x). Find x when f(x) = -7.

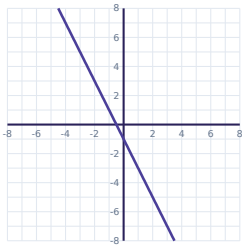

Task card 3 Function Notation with Graphs & Ta...

The graph shows y = f(x). Find f(3).

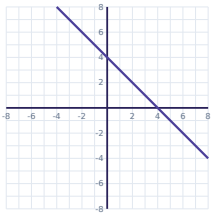

Task card 4 Function Notation with Graphs & Ta...

The graph shows y = f(x). Find f(-4).

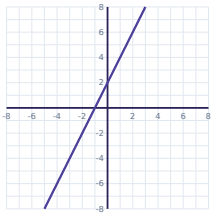

Task card 5 Function Notation with Graphs & Ta...

The graph shows y = f(x). Find x when f(x) = 2.

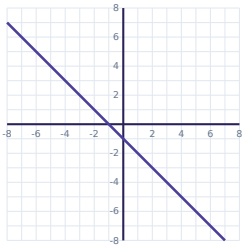

Task card 6 Function Notation with Graphs & Ta...

The graph shows y = f(x). Find f(-2).

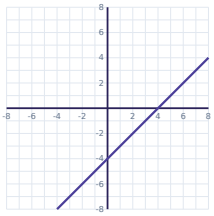

Task card 7 Function Notation with Graphs & Ta...

The graph shows y = f(x). Find f(5).

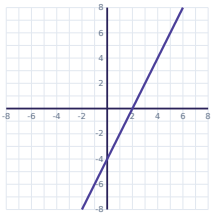

Task card 8 Function Notation with Graphs & Ta...

The graph shows y = f(x). Find x when f(x) = -1.

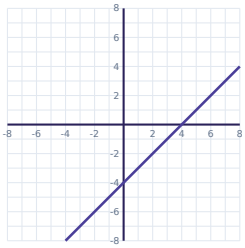

Task card 9 Function Notation with Graphs & Ta...

The graph shows y = f(x). Find f(-1).

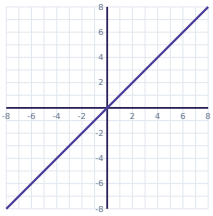

Task card 10 Function Notation with Graphs & Ta...

The graph shows y = f(x). Find f(2).

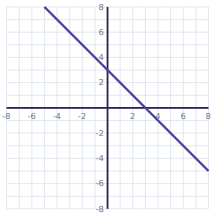

Task card 11 Function Notation with Graphs & Ta...

The graph shows y = f(x). Find x when f(x) = -1.

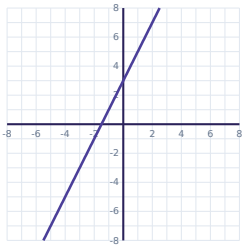

Task card 12 Function Notation with Graphs & Ta...

The graph shows y = f(x). Find f(-2).

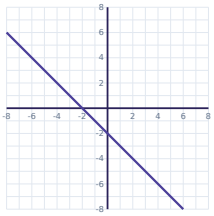

Task card 13 Function Notation with Graphs & Ta...

The graph shows y = f(x). Find f(-1).

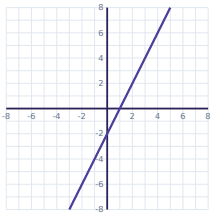

Task card 14 Function Notation with Graphs & Ta...

The graph shows y = f(x). Find x when f(x) = 6.

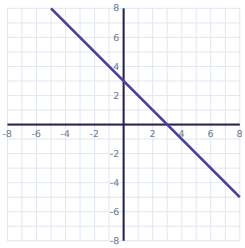

Task card 15 Function Notation with Graphs & Ta...

The graph shows y = f(x). Find f(1).

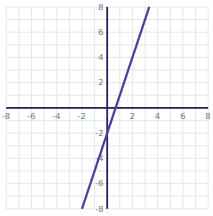

Task card 16 Function Notation with Graphs & Ta...

The graph shows y = f(x). Find f(1).

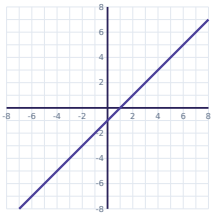

Task card 17 Function Notation with Graphs & Ta...

The graph shows y = f(x). Find x when f(x) = 1.

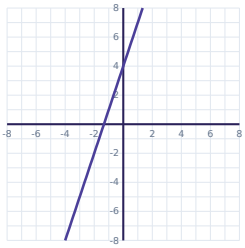

Task card 18 Function Notation with Graphs & Ta...

The graph shows y = f(x). Find f(1).

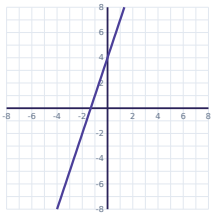

Task card 19 Function Notation with Graphs & Ta...

The graph shows y = f(x). Find f(2).

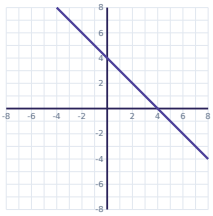

Task card 20 Function Notation with Graphs & Ta...

The graph shows y = f(x). Find x when f(x) = 7.

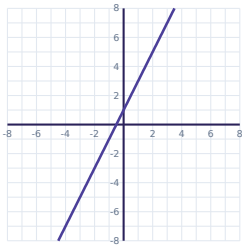

Task card 21 Function Notation with Graphs & Ta...

The graph shows y = f(x). Find f(-2).

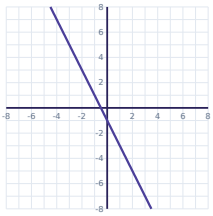

Task card 22 Function Notation with Graphs & Ta...

The graph shows y = f(x). Find f(-2).

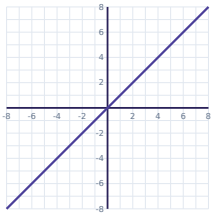

Task card 23 Function Notation with Graphs & Ta...

The graph shows y = f(x). Find x when f(x) = 7.

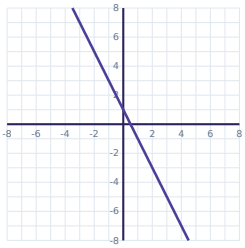

Task card 24 Function Notation with Graphs & Ta...

The graph shows y = f(x). Find f(2).

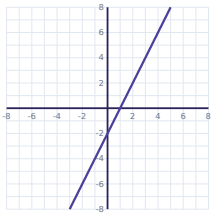

Function Notation with Graphs & Tables Task Cards

Recording sheet · Grade 9 · Use the graph, the table or the rule to answer each question.

Scan to check your answers

Name: _____ Date: _____

1	2	3	4
5	6	7	8
9	10	11	12
13	14	15	16
17	18	19	20
21	22	23	24

Function Notation with Graphs & Tables Task Cards: Answer Key

Grade 9 · Easy

The answers online

1. -6	**2.** 3	**3.** 1
4. -6	**5.** -3	**6.** -6
7. 6	**8.** 3	**9.** -1
10. 1	**11.** -2	**12.** 0
13. -4	**14.** -3	**15.** 1
16. 0	**17.** -1	**18.** 7
19. 2	**20.** 3	**21.** 3
22. -2	**23.** -3	**24.** 2