The graph shows y = f(x). Find f(2).

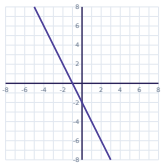

The graph shows y = f(x). Find x when f(x) = -7.

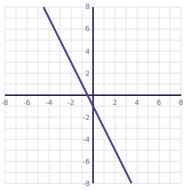

The graph shows y = f(x). Find f(3).

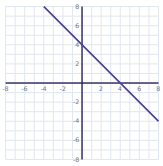

The graph shows y = f(x). Find f(-4).

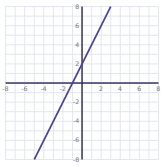

The graph shows y = f(x). Find x when f(x) = 2.

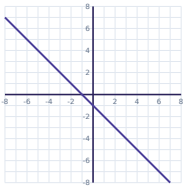

The graph shows y = f(x). Find f(-2).

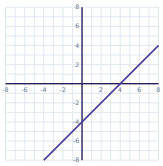

The graph shows y = f(x). Find f(5).

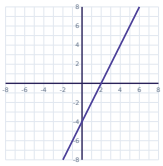

The graph shows y = f(x). Find x when f(x) = -1.

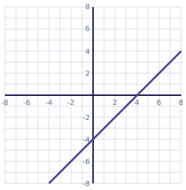

Function Notation with Graphs & Tables · 2

ANSWER

3

Function Notation with Graphs & Tables · 1

ANSWER

-6

Function Notation with Graphs & Tables · 4

ANSWER

-6

Function Notation with Graphs & Tables · 3

ANSWER

1

Function Notation with Graphs & Tables · 6

ANSWER

-6

Function Notation with Graphs & Tables · 5

ANSWER

-3

Function Notation with Graphs & Tables · 8

ANSWER

3

Function Notation with Graphs & Tables · 7

ANSWER

6

The graph shows y = f(x).

Find f(-1).

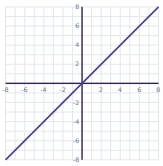

The graph shows y = f(x).

Find f(2).

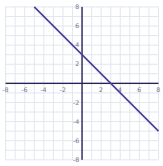

The graph shows y = f(x). Find x when f(x) = -1.

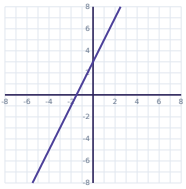

The graph shows y = f(x).

Find f(-2).

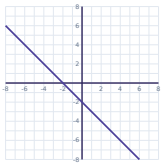

The graph shows y = f(x).

Find f(-1).

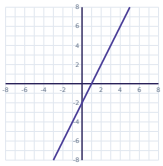

The graph shows y = f(x). Find x when f(x) = 6.

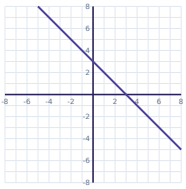

The graph shows y = f(x).

Find f(1).

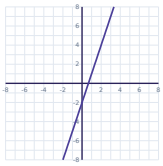

The graph shows y = f(x).

Find f(1).

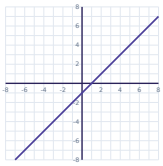

Function Notation with Graphs & Tables · 10

ANSWER

1

Function Notation with Graphs & Tables · 9

ANSWER

-1

Function Notation with Graphs & Tables · 12

ANSWER

0

Function Notation with Graphs & Tables · 11

ANSWER

-2

Function Notation with Graphs & Tables · 14

ANSWER

-3

Function Notation with Graphs & Tables · 13

ANSWER

-4

Function Notation with Graphs & Tables · 16

ANSWER

0

Function Notation with Graphs & Tables · 15

ANSWER

1

The graph shows y = f(x). Find x when f(x) = 1.

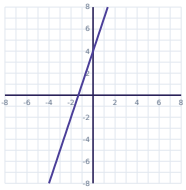

The graph shows y = f(x). Find f(1).

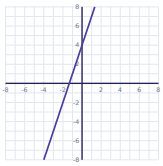

The graph shows y = f(x). Find f(2).

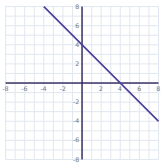

The graph shows y = f(x). Find x when f(x) = 7.

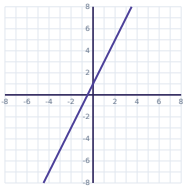

The graph shows y = f(x). Find f(-2).

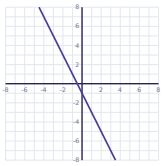

The graph shows y = f(x). Find f(-2).

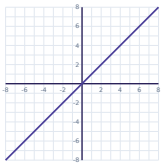

The graph shows y = f(x). Find x when f(x) = 7.

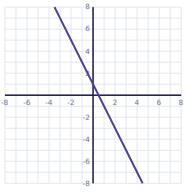

The graph shows y = f(x). Find f(2).

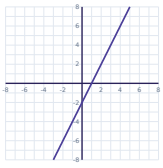

Function Notation with Graphs & Tables · 18

ANSWER

7

Function Notation with Graphs & Tables · 17

ANSWER

-1

Function Notation with Graphs & Tables · 20

ANSWER

3

Function Notation with Graphs & Tables · 19

ANSWER

2

Function Notation with Graphs & Tables · 22

ANSWER

-2

Function Notation with Graphs & Tables · 21

ANSWER

3

Function Notation with Graphs & Tables · 24

ANSWER

2

Function Notation with Graphs & Tables · 23

ANSWER

-3