Task card 1 Domain and Range from a Graph

Write the domain of the function graphed.

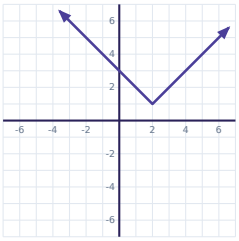

Task card 2 Domain and Range from a Graph

Write the range of the function graphed.

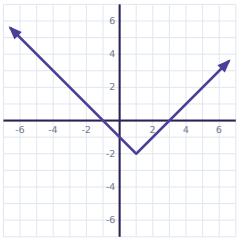

Task card 3 Domain and Range from a Graph

Write the domain of the function graphed.

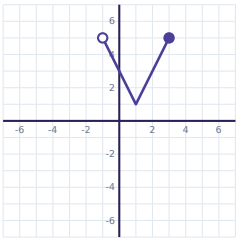

Task card 4 Domain and Range from a Graph

Write the range of the function graphed.

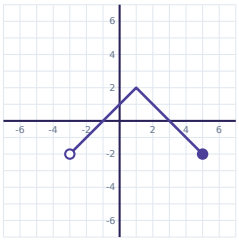

Task card 5 Domain and Range from a Graph

Write the domain of the function graphed.

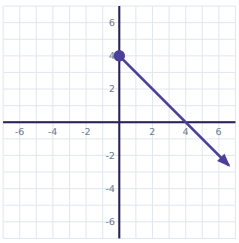

Task card 6 Domain and Range from a Graph

Write the range of the function graphed.

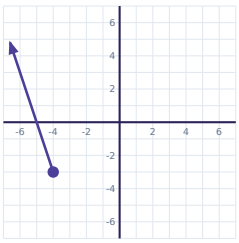

Task card 7 Domain and Range from a Graph

Write the domain of the function graphed.

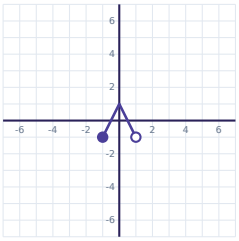

Task card 8 Domain and Range from a Graph

Write the range of the function graphed.

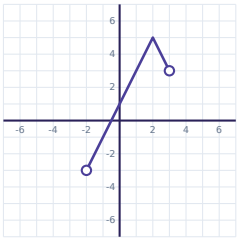

Task card 9 Domain and Range from a Graph

Write the domain of the function graphed.

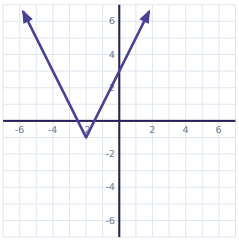

Task card 10 Domain and Range from a Graph

Write the range of the function graphed.

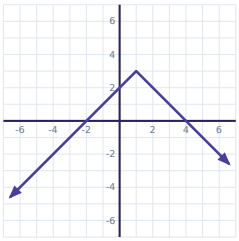

Task card 11 Domain and Range from a Graph

Write the domain of the function graphed.

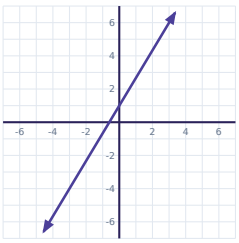

Task card 12 Domain and Range from a Graph

Write the range of the function graphed.

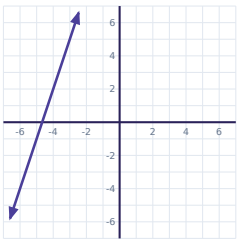

Task card 13 Domain and Range from a Graph

Write the domain of the function graphed.

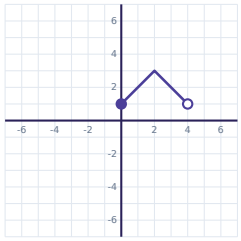

Task card 14 Domain and Range from a Graph

Write the range of the function graphed.

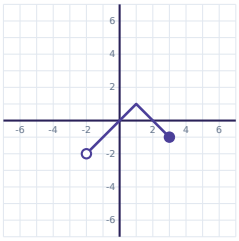

Task card 15 Domain and Range from a Graph

Write the domain of the function graphed.

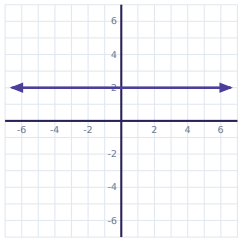

Task card 16 Domain and Range from a Graph

Write the range of the function graphed.

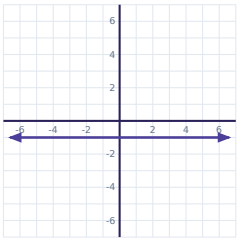

Task card 17 Domain and Range from a Graph

Write the domain of the function graphed.

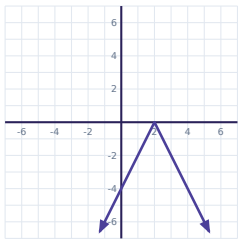

Task card 18 Domain and Range from a Graph

Write the range of the function graphed.

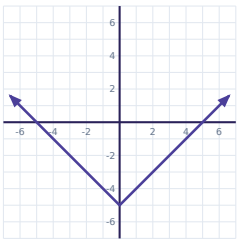

Task card 19 Domain and Range from a Graph

Write the domain of the function graphed.

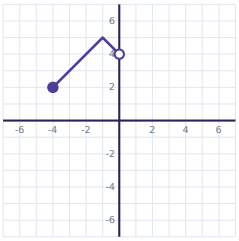

Task card 20 Domain and Range from a Graph

Write the range of the function graphed.

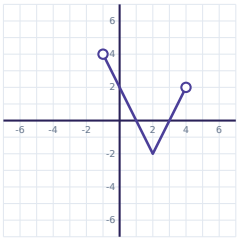

Task card 21 Domain and Range from a Graph

Write the domain of the function graphed.

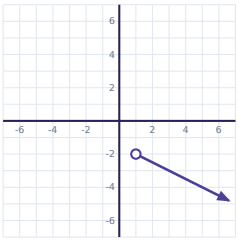

Task card 22 Domain and Range from a Graph

Write the range of the function graphed.

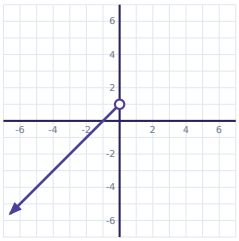

Task card 23 Domain and Range from a Graph

Write the domain of the function graphed.

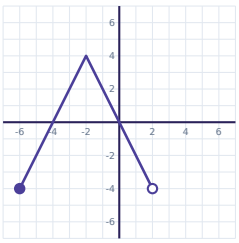

Task card 24 Domain and Range from a Graph

Write the range of the function graphed.

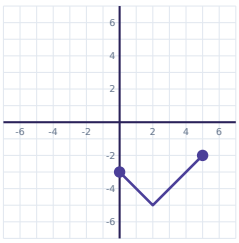

Domain and Range from a Graph Task Cards

Recording sheet · Grade 9 · Write each domain or range as an inequality, like -2 ≤ x < 5 or y ≥ 1 (smaller number first). A closed dot is included (≤ or ≥), an open dot is not (< or >), and an arrow means the graph keeps going. If every value works, write all real numbers.

Scan to check your answers

Name: _____ Date: _____

1	2	3	4
5	6	7	8
9	10	11	12
13	14	15	16
17	18	19	20
21	22	23	24

Domain and Range from a Graph Task Cards: Answer Key

Grade 9 · Hard

The answers online

1. all real numbers	**2.** $y \geq -2$	**3.** $-1 < x \leq 3$
4. $-2 \leq y \leq 2$	**5.** $x \geq 0$	**6.** $y \geq -3$
7. $-1 \leq x < 1$	**8.** $-3 < y \leq 5$	**9.** all real numbers
10. $y \leq 3$	**11.** all real numbers	**12.** all real numbers
13. $0 \leq x < 4$	**14.** $-2 < y \leq 1$	**15.** all real numbers
16. $y = -1$	**17.** all real numbers	**18.** $y \geq -5$
19. $-4 \leq x < 0$	**20.** $-2 \leq y < 4$	**21.** $x > 1$
22. $y < 1$	**23.** $-6 \leq x < 2$	**24.** $-5 \leq y \leq -2$