Task card 1 Domain and Range from a Graph

Write the domain of the function graphed.

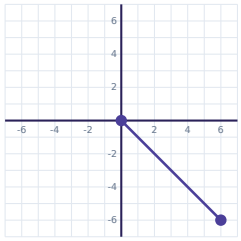

Task card 2 Domain and Range from a Graph

Write the range of the function graphed.

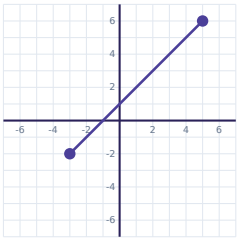

Task card 3 Domain and Range from a Graph

Write the domain of the function graphed.

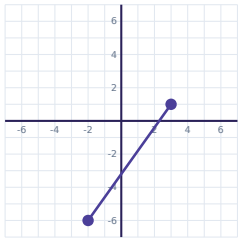

Task card 4 Domain and Range from a Graph

Write the range of the function graphed.

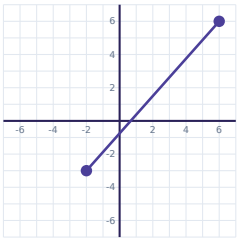

Task card 5 Domain and Range from a Graph

Write the domain of the function graphed.

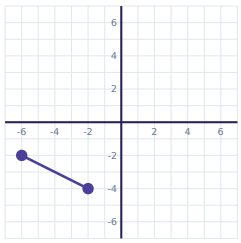

Task card 6 Domain and Range from a Graph

Write the range of the function graphed.

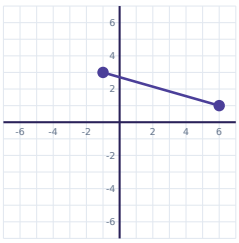

Task card 7 Domain and Range from a Graph

Write the domain of the function graphed.

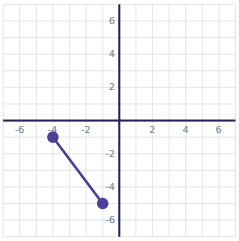

Task card 8 Domain and Range from a Graph

Write the range of the function graphed.

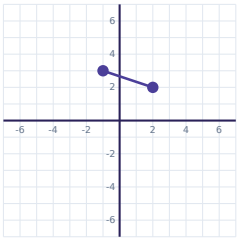

Task card 9 Domain and Range from a Graph

Write the domain of the function graphed.

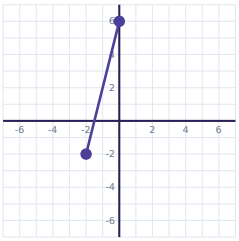

Task card 10 Domain and Range from a Graph

Write the range of the function graphed.

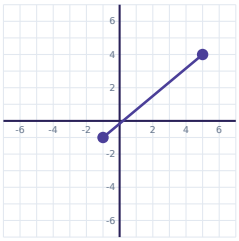

Task card 11 Domain and Range from a Graph

Write the domain of the function graphed.

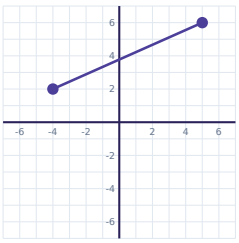

Task card 12 Domain and Range from a Graph

Write the range of the function graphed.

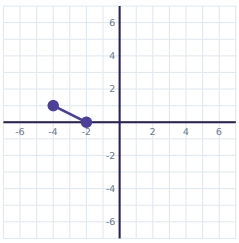

Task card 13 Domain and Range from a Graph

Write the domain of the function graphed.

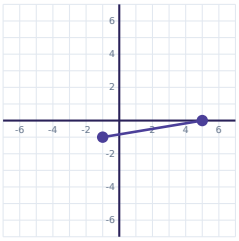

Task card 14 Domain and Range from a Graph

Write the range of the function graphed.

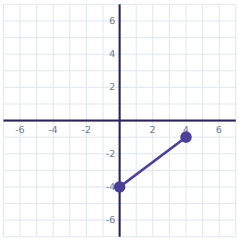

Task card 15 Domain and Range from a Graph

Write the domain of the function graphed.

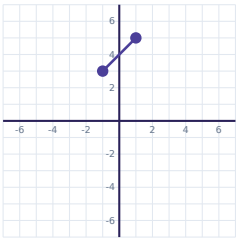

Task card 16 Domain and Range from a Graph

Write the range of the function graphed.

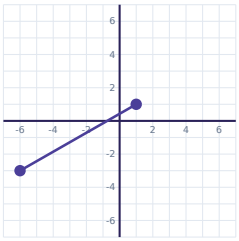

Task card 17 Domain and Range from a Graph

Write the domain of the function graphed.

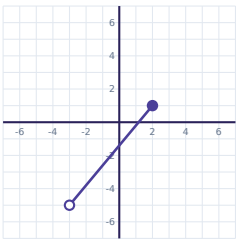

Task card 18 Domain and Range from a Graph

Write the range of the function graphed.

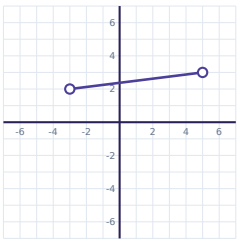

Task card 19 Domain and Range from a Graph

Write the domain of the function graphed.

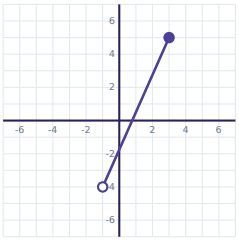

Task card 20 Domain and Range from a Graph

Write the range of the function graphed.

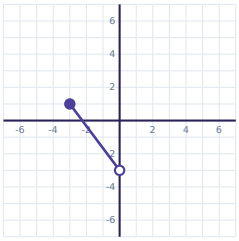

Task card 21 Domain and Range from a Graph

Write the domain of the function graphed.

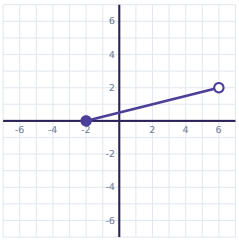

Task card 22 Domain and Range from a Graph

Write the range of the function graphed.

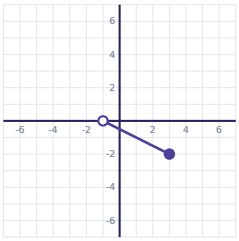

Task card 23 Domain and Range from a Graph

Write the domain of the function graphed.

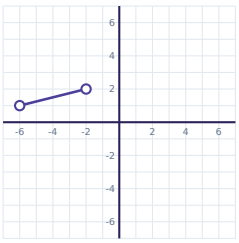

Task card 24 Domain and Range from a Graph

Write the range of the function graphed.

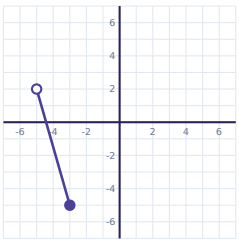

Domain and Range from a Graph Task Cards

Recording sheet · Grade 9 · Write each domain or range as an inequality, like -2 ≤ x < 5 or y ≥ 1 (smaller number first). A closed dot is included (≤ or ≥), an open dot is not (< or >), and an arrow means the graph keeps going. If every value works, write all real numbers.

Scan to check your answers

Name: _____ Date: _____

1	2	3	4
5	6	7	8
9	10	11	12
13	14	15	16
17	18	19	20
21	22	23	24

Domain and Range from a Graph Task Cards: Answer Key

Grade 9 · Easy

The answers online

1. $0 \le x \le 6$	**2.** $-2 \le y \le 6$	**3.** $-2 \le x \le 3$
4. $-3 \le y \le 6$	**5.** $-6 \le x \le -2$	**6.** $1 \le y \le 3$
7. $-4 \le x \le -1$	**8.** $2 \le y \le 3$	**9.** $-2 \le x \le 0$
10. $-1 \le y \le 4$	**11.** $-4 \le x \le 5$	**12.** $0 \le y \le 1$
13. $-1 \le x \le 5$	**14.** $-4 \le y \le -1$	**15.** $-1 \le x \le 1$
16. $-3 \le y \le 1$	**17.** $-3 < x \le 2$	**18.** $2 < y < 3$
19. $-1 < x \le 3$	**20.** $-3 < y \le 1$	**21.** $-2 \le x < 6$
22. $-2 \le y < 0$	**23.** $-6 < x < -2$	**24.** $-5 \le y < 2$