Domain and Range from a Graph · 1

Write the domain of the function graphed.

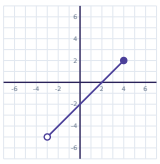

Domain and Range from a Graph · 2

Write the range of the function graphed.

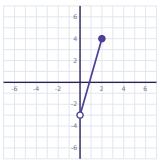

Domain and Range from a Graph · 3

Write the domain of the function graphed.

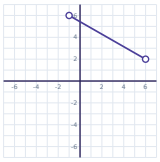

Domain and Range from a Graph · 4

Write the range of the function graphed.

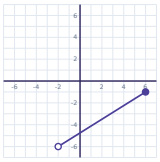

Domain and Range from a Graph · 5

Write the domain of the function graphed.

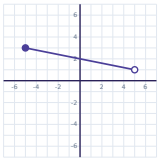

Domain and Range from a Graph · 6

Write the range of the function graphed.

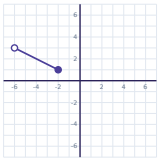

Domain and Range from a Graph · 7

Write the domain of the function graphed.

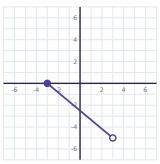

Domain and Range from a Graph · 8

Write the range of the function graphed.

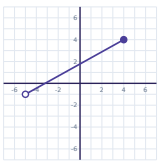

Domain and Range from a Graph · 2

ANSWER

$-3 < y \leq 4$

Domain and Range from a Graph · 1

ANSWER

$-3 < x \leq 4$

Domain and Range from a Graph · 4

ANSWER

$-6 < y \leq -1$

Domain and Range from a Graph · 3

ANSWER

$-1 < x < 6$

Domain and Range from a Graph · 6

ANSWER

$1 \leq y < 3$

Domain and Range from a Graph · 5

ANSWER

$-5 \leq x < 5$

Domain and Range from a Graph · 8

ANSWER

$-1 < y \leq 4$

Domain and Range from a Graph · 7

ANSWER

$-3 \leq x < 3$

Domain and Range from a Graph · 9

Write the domain of the function graphed.

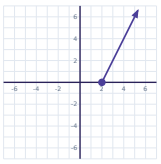

Domain and Range from a Graph · 10

Write the range of the function graphed.

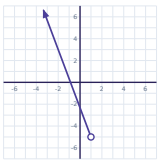

Domain and Range from a Graph · 11

Write the domain of the function graphed.

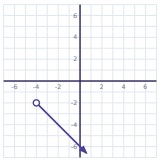

Domain and Range from a Graph · 12

Write the range of the function graphed.

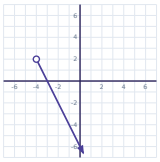

Domain and Range from a Graph · 13

Write the domain of the function graphed.

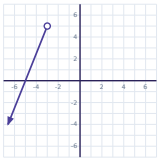

Domain and Range from a Graph · 14

Write the range of the function graphed.

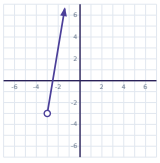

Domain and Range from a Graph · 15

Write the domain of the function graphed.

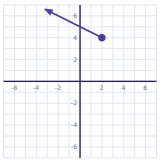

Domain and Range from a Graph · 16

Write the range of the function graphed.

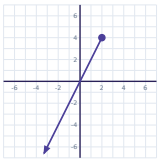

Domain and Range from a Graph · 10

ANSWER

$y > -5$

Domain and Range from a Graph · 9

ANSWER

$x \geq 2$

Domain and Range from a Graph · 12

ANSWER

$y < 2$

Domain and Range from a Graph · 11

ANSWER

$x > -4$

Domain and Range from a Graph · 14

ANSWER

$y > -3$

Domain and Range from a Graph · 13

ANSWER

$x < -3$

Domain and Range from a Graph · 16

ANSWER

$y \leq 4$

Domain and Range from a Graph · 15

ANSWER

$x \leq 2$

Domain and Range from a Graph · 17

Write the domain of the function graphed.

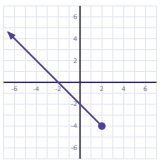

Domain and Range from a Graph · 18

Write the range of the function graphed.

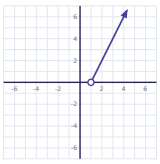

Domain and Range from a Graph · 19

Write the domain of the function graphed.

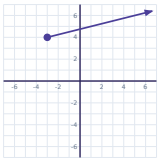

Domain and Range from a Graph · 20

Write the range of the function graphed.

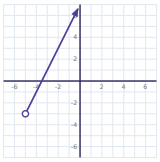

Domain and Range from a Graph · 21

Write the domain of the function graphed.

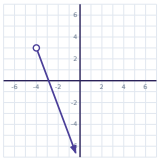

Domain and Range from a Graph · 22

Write the range of the function graphed.

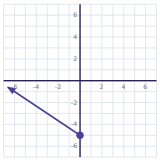

Domain and Range from a Graph · 23

Write the domain of the function graphed.

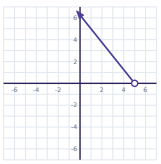

Domain and Range from a Graph · 24

Write the range of the function graphed.

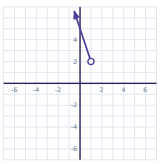

Domain and Range from a Graph · 18

ANSWER

$y > 0$

Domain and Range from a Graph · 17

ANSWER

$x \leq 2$

Domain and Range from a Graph · 20

ANSWER

$y > -3$

Domain and Range from a Graph · 19

ANSWER

$x \geq -3$

Domain and Range from a Graph · 22

ANSWER

$y \geq -5$

Domain and Range from a Graph · 21

ANSWER

$x > -4$

Domain and Range from a Graph · 24

ANSWER

$y > 2$

Domain and Range from a Graph · 23

ANSWER

$x < 5$