Writing y = mx + b from a Graph · 1

Write the equation of the line in the form y = mx + b.

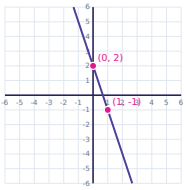

Writing y = mx + b from a Graph · 2

Write the equation of the line in the form y = mx + b.

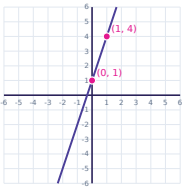

Writing y = mx + b from a Graph · 3

Write the equation of the line in the form y = mx + b.

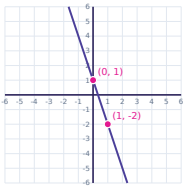

Writing y = mx + b from a Graph · 4

Write the equation of the line in the form y = mx + b.

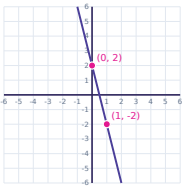

Writing y = mx + b from a Graph · 5

Write the equation of the line in the form y = mx + b.

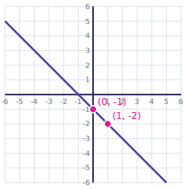

Writing y = mx + b from a Graph · 6

Write the equation of the line in the form y = mx + b.

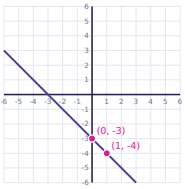

Writing y = mx + b from a Graph · 7

Write the equation of the line in the form y = mx + b.

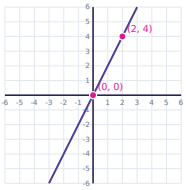

Writing y = mx + b from a Graph · 8

Write the equation of the line in the form y = mx + b.

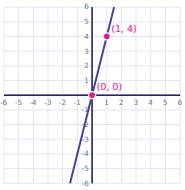

Writing y = mx + b from a Graph · 2

ANSWER

$y = 3x + 1$

Writing y = mx + b from a Graph · 1

ANSWER

$y = -3x + 2$

Writing y = mx + b from a Graph · 4

ANSWER

$y = -4x + 2$

Writing y = mx + b from a Graph · 3

ANSWER

$y = -3x + 1$

Writing y = mx + b from a Graph · 6

ANSWER

$y = -x - 3$

Writing y = mx + b from a Graph · 5

ANSWER

$y = -x - 1$

Writing y = mx + b from a Graph · 8

ANSWER

$y = 4x$

Writing y = mx + b from a Graph · 7

ANSWER

$y = 2x$

Writing y = mx + b from a Graph · 9

Write the equation of the line in the form y = mx + b.

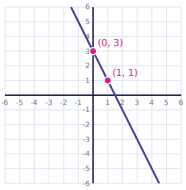

Writing y = mx + b from a Graph · 10

Write the equation of the line in the form y = mx + b.

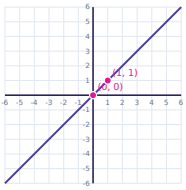

Writing y = mx + b from a Graph · 11

Write the equation of the line in the form y = mx + b.

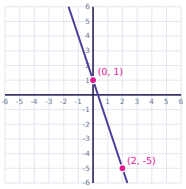

Writing y = mx + b from a Graph · 12

Write the equation of the line in the form y = mx + b.

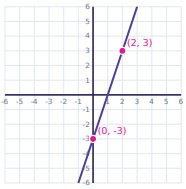

Writing y = mx + b from a Graph · 13

Write the equation of the line in the form y = mx + b.

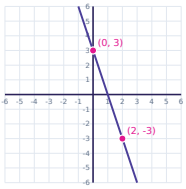

Writing y = mx + b from a Graph · 14

Write the equation of the line in the form y = mx + b.

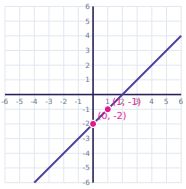

Writing y = mx + b from a Graph · 15

Write the equation of the line in the form y = mx + b.

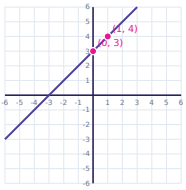

Writing y = mx + b from a Graph · 16

Write the equation of the line in the form y = mx + b.

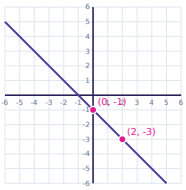

Writing y = mx + b from a Graph · 10

ANSWER

$y = x$

Writing y = mx + b from a Graph · 9

ANSWER

$y = -2x + 3$

Writing y = mx + b from a Graph · 12

ANSWER

$y = 3x - 3$

Writing y = mx + b from a Graph · 11

ANSWER

$y = -3x + 1$

Writing y = mx + b from a Graph · 14

ANSWER

$y = x - 2$

Writing y = mx + b from a Graph · 13

ANSWER

$y = -3x + 3$

Writing y = mx + b from a Graph · 16

ANSWER

$y = -x - 1$

Writing y = mx + b from a Graph · 15

ANSWER

$y = x + 3$

Writing y = mx + b from a Graph · 17

Write the equation of the line in the form y = mx + b.

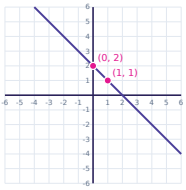

Writing y = mx + b from a Graph · 18

Write the equation of the line in the form y = mx + b.

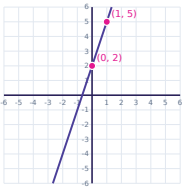

Writing y = mx + b from a Graph · 19

Write the equation of the line in the form y = mx + b.

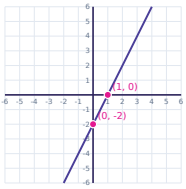

Writing y = mx + b from a Graph · 20

Write the equation of the line in the form y = mx + b.

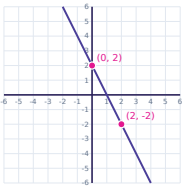

Writing y = mx + b from a Graph · 21

Write the equation of the line in the form y = mx + b.

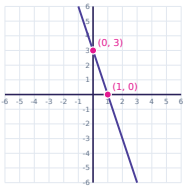

Writing y = mx + b from a Graph · 22

Write the equation of the line in the form y = mx + b.

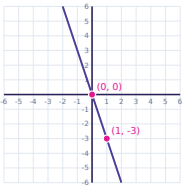

Writing y = mx + b from a Graph · 23

Write the equation of the line in the form y = mx + b.

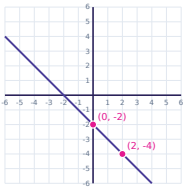

Writing y = mx + b from a Graph · 24

Write the equation of the line in the form y = mx + b.

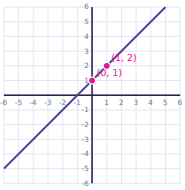

Writing y = mx + b from a Graph · 18

ANSWER

$y = 3x + 2$

Writing y = mx + b from a Graph · 17

ANSWER

$y = -x + 2$

Writing y = mx + b from a Graph · 20

ANSWER

$y = -2x + 2$

Writing y = mx + b from a Graph · 19

ANSWER

$y = 2x - 2$

Writing y = mx + b from a Graph · 22

ANSWER

$y = -3x$

Writing y = mx + b from a Graph · 21

ANSWER

$y = -3x + 3$

Writing y = mx + b from a Graph · 24

ANSWER

$y = x + 1$

Writing y = mx + b from a Graph · 23

ANSWER

$y = -x - 2$