Writing Proportional Functions (y = kx) · 1

y is proportional to x, and y = 20 when x = 5. Write the function.

Writing Proportional Functions (y = kx) · 2

y is proportional to x, and y = 16 when x = 8. Write the function.

Writing Proportional Functions (y = kx) · 3

y is proportional to x, and y = 40 when x = 8. Write the function.

Writing Proportional Functions (y = kx) · 4

y is proportional to x, and y = 9 when x = 3. Write the function.

Writing Proportional Functions (y = kx) · 5

y is proportional to x, and y = 14 when x = 2. Write the function.

Writing Proportional Functions (y = kx) · 6

y is proportional to x, and y = 40 when x = 5. Write the function.

Writing Proportional Functions (y = kx) · 7

y is proportional to x, and y = 24 when x = 3. Write the function.

Writing Proportional Functions (y = kx) · 8

y is proportional to x, and y = 81 when x = 9. Write the function.

Writing Proportional Functions (y = kx) · 2

ANSWER

$y = 2x$

Writing Proportional Functions (y = kx) · 1

ANSWER

$y = 4x$

Writing Proportional Functions (y = kx) · 4

ANSWER

$y = 3x$

Writing Proportional Functions (y = kx) · 3

ANSWER

$y = 5x$

Writing Proportional Functions (y = kx) · 6

ANSWER

$y = 8x$

Writing Proportional Functions (y = kx) · 5

ANSWER

$y = 7x$

Writing Proportional Functions (y = kx) · 8

ANSWER

$y = 9x$

Writing Proportional Functions (y = kx) · 7

ANSWER

$y = 8x$

Writing Proportional Functions (y = kx) · 9

y is proportional to x, and y = 77 when x = 7. Write the function.

Writing Proportional Functions (y = kx) · 10

The graph shows a proportional function. Write its equation.

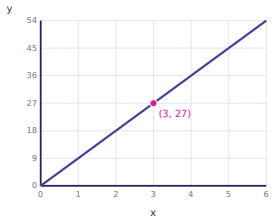

Writing Proportional Functions (y = kx) · 11

y is proportional to x, and y = 30 when x = 5. Write the function.

Writing Proportional Functions (y = kx) · 12

The graph shows a proportional function. Write its equation.

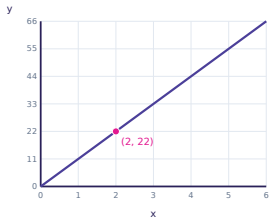

Writing Proportional Functions (y = kx) · 13

y is proportional to x, and y = 63 when x = 7. Write the function.

Writing Proportional Functions (y = kx) · 14

y is proportional to x, and y = 12 when x = 3. Write the function.

Writing Proportional Functions (y = kx) · 15

y is proportional to x, and y = 15 when x = 5. Write the function.

Writing Proportional Functions (y = kx) · 16

y is proportional to x, and y = 6 when x = 2. Write the function.

Writing Proportional Functions (y = kx) · 10

ANSWER

$y = 9x$

Writing Proportional Functions (y = kx) · 9

ANSWER

$y = 11x$

Writing Proportional Functions (y = kx) · 12

ANSWER

$y = 11x$

Writing Proportional Functions (y = kx) · 11

ANSWER

$y = 6x$

Writing Proportional Functions (y = kx) · 14

ANSWER

$y = 4x$

Writing Proportional Functions (y = kx) · 13

ANSWER

$y = 9x$

Writing Proportional Functions (y = kx) · 16

ANSWER

$y = 3x$

Writing Proportional Functions (y = kx) · 15

ANSWER

$y = 3x$

Writing Proportional Functions (y = kx) · 17

y is proportional to x, and y = 24 when x = 8. Write the function.

Writing Proportional Functions (y = kx) · 18

y is proportional to x, and y = 24 when x = 6. Write the function.

Writing Proportional Functions (y = kx) · 19

y is proportional to x, and y = 18 when x = 3. Write the function.

Writing Proportional Functions (y = kx) · 20

y is proportional to x, and y = 18 when x = 9. Write the function.

Writing Proportional Functions (y = kx) · 21

y is proportional to x, and y = 42 when x = 7. Write the function.

Writing Proportional Functions (y = kx) · 22

y is proportional to x, and y = 10 when x = 5. Write the function.

Writing Proportional Functions (y = kx) · 23

The graph shows a proportional function. Write its equation.

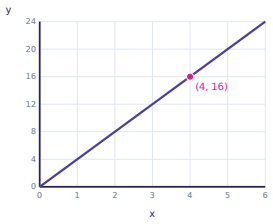

Writing Proportional Functions (y = kx) · 24

y is proportional to x, and y = 72 when x = 8. Write the function.

Writing Proportional Functions (y = kx) · 18

ANSWER

$$y = 4x$$

Writing Proportional Functions (y = kx) · 17

ANSWER

$$y = 3x$$

Writing Proportional Functions (y = kx) · 20

ANSWER

$$y = 2x$$

Writing Proportional Functions (y = kx) · 19

ANSWER

$$y = 6x$$

Writing Proportional Functions (y = kx) · 22

ANSWER

$$y = 2x$$

Writing Proportional Functions (y = kx) · 21

ANSWER

$$y = 6x$$

Writing Proportional Functions (y = kx) · 24

ANSWER

$$y = 9x$$

Writing Proportional Functions (y = kx) · 23

ANSWER

$$y = 4x$$