Volume of Cylinders, Cones & Spheres · 1

Find the volume of a cylinder with radius 4 and height 5. Use π ≈ 3.14.

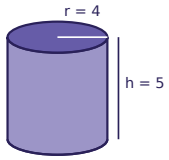

Volume of Cylinders, Cones & Spheres · 2

Find the volume of a cone with radius 4 and height 6. Use π ≈ 3.14.

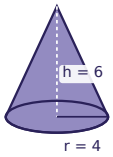

Volume of Cylinders, Cones & Spheres · 3

Find the volume of a sphere with radius 5. Use π ≈ 3.14.

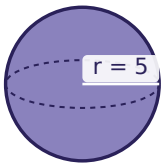

Volume of Cylinders, Cones & Spheres · 4

Find the volume of a cylinder with radius 6 and height 3. Use π ≈ 3.14.

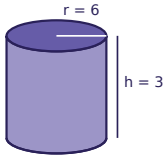

Volume of Cylinders, Cones & Spheres · 5

Find the volume of a cone with radius 2 and height 6. Use π ≈ 3.14.

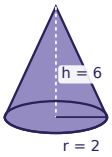

Volume of Cylinders, Cones & Spheres · 6

Find the volume of a sphere with radius 2. Use π ≈ 3.14.

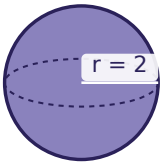

Volume of Cylinders, Cones & Spheres · 7

Find the volume of a cylinder with radius 2 and height 7. Use π ≈ 3.14.

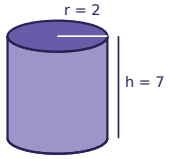

Volume of Cylinders, Cones & Spheres · 8

Find the volume of a cone with radius 6 and height 5. Use π ≈ 3.14.

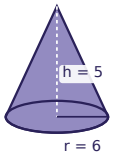

Volume of Cylinders, Cones & Spheres · 2

ANSWER

100.5

Volume of Cylinders, Cones & Spheres · 1

ANSWER

251.2

Volume of Cylinders, Cones & Spheres · 4

ANSWER

339.1

Volume of Cylinders, Cones & Spheres · 3

ANSWER

523.3

Volume of Cylinders, Cones & Spheres · 6

ANSWER

33.5

Volume of Cylinders, Cones & Spheres · 5

ANSWER

25.1

Volume of Cylinders, Cones & Spheres · 8

ANSWER

188.4

Volume of Cylinders, Cones & Spheres · 7

ANSWER

87.9

Find the volume of a cylinder with radius 7 and height 8. Use π ≈ 3.14.

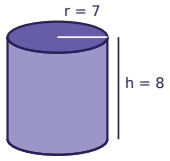

Find the volume of a cone with radius 7 and height 8. Use π ≈ 3.14.

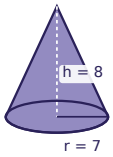

Find the volume of a sphere with radius 3. Use π ≈ 3.14.

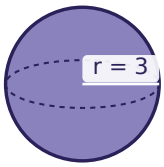

Find the volume of a cylinder with radius 2 and height 2. Use π ≈ 3.14.

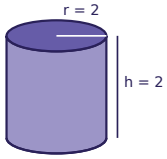

Find the volume of a cone with radius 7 and height 2. Use π ≈ 3.14.

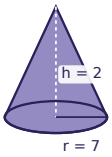

Find the volume of a cylinder with radius 4 and height 8. Use π ≈ 3.14.

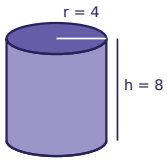

Find the volume of a cone with radius 4 and height 8. Use π ≈ 3.14.

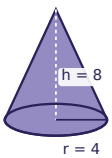

Find the volume of a cylinder with radius 6 and height 5. Use π ≈ 3.14.

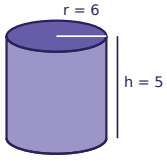

Volume of Cylinders, Cones & Spheres · 10

ANSWER

410.3

Volume of Cylinders, Cones & Spheres · 9

ANSWER

1230.9

Volume of Cylinders, Cones & Spheres · 12

ANSWER

25.1

Volume of Cylinders, Cones & Spheres · 11

ANSWER

113.0

Volume of Cylinders, Cones & Spheres · 14

ANSWER

401.9

Volume of Cylinders, Cones & Spheres · 13

ANSWER

102.6

Volume of Cylinders, Cones & Spheres · 16

ANSWER

565.2

Volume of Cylinders, Cones & Spheres · 15

ANSWER

134.0

Volume of Cylinders, Cones & Spheres · 17

Find the volume of a cone with radius 2 and height 4. Use π ≈ 3.14.

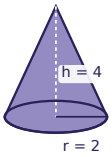

Volume of Cylinders, Cones & Spheres · 18

Find the volume of a cylinder with radius 8 and height 9. Use π ≈ 3.14.

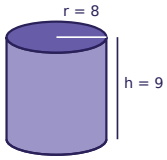

Volume of Cylinders, Cones & Spheres · 19

Find the volume of a cone with radius 3 and height 7. Use π ≈ 3.14.

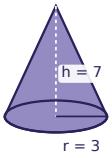

Volume of Cylinders, Cones & Spheres · 20

Find the volume of a cylinder with radius 8 and height 3. Use π ≈ 3.14.

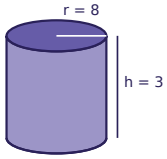

Volume of Cylinders, Cones & Spheres · 21

Find the volume of a cone with radius 5 and height 2. Use π ≈ 3.14.

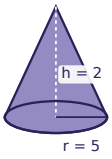

Volume of Cylinders, Cones & Spheres · 22

Find the volume of a cone with radius 4 and height 3. Use π ≈ 3.14.

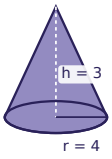

Volume of Cylinders, Cones & Spheres · 23

Find the volume of a sphere with radius 4. Use π ≈ 3.14.

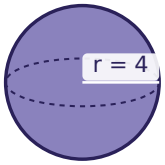

Volume of Cylinders, Cones & Spheres · 24

Find the volume of a cylinder with radius 3 and height 4. Use π ≈ 3.14.

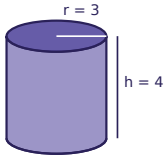

Volume of Cylinders, Cones & Spheres · 18

ANSWER

1808.6

Volume of Cylinders, Cones & Spheres · 17

ANSWER

16.7

Volume of Cylinders, Cones & Spheres · 20

ANSWER

602.9

Volume of Cylinders, Cones & Spheres · 19

ANSWER

65.9

Volume of Cylinders, Cones & Spheres · 22

ANSWER

50.2

Volume of Cylinders, Cones & Spheres · 21

ANSWER

52.3

Volume of Cylinders, Cones & Spheres · 24

ANSWER

113.0

Volume of Cylinders, Cones & Spheres · 23

ANSWER

267.9