Volume of Cylinders, Cones & Spheres · 1

Find the volume of a cylinder with radius 2 and height 4. Use π ≈ 3.14.

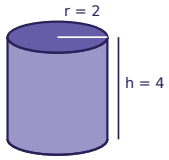

Volume of Cylinders, Cones & Spheres · 2

Find the volume of a cone with radius 3 and height 4. Use π ≈ 3.14.

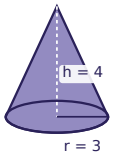

Volume of Cylinders, Cones & Spheres · 3

Find the volume of a sphere with radius 3. Use π ≈ 3.14.

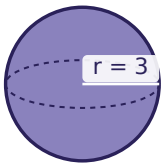

Volume of Cylinders, Cones & Spheres · 4

Find the volume of a cylinder with radius 3 and height 3. Use π ≈ 3.14.

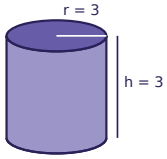

Volume of Cylinders, Cones & Spheres · 5

Find the volume of a sphere with radius 2. Use π ≈ 3.14.

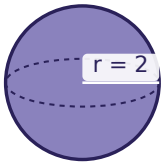

Volume of Cylinders, Cones & Spheres · 6

Find the volume of a cylinder with radius 3 and height 2. Use π ≈ 3.14.

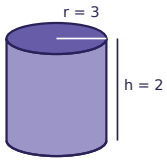

Volume of Cylinders, Cones & Spheres · 7

Find the volume of a cylinder with radius 2 and height 2. Use π ≈ 3.14.

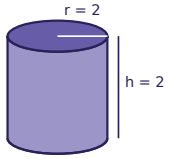

Volume of Cylinders, Cones & Spheres · 8

Find the volume of a cone with radius 2 and height 3. Use π ≈ 3.14.

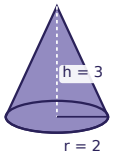

Volume of Cylinders, Cones & Spheres · 2

ANSWER

37.7

Volume of Cylinders, Cones & Spheres · 1

ANSWER

50.2

Volume of Cylinders, Cones & Spheres · 4

ANSWER

84.8

Volume of Cylinders, Cones & Spheres · 3

ANSWER

113.0

Volume of Cylinders, Cones & Spheres · 6

ANSWER

56.5

Volume of Cylinders, Cones & Spheres · 5

ANSWER

33.5

Volume of Cylinders, Cones & Spheres · 8

ANSWER

12.6

Volume of Cylinders, Cones & Spheres · 7

ANSWER

25.1

Volume of Cylinders, Cones & Spheres · 9

Find the volume of a cylinder with radius 4 and height 5. Use π ≈ 3.14.

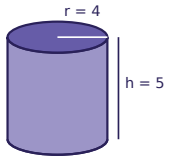

Volume of Cylinders, Cones & Spheres · 10

Find the volume of a cone with radius 3 and height 2. Use π ≈ 3.14.

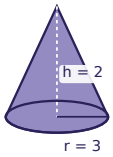

Volume of Cylinders, Cones & Spheres · 11

Find the volume of a sphere with radius 4. Use π ≈ 3.14.

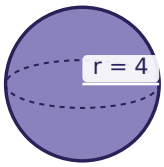

Volume of Cylinders, Cones & Spheres · 12

Find the volume of a cylinder with radius 3 and height 5. Use π ≈ 3.14.

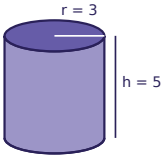

Volume of Cylinders, Cones & Spheres · 13

Find the volume of a cylinder with radius 3 and height 4. Use π ≈ 3.14.

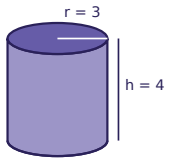

Volume of Cylinders, Cones & Spheres · 14

Find the volume of a cone with radius 2 and height 2. Use π ≈ 3.14.

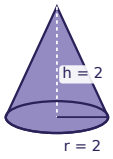

Volume of Cylinders, Cones & Spheres · 15

Find the volume of a cylinder with radius 2 and height 3. Use π ≈ 3.14.

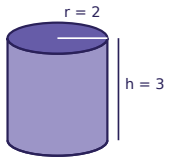

Volume of Cylinders, Cones & Spheres · 16

Find the volume of a cone with radius 3 and height 5. Use π ≈ 3.14.

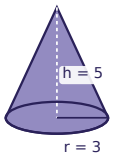

Volume of Cylinders, Cones & Spheres · 10

ANSWER

18.8

Volume of Cylinders, Cones & Spheres · 9

ANSWER

251.2

Volume of Cylinders, Cones & Spheres · 12

ANSWER

141.3

Volume of Cylinders, Cones & Spheres · 11

ANSWER

267.9

Volume of Cylinders, Cones & Spheres · 14

ANSWER

8.4

Volume of Cylinders, Cones & Spheres · 13

ANSWER

113.0

Volume of Cylinders, Cones & Spheres · 16

ANSWER

47.1

Volume of Cylinders, Cones & Spheres · 15

ANSWER

37.7

Volume of Cylinders, Cones & Spheres · 17

Find the volume of a cylinder with radius 5 and height 4. Use π ≈ 3.14.

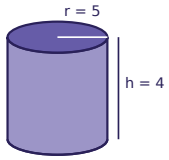

Volume of Cylinders, Cones & Spheres · 18

Find the volume of a cone with radius 5 and height 3. Use π ≈ 3.14.

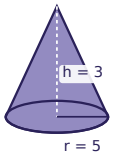

Volume of Cylinders, Cones & Spheres · 19

Find the volume of a cylinder with radius 2 and height 6. Use π ≈ 3.14.

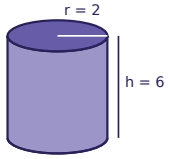

Volume of Cylinders, Cones & Spheres · 20

Find the volume of a cone with radius 5 and height 2. Use π ≈ 3.14.

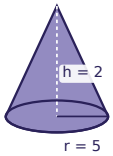

Volume of Cylinders, Cones & Spheres · 21

Find the volume of a cone with radius 2 and height 4. Use π ≈ 3.14.

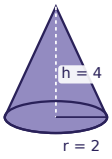

Volume of Cylinders, Cones & Spheres · 22

Find the volume of a cone with radius 3 and height 3. Use π ≈ 3.14.

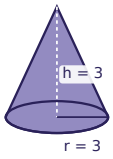

Volume of Cylinders, Cones & Spheres · 23

Find the volume of a cone with radius 2 and height 6. Use π ≈ 3.14.

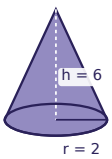

Volume of Cylinders, Cones & Spheres · 24

Find the volume of a cone with radius 2 and height 5. Use π ≈ 3.14.

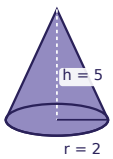

Volume of Cylinders, Cones & Spheres · 18

ANSWER

78.5

Volume of Cylinders, Cones & Spheres · 17

ANSWER

314.0

Volume of Cylinders, Cones & Spheres · 20

ANSWER

52.3

Volume of Cylinders, Cones & Spheres · 19

ANSWER

75.4

Volume of Cylinders, Cones & Spheres · 22

ANSWER

28.3

Volume of Cylinders, Cones & Spheres · 21

ANSWER

16.7

Volume of Cylinders, Cones & Spheres · 24

ANSWER

20.9

Volume of Cylinders, Cones & Spheres · 23

ANSWER

25.1