Is It a Function? (Vertical Line Test) · 1

Does the graph show y as a function of x?

Write Yes or No.

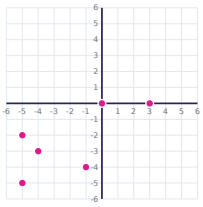

Is It a Function? (Vertical Line Test) · 2

Does the graph show y as a function of x?

Write Yes or No.

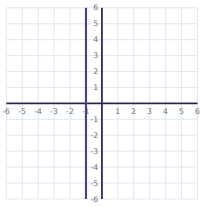

Is It a Function? (Vertical Line Test) · 3

Does the graph show y as a function of x?

Write Yes or No.

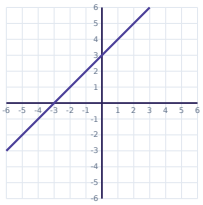

Is It a Function? (Vertical Line Test) · 4

Does the graph show y as a function of x?

Write Yes or No.

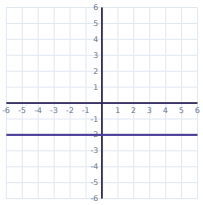

Is It a Function? (Vertical Line Test) · 5

Does the graph show y as a function of x?

Write Yes or No.

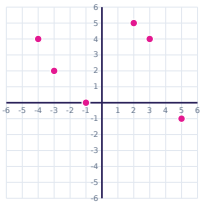

Is It a Function? (Vertical Line Test) · 6

Does the graph show y as a function of x?

Write Yes or No.

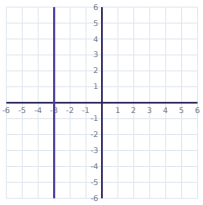

Is It a Function? (Vertical Line Test) · 7

Does the graph show y as a function of x?

Write Yes or No.

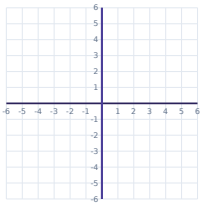

Is It a Function? (Vertical Line Test) · 8

Does the graph show y as a function of x?

Write Yes or No.

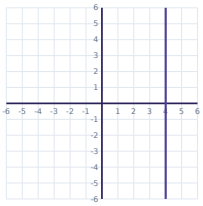

Is It a Function? (Vertical Line Test) · 2

ANSWER

No

Is It a Function? (Vertical Line Test) · 1

ANSWER

No

Is It a Function? (Vertical Line Test) · 4

ANSWER

Yes

Is It a Function? (Vertical Line Test) · 3

ANSWER

Yes

Is It a Function? (Vertical Line Test) · 6

ANSWER

No

Is It a Function? (Vertical Line Test) · 5

ANSWER

Yes

Is It a Function? (Vertical Line Test) · 8

ANSWER

No

Is It a Function? (Vertical Line Test) · 7

ANSWER

No

Is It a Function? (Vertical Line Test) · 9

Does the graph show y as a function of x?

Write Yes or No.

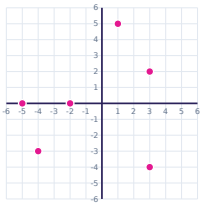

Is It a Function? (Vertical Line Test) · 10

Does the graph show y as a function of x?

Write Yes or No.

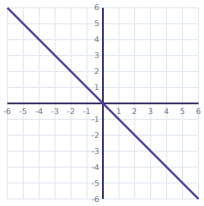

Is It a Function? (Vertical Line Test) · 11

Does the graph show y as a function of x?

Write Yes or No.

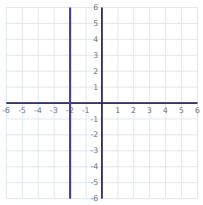

Is It a Function? (Vertical Line Test) · 12

Does the graph show y as a function of x?

Write Yes or No.

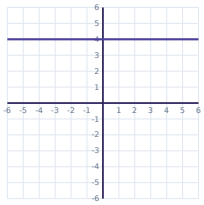

Is It a Function? (Vertical Line Test) · 13

Does the graph show y as a function of x?

Write Yes or No.

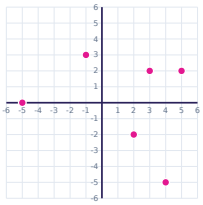

Is It a Function? (Vertical Line Test) · 14

Does the graph show y as a function of x?

Write Yes or No.

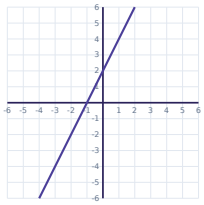

Is It a Function? (Vertical Line Test) · 15

Does the graph show y as a function of x?

Write Yes or No.

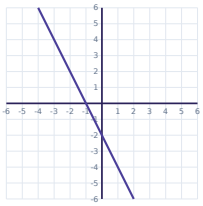

Is It a Function? (Vertical Line Test) · 16

Does the graph show y as a function of x?

Write Yes or No.

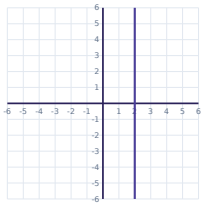

Is It a Function? (Vertical Line Test) · 10

ANSWER

Yes

Is It a Function? (Vertical Line Test) · 9

ANSWER

No

Is It a Function? (Vertical Line Test) · 12

ANSWER

Yes

Is It a Function? (Vertical Line Test) · 11

ANSWER

No

Is It a Function? (Vertical Line Test) · 14

ANSWER

Yes

Is It a Function? (Vertical Line Test) · 13

ANSWER

Yes

Is It a Function? (Vertical Line Test) · 16

ANSWER

No

Is It a Function? (Vertical Line Test) · 15

ANSWER

Yes

Is It a Function? (Vertical Line Test) · 17

Does the graph show y as a function of x?

Write Yes or No.

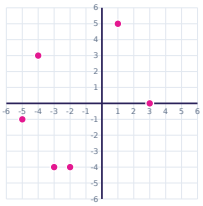

Is It a Function? (Vertical Line Test) · 18

Does the graph show y as a function of x?

Write Yes or No.

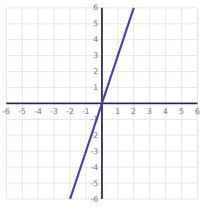

Is It a Function? (Vertical Line Test) · 19

Does the graph show y as a function of x?

Write Yes or No.

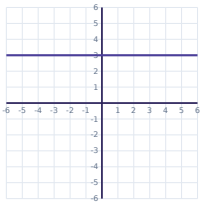

Is It a Function? (Vertical Line Test) · 20

Does the graph show y as a function of x?

Write Yes or No.

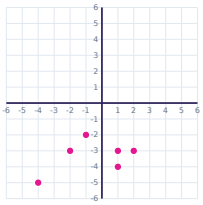

Is It a Function? (Vertical Line Test) · 21

Does the graph show y as a function of x?

Write Yes or No.

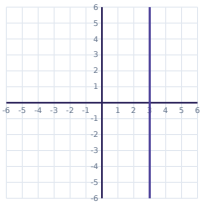

Is It a Function? (Vertical Line Test) · 22

Does the graph show y as a function of x?

Write Yes or No.

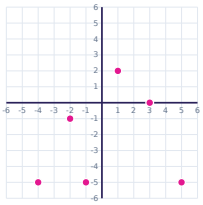

Is It a Function? (Vertical Line Test) · 23

Does the graph show y as a function of x?

Write Yes or No.

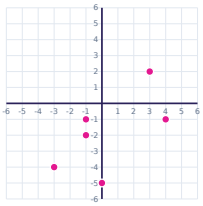

Is It a Function? (Vertical Line Test) · 24

Does the graph show y as a function of x?

Write Yes or No.

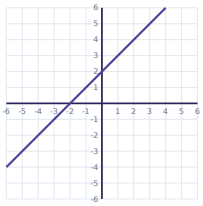

Is It a Function? (Vertical Line Test) · 18

ANSWER

Yes

Is It a Function? (Vertical Line Test) · 17

ANSWER

Yes

Is It a Function? (Vertical Line Test) · 20

ANSWER

No

Is It a Function? (Vertical Line Test) · 19

ANSWER

Yes

Is It a Function? (Vertical Line Test) · 22

ANSWER

Yes

Is It a Function? (Vertical Line Test) · 21

ANSWER

No

Is It a Function? (Vertical Line Test) · 24

ANSWER

Yes

Is It a Function? (Vertical Line Test) · 23

ANSWER

No