Task card 1 Thanksgiving Math

Leo orders 7 bags of rolls online. Shipping costs $7.00, and the total is $22.75. Write and solve an equation to find the price of one bag of rolls.

Task card 2 Thanksgiving Math

Ava has $25 saved for Thanksgiving dinner and adds $6 every week. How many dollars will Ava have after 10 weeks?

Task card 3 Thanksgiving Math

A cylinder-shaped tin of cranberry tarts has a radius of 4 inches and a height of 4 inches. What is its volume in cubic inches?

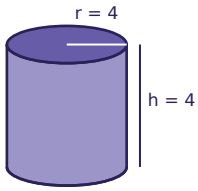

Task card 4 Thanksgiving Math

A cylinder-shaped tin of rolls has a radius of 2 inches and a height of 4 inches. What is its volume in cubic inches?

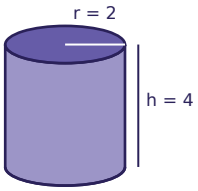

Task card 5 Thanksgiving Math

Sam orders 7 bags of rolls online. Shipping costs $2.50, and the total is $21.75. Write and solve an equation to find the price of one bag of rolls.

Task card 6 Thanksgiving Math

Mia has $15 saved for Thanksgiving dinner and adds $2 every week. After how many weeks will Mia have $25?

Task card 7 Thanksgiving Math

Zoe runs a 5-foot string of lights straight across a rectangular banner for Thanksgiving dinner, from one corner to the opposite corner. The banner is 4 feet long. How tall is the banner?

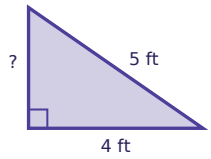

Task card 8 Thanksgiving Math

Ella runs a 5-foot string of lights straight across a rectangular banner for Thanksgiving dinner, from one corner to the opposite corner. The banner is 4 feet long. How tall is the banner?

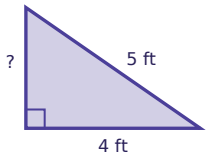

Task card 9 Thanksgiving Math

Ella has $20 saved for Thanksgiving dinner and adds $7 every week. After how many weeks will Ella have $90?

Task card 10 Thanksgiving Math

Ella has $30 saved for Thanksgiving dinner and adds $2 every week. After how many weeks will Ella have $46?

Task card 11 Thanksgiving Math

Noah orders 3 bags of rolls online. Shipping costs $1.50, and the total is $14.25. Write and solve an equation to find the price of one bag of rolls.

Task card 12 Thanksgiving Math

Sam runs a 25-foot string of lights straight across a rectangular banner for Thanksgiving dinner, from one corner to the opposite corner. The banner is 24 feet long. How tall is the banner?

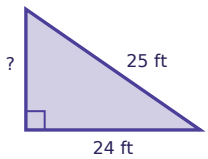

Task card 13 Thanksgiving Math

Ella runs a 15-foot string of lights straight across a rectangular banner for Thanksgiving dinner, from one corner to the opposite corner. The banner is 12 feet long. How tall is the banner?

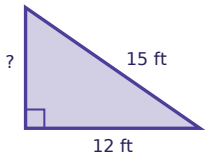

Task card 14 Thanksgiving Math

A cylinder-shaped tin of rolls has a radius of 4 inches and a height of 10 inches. What is its volume in cubic inches?

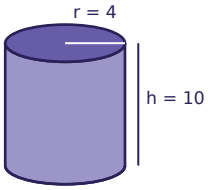

Task card 15 Thanksgiving Math

A cylinder-shaped tin of cranberry tarts has a radius of 3 inches and a height of 11 inches. What is its volume in cubic inches?

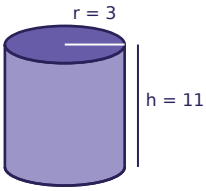

Task card 16 Thanksgiving Math

Mia orders 2 pumpkin pies online. Shipping costs $7.00, and the total is $17.50. Write and solve an equation to find the price of one pumpkin pie.

Task card 17 Thanksgiving Math

Leo orders 6 bags of rolls online. Shipping costs $6.50, and the total is $24.50. Write and solve an equation to find the price of one bag of rolls.

Task card 18 Thanksgiving Math

Sam orders 2 pumpkin pies online. Shipping costs $3.00, and the total is $18.00. Write and solve an equation to find the price of one pumpkin pie.

Task card 19 Thanksgiving Math

A rectangular banner for Thanksgiving dinner is 4 feet long and 3 feet tall. Lily runs a string of lights straight across it, from one corner to the opposite corner. How many feet long is the string of lights?

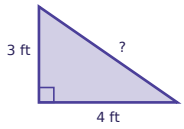

Task card 20 Thanksgiving Math

A cylinder-shaped tin of cranberry tarts has a radius of 5 inches and a height of 5 inches. What is its volume in cubic inches?

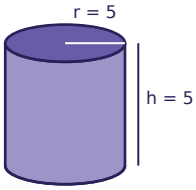

Task card 21 Thanksgiving Math

Sam has $25 saved for Thanksgiving dinner and adds $9 every week. How many dollars will Sam have after 5 weeks?

Task card 22 Thanksgiving Math

Leo runs a 25-foot string of lights straight across a rectangular banner for Thanksgiving dinner, from one corner to the opposite corner. The banner is 24 feet long. How tall is the banner?

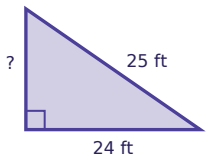

Task card 23 Thanksgiving Math

Noah has $30 saved for Thanksgiving dinner and adds $5 every week. After how many weeks will Noah have $45?

Task card 24 Thanksgiving Math

Lily runs a 17-foot string of lights straight across a rectangular banner for Thanksgiving dinner, from one corner to the opposite corner. The banner is 15 feet long. How tall is the banner?

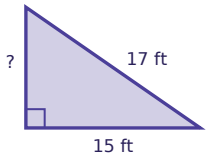

Thanksgiving Math Task Cards

Recording sheet · Grade 8 · Read each story and solve. Write money like $3.75. Use 3.14 for π and round to the nearest tenth.

Name: _____ Date: _____

Scan to check your answers

1	2	3	4
5	6	7	8
9	10	11	12
13	14	15	16
17	18	19	20
21	22	23	24

Thanksgiving Math Task Cards: Answer Key

Grade 8 · Hard

The answers online

1. $2.25	**2.** 85	**3.** 201
4. 50.2	**5.** $2.75	**6.** 5
7. 3	**8.** 3	**9.** 10
10. 8	**11.** $4.25	**12.** 7
13. 9	**14.** 502.4	**15.** 310.9
16. $5.25	**17.** $3.00	**18.** $7.50
19. 5	**20.** 392.5	**21.** 70
22. 7	**23.** 3	**24.** 8