Task card 1 Thanksgiving Math

Ella has $20 saved for Thanksgiving dinner and adds $3 every week. How many dollars will Ella have after 10 weeks?

Task card 2 Thanksgiving Math

A rectangular banner for Thanksgiving dinner is 4 feet long and 3 feet tall. Leo runs a string of lights straight across it, from one corner to the opposite corner. How many feet long is the string of lights?

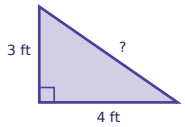

Task card 3 Thanksgiving Math

Mia orders 3 jars of cranberry sauce online. Shipping costs $2.00, and the total is $8.75. Write and solve an equation to find the price of one jar of cranberry sauce.

Task card 4 Thanksgiving Math

A cylinder-shaped tin of corn muffins has a radius of 3 inches and a height of 8 inches. What is its volume in cubic inches?

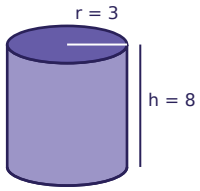

Task card 5 Thanksgiving Math

A cylinder-shaped tin of rolls has a radius of 3 inches and a height of 3 inches. What is its volume in cubic inches?

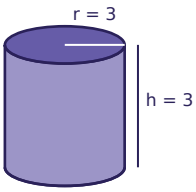

Task card 6 Thanksgiving Math

Omar has $20 saved for Thanksgiving dinner and adds $8 every week. How many dollars will Omar have after 10 weeks?

Task card 7 Thanksgiving Math

A rectangular banner for Thanksgiving dinner is 4 feet long and 3 feet tall. Sam runs a string of lights straight across it, from one corner to the opposite corner. How many feet long is the string of lights?

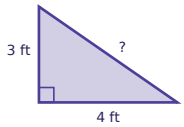

Task card 8 Thanksgiving Math

Noah orders 7 pumpkin pies online. Shipping costs $3.00, and the total is $50.25. Write and solve an equation to find the price of one pumpkin pie.

Task card 9 Thanksgiving Math

Leo has $20 saved for Thanksgiving dinner and adds $8 every week. How many dollars will Leo have after 3 weeks?

Task card 10 Thanksgiving Math

Omar orders 3 jars of cranberry sauce online. Shipping costs $6.00, and the total is $14.25. Write and solve an equation to find the price of one jar of cranberry sauce.

Task card 11 Thanksgiving Math

Leo runs a 15-foot string of lights straight across a rectangular banner for Thanksgiving dinner, from one corner to the opposite corner. The banner is 12 feet long. How tall is the banner?

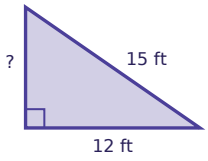

Task card 12 Thanksgiving Math

A rectangular banner for Thanksgiving dinner is 8 feet long and 6 feet tall. Ella runs a string of lights straight across it, from one corner to the opposite corner. How many feet long is the string of lights?

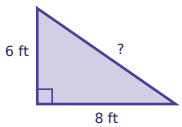

Task card 13 Thanksgiving Math

A cylinder-shaped tin of rolls has a radius of 4 inches and a height of 8 inches. What is its volume in cubic inches?

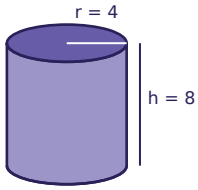

Task card 14 Thanksgiving Math

A cylinder-shaped tin of corn muffins has a radius of 3 inches and a height of 7 inches. What is its volume in cubic inches?

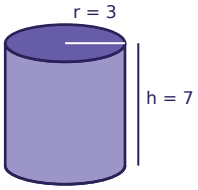

Task card 15 Thanksgiving Math

Ella has $20 saved for Thanksgiving dinner and adds $6 every week. After how many weeks will Ella have $68?

Task card 16 Thanksgiving Math

Lily orders 4 jars of cranberry sauce online. Shipping costs $3.50, and the total is $17.50. Write and solve an equation to find the price of one jar of cranberry sauce.

Task card 17 Thanksgiving Math

Sam orders 2 pumpkin pies online. Shipping costs $6.50, and the total is $21.00. Write and solve an equation to find the price of one pumpkin pie.

Task card 18 Thanksgiving Math

A cylinder-shaped tin of rolls has a radius of 4 inches and a height of 7 inches. What is its volume in cubic inches?

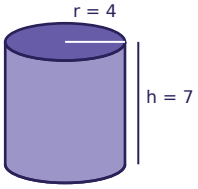

Task card 19 Thanksgiving Math

Ava has $20 saved for Thanksgiving dinner and adds $3 every week. After how many weeks will Ava have $47?

Task card 20 Thanksgiving Math

A rectangular banner for Thanksgiving dinner is 12 feet long and 5 feet tall. Ava runs a string of lights straight across it, from one corner to the opposite corner. How many feet long is the string of lights?

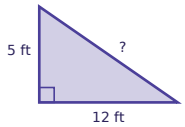

Task card 21 Thanksgiving Math

A cylinder-shaped tin of rolls has a radius of 3 inches and a height of 4 inches. What is its volume in cubic inches?

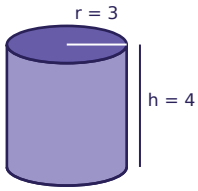

Task card 22 Thanksgiving Math

Ava runs a 15-foot string of lights straight across a rectangular banner for Thanksgiving dinner, from one corner to the opposite corner. The banner is 12 feet long. How tall is the banner?

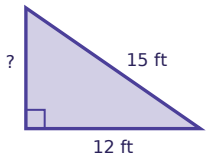

Task card 23 Thanksgiving Math

Ava has $10 saved for Thanksgiving dinner and adds $9 every week. How many dollars will Ava have after 9 weeks?

Task card 24 Thanksgiving Math

Leo orders 6 jars of cranberry sauce online. Shipping costs $2.00, and the total is $20.00. Write and solve an equation to find the price of one jar of cranberry sauce.

Thanksgiving Math Task Cards

Recording sheet · Grade 8 · Read each story and solve. Write money like $3.75. Use 3.14 for π and round to the nearest tenth.

Scan to check your answers

Name: _____ Date: _____

1	2	3	4
5	6	7	8
9	10	11	12
13	14	15	16
17	18	19	20
21	22	23	24

Thanksgiving Math Task Cards: Answer Key

Grade 8 · Medium

The answers online

1. 50	**2.** 5	**3.** $2.25
4. 226.1	**5.** 84.8	**6.** 100
7. 5	**8.** $6.75	**9.** 44
10. $2.75	**11.** 9	**12.** 10
13. 401.9	**14.** 197.8	**15.** 8
16. $3.50	**17.** $7.25	**18.** 351.7
19. 9	**20.** 13	**21.** 113
22. 9	**23.** 91	**24.** $3.00