Task card 1 Thanksgiving Math

A cylinder-shaped tin of cranberry tarts has a radius of 2 inches and a height of 4 inches. What is its volume in cubic inches?

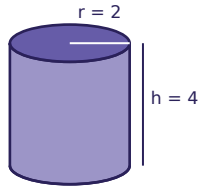

Task card 2 Thanksgiving Math

Mia orders 4 bags of rolls online. Shipping costs $5.00, and the total is $22.00. Write and solve an equation to find the price of one bag of rolls.

Task card 3 Thanksgiving Math

Omar orders 4 jars of cranberry sauce online. Shipping costs $7.00, and the total is $18.00. Write and solve an equation to find the price of one jar of cranberry sauce.

Task card 4 Thanksgiving Math

Ava has $5 saved for Thanksgiving dinner and adds $3 every week. How many dollars will Ava have after 6 weeks?

Task card 5 Thanksgiving Math

A rectangular banner for Thanksgiving dinner is 12 feet long and 5 feet tall. Omar runs a string of lights straight across it, from one corner to the opposite corner. How many feet long is the string of lights?

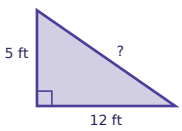

Task card 6 Thanksgiving Math

A cylinder-shaped tin of cranberry tarts has a radius of 2 inches and a height of 3 inches. What is its volume in cubic inches?

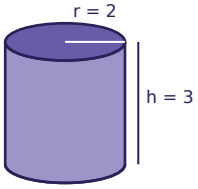

Task card 7 Thanksgiving Math

Mia has $30 saved for Thanksgiving dinner and adds $3 every week. How many dollars will Mia have after 4 weeks?

Task card 8 Thanksgiving Math

A rectangular banner for Thanksgiving dinner is 12 feet long and 5 feet tall. Ben runs a string of lights straight across it, from one corner to the opposite corner. How many feet long is the string of lights?

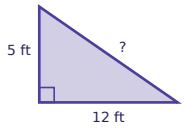

Task card 9 Thanksgiving Math

Noah orders 2 pumpkin pies online. Shipping costs $4.00, and the total is $17.50. Write and solve an equation to find the price of one pumpkin pie.

Task card 10 Thanksgiving Math

A cylinder-shaped tin of cranberry tarts has a radius of 3 inches and a height of 5 inches. What is its volume in cubic inches?

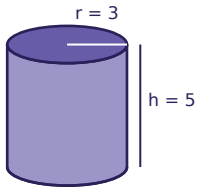

Task card 11 Thanksgiving Math

Leo orders 3 pumpkin pies online. Shipping costs $6.00, and the total is $32.25. Write and solve an equation to find the price of one pumpkin pie.

Task card 12 Thanksgiving Math

A cylinder-shaped tin of rolls has a radius of 3 inches and a height of 6 inches. What is its volume in cubic inches?

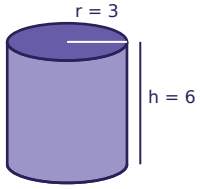

Task card 13 Thanksgiving Math

Zoe has $10 saved for Thanksgiving dinner and adds $6 every week. How many dollars will Zoe have after 10 weeks?

Task card 14 Thanksgiving Math

A rectangular banner for Thanksgiving dinner is 4 feet long and 3 feet tall. Sam runs a string of lights straight across it, from one corner to the opposite corner. How many feet long is the string of lights?

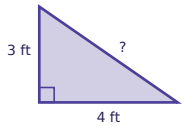

Task card 15 Thanksgiving Math

Omar has $25 saved for Thanksgiving dinner and adds $4 every week. How many dollars will Omar have after 5 weeks?

Task card 16 Thanksgiving Math

A rectangular banner for Thanksgiving dinner is 8 feet long and 6 feet tall. Mia runs a string of lights straight across it, from one corner to the opposite corner. How many feet long is the string of lights?

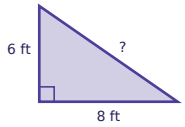

Task card 17 Thanksgiving Math

A rectangular banner for Thanksgiving dinner is 12 feet long and 5 feet tall. Ella runs a string of lights straight across it, from one corner to the opposite corner. How many feet long is the string of lights?

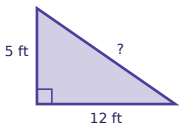

Task card 18 Thanksgiving Math

Noah orders 2 jars of cranberry sauce online. Shipping costs $5.00, and the total is $10.50. Write and solve an equation to find the price of one jar of cranberry sauce.

Task card 19 Thanksgiving Math

A cylinder-shaped tin of rolls has a radius of 3 inches and a height of 3 inches. What is its volume in cubic inches?

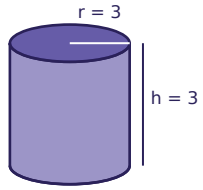

Task card 20 Thanksgiving Math

Omar has $15 saved for Thanksgiving dinner and adds $6 every week. How many dollars will Omar have after 7 weeks?

Task card 21 Thanksgiving Math

A rectangular banner for Thanksgiving dinner is 12 feet long and 5 feet tall. Noah runs a string of lights straight across it, from one corner to the opposite corner. How many feet long is the string of lights?

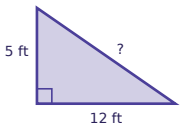

Task card 22 Thanksgiving Math

Leo has $20 saved for Thanksgiving dinner and adds $6 every week. How many dollars will Leo have after 4 weeks?

Task card 23 Thanksgiving Math

Mia orders 2 bags of rolls online. Shipping costs $6.00, and the total is $14.00. Write and solve an equation to find the price of one bag of rolls.

Task card 24 Thanksgiving Math

Noah orders 2 jars of cranberry sauce online. Shipping costs $4.00, and the total is $8.00. Write and solve an equation to find the price of one jar of cranberry sauce.

Thanksgiving Math Task Cards

Recording sheet · Grade 8 · Read each story and solve. Write money like $3.75. Use 3.14 for π and round to the nearest tenth.

Name: _____ Date: _____

Scan to check your answers

1	2	3	4
5	6	7	8
9	10	11	12
13	14	15	16
17	18	19	20
21	22	23	24

Thanksgiving Math Task Cards: Answer Key

Grade 8 · Easy

The answers online

1. 50.2	**2.** $4.25	**3.** $2.75
4. 23	**5.** 13	**6.** 37.7
7. 42	**8.** 13	**9.** $6.75
10. 141.3	**11.** $8.75	**12.** 169.6
13. 70	**14.** 5	**15.** 45
16. 10	**17.** 13	**18.** $2.75
19. 84.8	**20.** 57	**21.** 13
22. 44	**23.** $4.00	**24.** $2.00