Thanksgiving Math · 1

Leo orders 7 bags of rolls online. Shipping costs $7.00, and the total is $22.75. Write and solve an equation to find the price of one bag of rolls.

Thanksgiving Math · 2

Ava has $25 saved for Thanksgiving dinner and adds $6 every week. How many dollars will Ava have after 10 weeks?

Thanksgiving Math · 3

A cylinder-shaped tin of cranberry tarts has a radius of 4 inches and a height of 4 inches. What is its volume in cubic inches?

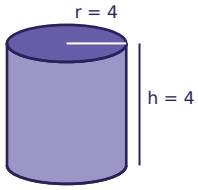


Thanksgiving Math · 4

A cylinder-shaped tin of rolls has a radius of 2 inches and a height of 4 inches. What is its volume in cubic inches?

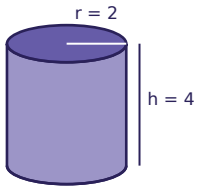


Thanksgiving Math · 5

Sam orders 7 bags of rolls online. Shipping costs $2.50, and the total is $21.75. Write and solve an equation to find the price of one bag of rolls.

Thanksgiving Math · 6

Mia has $15 saved for Thanksgiving dinner and adds $2 every week. After how many weeks will Mia have $25?

Thanksgiving Math · 7

Zoe runs a 5-foot string of lights straight across a rectangular banner for Thanksgiving dinner, from one corner to the opposite corner. The banner is 4 feet long. How tall is the banner?

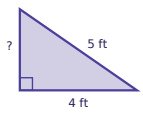


Thanksgiving Math · 8

Ella runs a 5-foot string of lights straight across a rectangular banner for Thanksgiving dinner, from one corner to the opposite corner. The banner is 4 feet long. How tall is the banner?

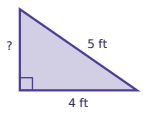

Thanksgiving Math · 2

**ANSWER**

**85**

Thanksgiving Math · 1

**ANSWER**

**$2.25**

Thanksgiving Math · 4

**ANSWER**

**50.2**

Thanksgiving Math · 3

**ANSWER**

**201**

Thanksgiving Math · 6

**ANSWER**

**5**

Thanksgiving Math · 5

**ANSWER**

**$2.75**

Thanksgiving Math · 8

**ANSWER**

**3**

Thanksgiving Math · 7

**ANSWER**

**3**

Thanksgiving Math · 9

Ella has $20 saved for Thanksgiving dinner and adds $7 every week. After how many weeks will Ella have $90?

Thanksgiving Math · 10

Ella has $30 saved for Thanksgiving dinner and adds $2 every week. After how many weeks will Ella have $46?

Thanksgiving Math · 11

Noah orders 3 bags of rolls online. Shipping costs $1.50, and the total is $14.25. Write and solve an equation to find the price of one bag of rolls.

Thanksgiving Math · 12

Sam runs a 25-foot string of lights straight across a rectangular banner for Thanksgiving dinner, from one corner to the opposite corner. The banner is 24 feet long. How tall is the banner?

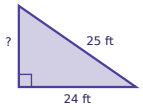


Thanksgiving Math · 13

Ella runs a 15-foot string of lights straight across a rectangular banner for Thanksgiving dinner, from one corner to the opposite corner. The banner is 12 feet long. How tall is the banner?

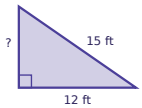


Thanksgiving Math · 14

A cylinder-shaped tin of rolls has a radius of 4 inches and a height of 10 inches. What is its volume in cubic inches?

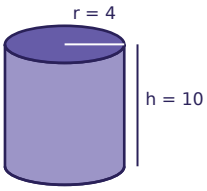


Thanksgiving Math · 15

A cylinder-shaped tin of cranberry tarts has a radius of 3 inches and a height of 11 inches. What is its volume in cubic inches?

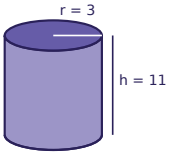


Thanksgiving Math · 16

Mia orders 2 pumpkin pies online. Shipping costs $7.00, and the total is $17.50. Write and solve an equation to find the price of one pumpkin pie.

Thanksgiving Math · 10

**ANSWER**

**8**

Thanksgiving Math · 9

**ANSWER**

**10**

Thanksgiving Math · 12

**ANSWER**

**7**

Thanksgiving Math · 11

**ANSWER**

**$4.25**

Thanksgiving Math · 14

**ANSWER**

**502.4**

Thanksgiving Math · 13

**ANSWER**

**9**

Thanksgiving Math · 16

**ANSWER**

**$5.25**

Thanksgiving Math · 15

**ANSWER**

**310.9**

Thanksgiving Math · 17

Leo orders 6 bags of rolls online. Shipping costs $6.50, and the total is $24.50. Write and solve an equation to find the price of one bag of rolls.

Thanksgiving Math · 18

Sam orders 2 pumpkin pies online. Shipping costs $3.00, and the total is $18.00. Write and solve an equation to find the price of one pumpkin pie.

Thanksgiving Math · 19

A rectangular banner for Thanksgiving dinner is 4 feet long and 3 feet tall. Lily runs a string of lights straight across it, from one corner to the opposite corner. How many feet long is the string of lights?

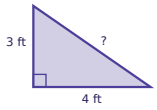


Thanksgiving Math · 20

A cylinder-shaped tin of cranberry tarts has a radius of 5 inches and a height of 5 inches. What is its volume in cubic inches?

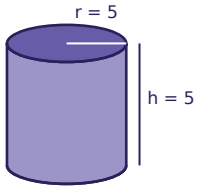


Thanksgiving Math · 21

Sam has $25 saved for Thanksgiving dinner and adds $9 every week. How many dollars will Sam have after 5 weeks?

Thanksgiving Math · 22

Leo runs a 25-foot string of lights straight across a rectangular banner for Thanksgiving dinner, from one corner to the opposite corner. The banner is 24 feet long. How tall is the banner?

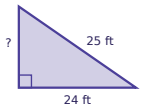


Thanksgiving Math · 23

Noah has $30 saved for Thanksgiving dinner and adds $5 every week. After how many weeks will Noah have $45?

Thanksgiving Math · 24

Lily runs a 17-foot string of lights straight across a rectangular banner for Thanksgiving dinner, from one corner to the opposite corner. The banner is 15 feet long. How tall is the banner?

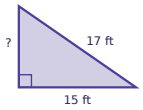

Thanksgiving Math · 18

**ANSWER**

**$7.50**

Thanksgiving Math · 17

**ANSWER**

**$3.00**

Thanksgiving Math · 20

**ANSWER**

**392.5**

Thanksgiving Math · 19

**ANSWER**

**5**

Thanksgiving Math · 22

**ANSWER**

**7**

Thanksgiving Math · 21

**ANSWER**

**70**

Thanksgiving Math · 24

**ANSWER**

**8**

Thanksgiving Math · 23

**ANSWER**

**3**