Thanksgiving Math · 1

A cylinder-shaped tin of cranberry tarts has a radius of 2 inches and a height of 4 inches. What is its volume in cubic inches?

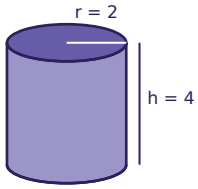

Thanksgiving Math · 2

Mia orders 4 bags of rolls online. Shipping costs $5.00, and the total is $22.00. Write and solve an equation to find the price of one bag of rolls.

Thanksgiving Math · 3

Omar orders 4 jars of cranberry sauce online. Shipping costs $7.00, and the total is $18.00. Write and solve an equation to find the price of one jar of cranberry sauce.

Thanksgiving Math · 4

Ava has $5 saved for Thanksgiving dinner and adds $3 every week. How many dollars will Ava have after 6 weeks?

Thanksgiving Math · 5

A rectangular banner for Thanksgiving dinner is 12 feet long and 5 feet tall. Omar runs a string of lights straight across it, from one corner to the opposite corner. How many feet long is the string of lights?

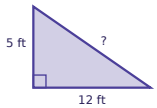

Thanksgiving Math · 6

A cylinder-shaped tin of cranberry tarts has a radius of 2 inches and a height of 3 inches. What is its volume in cubic inches?

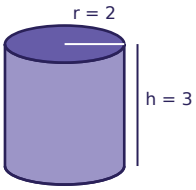

Thanksgiving Math · 7

Mia has $30 saved for Thanksgiving dinner and adds $3 every week. How many dollars will Mia have after 4 weeks?

Thanksgiving Math · 8

A rectangular banner for Thanksgiving dinner is 12 feet long and 5 feet tall. Ben runs a string of lights straight across it, from one corner to the opposite corner. How many feet long is the string of lights?

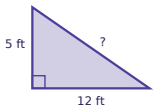

Thanksgiving Math · 2

ANSWER

$4.25

Thanksgiving Math · 1

ANSWER

50.2

Thanksgiving Math · 4

ANSWER

23

Thanksgiving Math · 3

ANSWER

$2.75

Thanksgiving Math · 6

ANSWER

37.7

Thanksgiving Math · 5

ANSWER

13

Thanksgiving Math · 8

ANSWER

13

Thanksgiving Math · 7

ANSWER

42

Thanksgiving Math · 9

Noah orders 2 pumpkin pies online. Shipping costs $4.00, and the total is $17.50. Write and solve an equation to find the price of one pumpkin pie.

Thanksgiving Math · 10

A cylinder-shaped tin of cranberry tarts has a radius of 3 inches and a height of 5 inches. What is its volume in cubic inches?

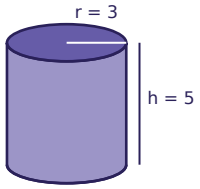

Thanksgiving Math · 11

Leo orders 3 pumpkin pies online. Shipping costs $6.00, and the total is $32.25. Write and solve an equation to find the price of one pumpkin pie.

Thanksgiving Math · 12

A cylinder-shaped tin of rolls has a radius of 3 inches and a height of 6 inches. What is its volume in cubic inches?

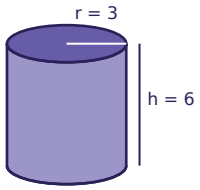

Thanksgiving Math · 13

Zoe has $10 saved for Thanksgiving dinner and adds $6 every week. How many dollars will Zoe have after 10 weeks?

Thanksgiving Math · 14

A rectangular banner for Thanksgiving dinner is 4 feet long and 3 feet tall. Sam runs a string of lights straight across it, from one corner to the opposite corner. How many feet long is the string of lights?

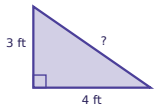

Thanksgiving Math · 15

Omar has $25 saved for Thanksgiving dinner and adds $4 every week. How many dollars will Omar have after 5 weeks?

Thanksgiving Math · 16

A rectangular banner for Thanksgiving dinner is 8 feet long and 6 feet tall. Mia runs a string of lights straight across it, from one corner to the opposite corner. How many feet long is the string of lights?

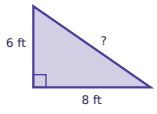

Thanksgiving Math · 10

ANSWER

141.3

Thanksgiving Math · 9

ANSWER

$6.75

Thanksgiving Math · 12

ANSWER

169.6

Thanksgiving Math · 11

ANSWER

$8.75

Thanksgiving Math · 14

ANSWER

5

Thanksgiving Math · 13

ANSWER

70

Thanksgiving Math · 16

ANSWER

10

Thanksgiving Math · 15

ANSWER

45

Thanksgiving Math · 17

A rectangular banner for Thanksgiving dinner is 12 feet long and 5 feet tall. Ella runs a string of lights straight across it, from one corner to the opposite corner. How many feet long is the string of lights?

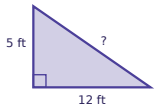

Thanksgiving Math · 18

Noah orders 2 jars of cranberry sauce online. Shipping costs $5.00, and the total is $10.50. Write and solve an equation to find the price of one jar of cranberry sauce.

Thanksgiving Math · 19

A cylinder-shaped tin of rolls has a radius of 3 inches and a height of 3 inches. What is its volume in cubic inches?

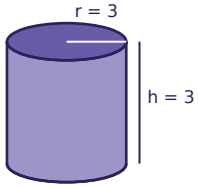

Thanksgiving Math · 20

Omar has $15 saved for Thanksgiving dinner and adds $6 every week. How many dollars will Omar have after 7 weeks?

Thanksgiving Math · 21

A rectangular banner for Thanksgiving dinner is 12 feet long and 5 feet tall. Noah runs a string of lights straight across it, from one corner to the opposite corner. How many feet long is the string of lights?

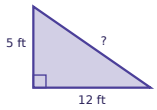

Thanksgiving Math · 22

Leo has $20 saved for Thanksgiving dinner and adds $6 every week. How many dollars will Leo have after 4 weeks?

Thanksgiving Math · 23

Mia orders 2 bags of rolls online. Shipping costs $6.00, and the total is $14.00. Write and solve an equation to find the price of one bag of rolls.

Thanksgiving Math · 24

Noah orders 2 jars of cranberry sauce online. Shipping costs $4.00, and the total is $8.00. Write and solve an equation to find the price of one jar of cranberry sauce.

Thanksgiving Math · 18

ANSWER

$2.75

Thanksgiving Math · 17

ANSWER

13

Thanksgiving Math · 20

ANSWER

57

Thanksgiving Math · 19

ANSWER

84.8

Thanksgiving Math · 22

ANSWER

44

Thanksgiving Math · 21

ANSWER

13

Thanksgiving Math · 24

ANSWER

$2.00

Thanksgiving Math · 23

ANSWER

$4.00