Surface Area of Spheres · 1

Find the surface area of the sphere in square centimeters. Use π ≈ 3.14.

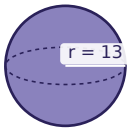

Surface Area of Spheres · 2

Find the surface area of the sphere in square meters. Use π ≈ 3.14.

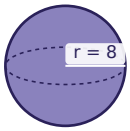

Surface Area of Spheres · 3

Find the surface area of the sphere in square meters. Use π ≈ 3.14.

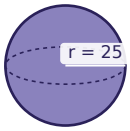

Surface Area of Spheres · 4

Find the surface area of the sphere in square inches. Use π ≈ 3.14.

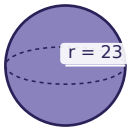

Surface Area of Spheres · 5

Find the surface area of the sphere in square centimeters. Use π ≈ 3.14.

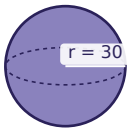

Surface Area of Spheres · 6

Find the surface area of the sphere in square feet. Use π ≈ 3.14.

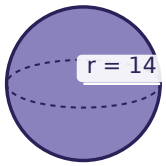

Surface Area of Spheres · 7

Find the surface area of the sphere in square centimeters. Use π ≈ 3.14.

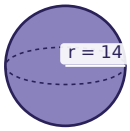

Surface Area of Spheres · 8

Find the surface area of the sphere in square inches. Use π ≈ 3.14.

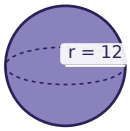

Surface Area of Spheres · 2

ANSWER

803.84

Surface Area of Spheres · 1

ANSWER

2122.64

Surface Area of Spheres · 4

ANSWER

6644.24

Surface Area of Spheres · 3

ANSWER

7850

Surface Area of Spheres · 6

ANSWER

2461.76

Surface Area of Spheres · 5

ANSWER

11304

Surface Area of Spheres · 8

ANSWER

1808.64

Surface Area of Spheres · 7

ANSWER

2461.76

Surface Area of Spheres · 9

Find the surface area of the sphere in square feet. Use π ≈ 3.14.

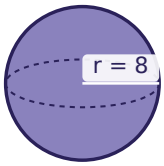

Surface Area of Spheres · 10

Find the surface area of the sphere in square inches. Use π ≈ 3.14.

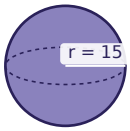

Surface Area of Spheres · 11

Find the surface area of the sphere in square inches. Use π ≈ 3.14.

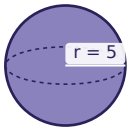

Surface Area of Spheres · 12

A round balloon has a radius of 19 cm. What is the area of its surface in square centimeters? Use π ≈ 3.14.

Surface Area of Spheres · 13

A globe has a diameter of 24 cm. How many square centimeters of map paper cover it? Use π ≈ 3.14.

Surface Area of Spheres · 14

A ball has a radius of 4 in. How many square inches of leather cover it? Use π ≈ 3.14.

Surface Area of Spheres · 15

A ball has a radius of 6 m. How many square meters of leather cover it? Use π ≈ 3.14.

Surface Area of Spheres · 16

Find the surface area of the sphere in square meters. Use π ≈ 3.14.

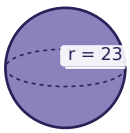

Surface Area of Spheres · 10

ANSWER

2826

Surface Area of Spheres · 9

ANSWER

803.84

Surface Area of Spheres · 12

ANSWER

4534.16

Surface Area of Spheres · 11

ANSWER

314

Surface Area of Spheres · 14

ANSWER

200.96

Surface Area of Spheres · 13

ANSWER

1808.64

Surface Area of Spheres · 16

ANSWER

6644.24

Surface Area of Spheres · 15

ANSWER

452.16

Surface Area of Spheres · 17

Find the surface area of the sphere in square feet. Use π ≈ 3.14.

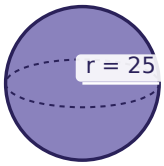

Surface Area of Spheres · 18

Find the surface area of the sphere in square inches. Use π ≈ 3.14.

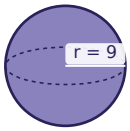

Surface Area of Spheres · 19

Find the surface area of the sphere in square inches. Use π ≈ 3.14.

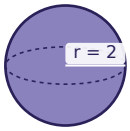

Surface Area of Spheres · 20

Find the surface area of the sphere in square centimeters. Use π ≈ 3.14.

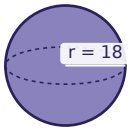

Surface Area of Spheres · 21

Find the surface area of the sphere in square inches. Use π ≈ 3.14.

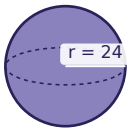

Surface Area of Spheres · 22

Find the surface area of the sphere in square centimeters. Use π ≈ 3.14.

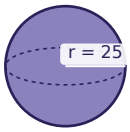

Surface Area of Spheres · 23

Find the surface area of the sphere in square feet. Use π ≈ 3.14.

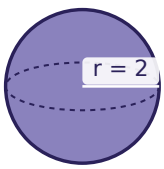

Surface Area of Spheres · 24

Find the surface area of the sphere in square inches. Use π ≈ 3.14.

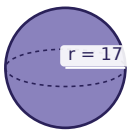

Surface Area of Spheres · 18

ANSWER

1017.36

Surface Area of Spheres · 17

ANSWER

7850

Surface Area of Spheres · 20

ANSWER

4069.44

Surface Area of Spheres · 19

ANSWER

50.24

Surface Area of Spheres · 22

ANSWER

7850

Surface Area of Spheres · 21

ANSWER

7234.56

Surface Area of Spheres · 24

ANSWER

3629.84

Surface Area of Spheres · 23

ANSWER

50.24